Visueller Stellenwert - weniger als 20 Name:

**Fülle die Lücken auf und finde die Zahlen.**

**Bsp)**

0 zehnern 4 einern

**1)**

zehnern einern

**2)**

zehnern einern

**3)**

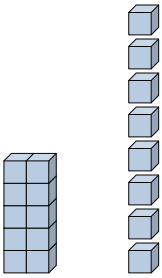

zehnern einern

**4)**

zehnern einern

**5)**

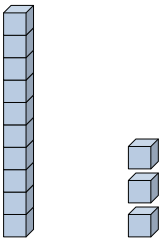

zehnern einern

**6)**

zehnern einern

**7)**

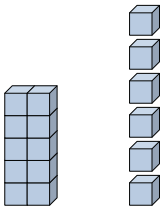

zehnern einern

**8)**

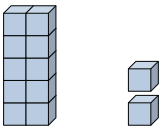

zehnern einern

**9)**

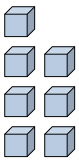

zehnern einern

**10)**

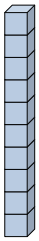

zehnern einern

**11)**

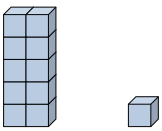

zehnern einern

## Antworten

Bsp. 4

1. _____
2. _____
3. _____
4. _____
5. _____
6. _____
7. _____
8. _____
9. _____
10. _____
11. _____



| | | | | | | | | | | |
|---|---|---|---|---|---|---|---|---|---|---|
| 1-10 | 91 | 82 | 73 | 64 | 55 | 45 | 36 | 27 | 18 | 9 |
| 11 | 0 | | | | | | | | | |

Visueller Stellenwert - weniger als 20 Name: **Lösungsschlüssel**

**Fülle die Lücken auf und finde die Zahlen.**

**Bsp)**

0 zehnern 4 einern

**1)**

0 zehnern 2 einern

**2)**

0 zehnern 1 einern

**3)**

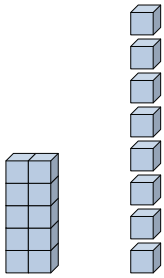

1 zehnern 8 einern

**4)**

0 zehnern 9 einern

**5)**

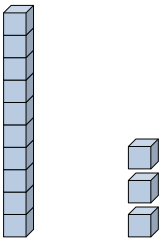

1 zehnern 3 einern

**6)**

0 zehnern 3 einern

**7)**

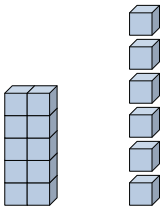

1 zehnern 6 einern

**8)**

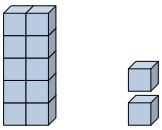

1 zehnern 2 einern

**9)**

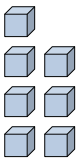

0 zehnern 7 einern

**10)**

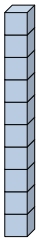

1 zehnern 0 einern

**11)**

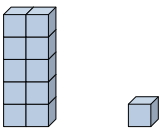

1 zehnern 1 einern

## Antworten

| | |
|---|---|
| Bsp. | 4 |
| 1. | 2 |
| 2. | 1 |
| 3. | 18 |
| 4. | 9 |
| 5. | 13 |
| 6. | 3 |
| 7. | 16 |
| 8. | 12 |
| 9. | 7 |
| 10. | 10 |
| 11. | 11 |



| | | | | | | | | | | |
|---|---|---|---|---|---|---|---|---|---|---|
| 1-10 | 91 | 82 | 73 | 64 | 55 | 45 | 36 | 27 | 18 | 9 |
| 11 | 0 | | | | | | | | | |