Identifizieren der Menge mit 100 Blöcken

Name:

Verwenden Sie die Blöcke, um die Gesamtmengen zu bestimmen.

Bsp)

5 hunderten = 50 zehnern = 500 einern

1)

_____ hunderten = _____ zehnern = _____ einern

2) 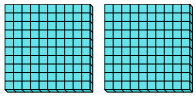

_____ hunderten = _____ zehnern = _____ einern

3) 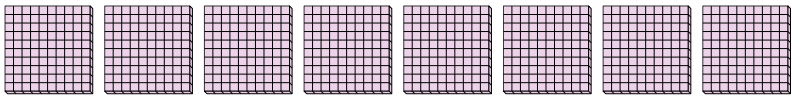

_____ hunderten = _____ zehnern = _____ einern

4) 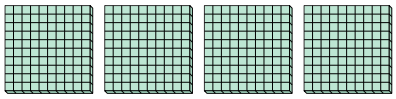

_____ hunderten = _____ zehnern = _____ einern

5) 

_____ hunderten = _____ zehnern = _____ einern

6) 

_____ hunderten = _____ zehnern = _____ einern

7) 

_____ hunderten = _____ zehnern = _____ einern

8) 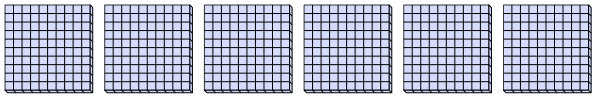

_____ hunderten = _____ zehnern = _____ einern

Antworten

Bsp.	5	50	500
1.			
2.			
3.			
4.			
5.			
6.			
7.			
8.			

1-8	88	75	63	50	38	25	13	0

Identifizieren der Menge mit 100 Blöcken

Name: **Lösungsschlüssel**

Verwenden Sie die Blöcke, um die Gesamtmengen zu bestimmen.

Bsp)

5 hunderten = 50 zehnern = 500 einern

1)

1 hunderten = 10 zehnern = 100 einern

2) 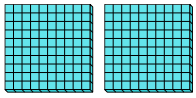

2 hunderten = 20 zehnern = 200 einern

3) 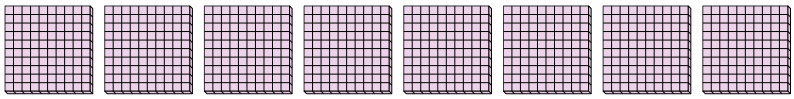

8 hunderten = 80 zehnern = 800 einern

4) 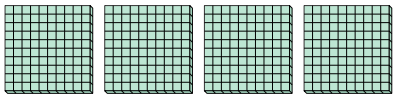

4 hunderten = 40 zehnern = 400 einern

5) 

3 hunderten = 30 zehnern = 300 einern

6) 

7 hunderten = 70 zehnern = 700 einern

7) 

9 hunderten = 90 zehnern = 900 einern

8) 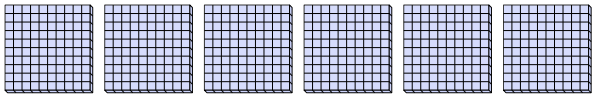

6 hunderten = 60 zehnern = 600 einern

Antworten

Bsp.	5	50	500
1.	1	10	100
2.	2	20	200
3.	8	80	800
4.	4	40	400
5.	3	30	300
6.	7	70	700
7.	9	90	900
8.	6	60	600

1-8	88	75	63	50	38	25	13	0