Gerade oder ungerade bestimmen - visuell

Name:

Bestimme, ob die Anzahl der Formen im Feld gerade oder ungerade ist.

1)

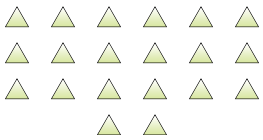

2)

3)

4)

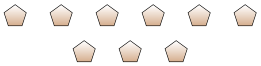

5)

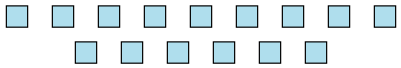

6)

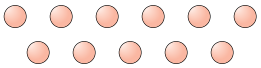

7)

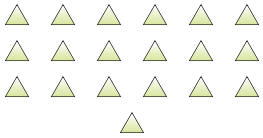

8)

9)

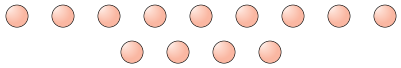

10)

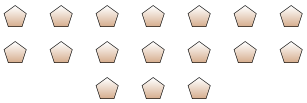

Antworten

1. _____
2. _____
3. _____
4. _____
5. _____
6. _____
7. _____
8. _____
9. _____
10. _____

1-10	90	80	70	60	50	40	30	20	10	0

Gerade oder ungerade bestimmen - visuell

Name: **Lösungsschlüssel**

Bestimme, ob die Anzahl der Formen im Feld gerade oder ungerade ist.

1) 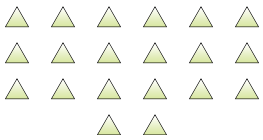

20

2)

6

3)

13

4) 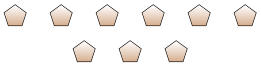

9

5) 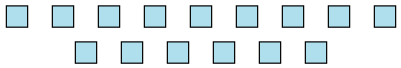

15

6) 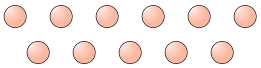

11

7) 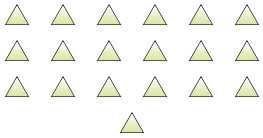

19

8)

8

9) 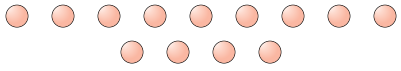

13

10) 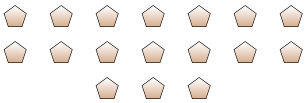

17

Antworten

1. gerade
2. gerade
3. ungerade
4. ungerade
5. ungerade
6. ungerade
7. ungerade
8. gerade
9. ungerade
10. ungerade