Ablesen einer Analoguhr

Name:

Bestimme die gezeigte Uhrzeit.

1)



2)

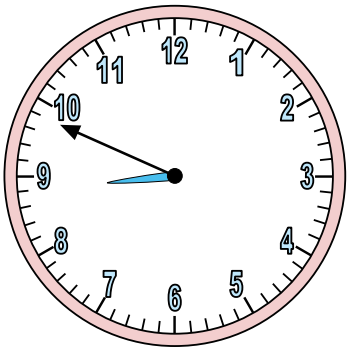

3)

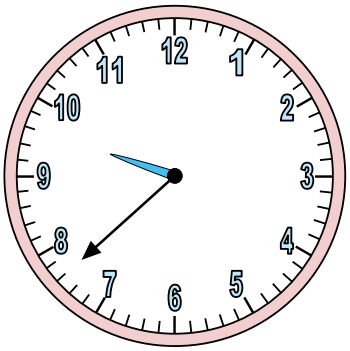

4)

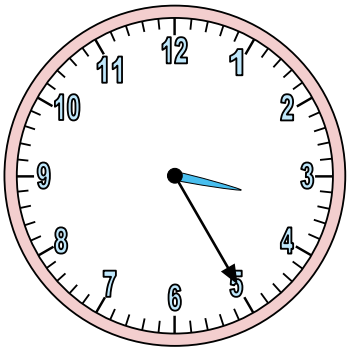

5)

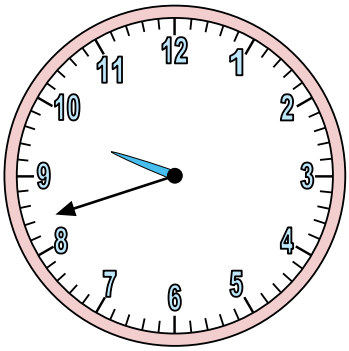

6)

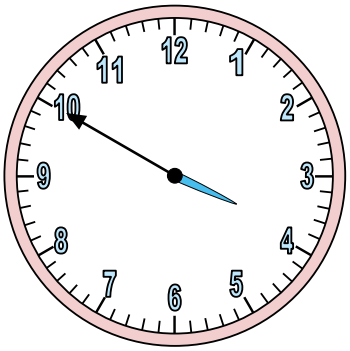

7)

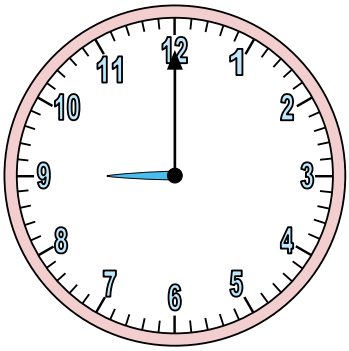

8)

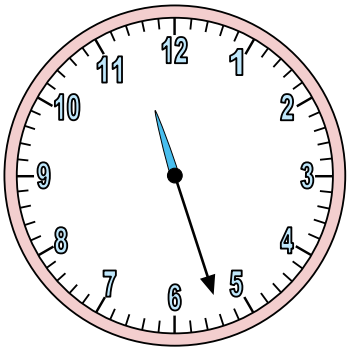

9)

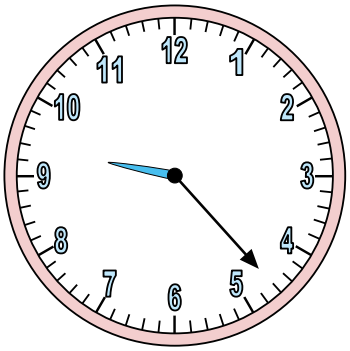

10)

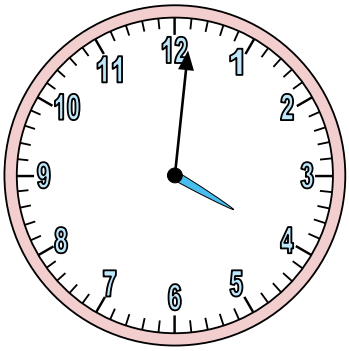

11)

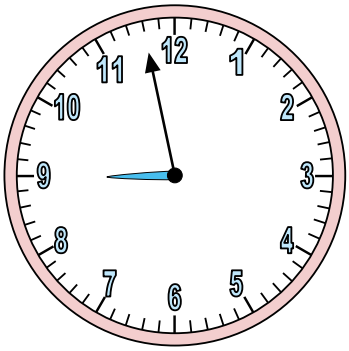

12)

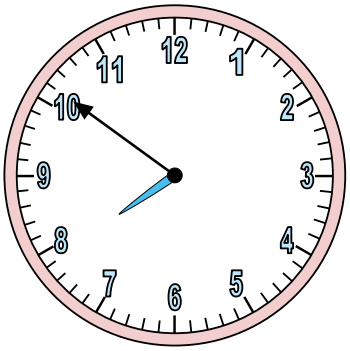

Antworten

1. _____
2. _____
3. _____
4. _____
5. _____
6. _____
7. _____
8. _____
9. _____
10. _____
11. _____
12. _____

Mathe

www.CommonCoreSheets.de

1-10	92	83	75	67	58	50	42	33	25	17
11-12	8	0								

Ablesen einer Analoguhr

Name: **Lösungsschlüssel**

Bestimme die gezeigte Uhrzeit.

1)


2)
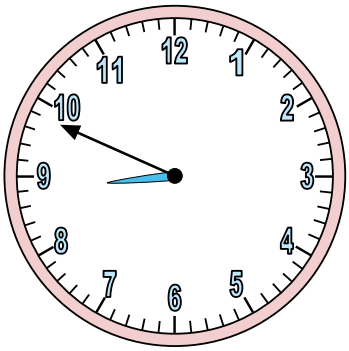

3)
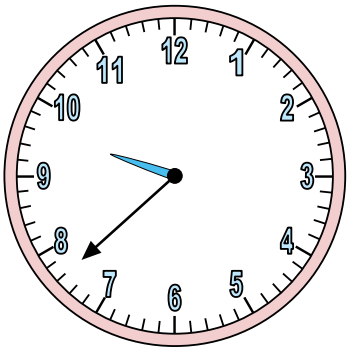

4)
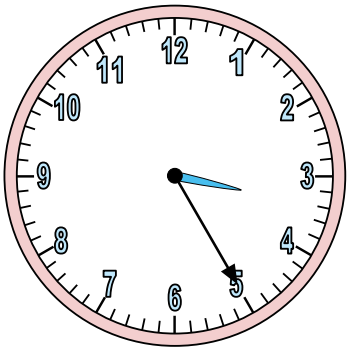

5)
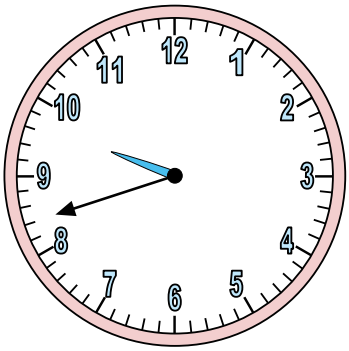

6)
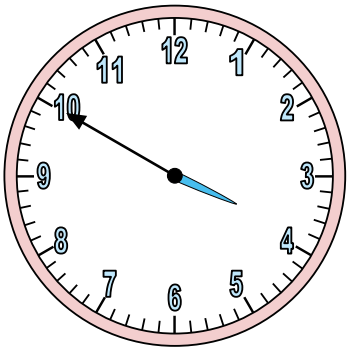

7)
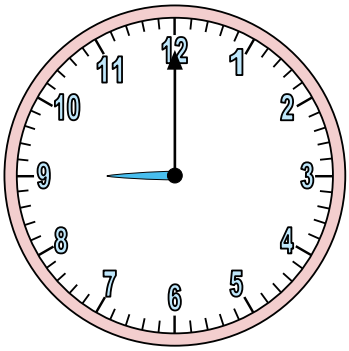

8)
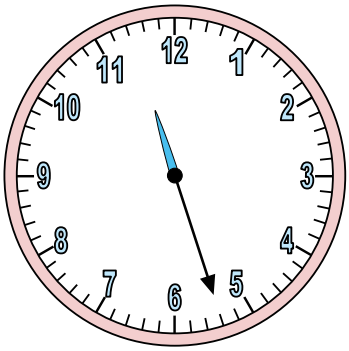

9)
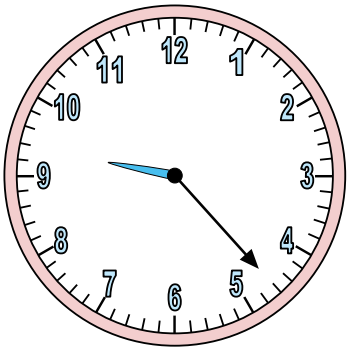

10)
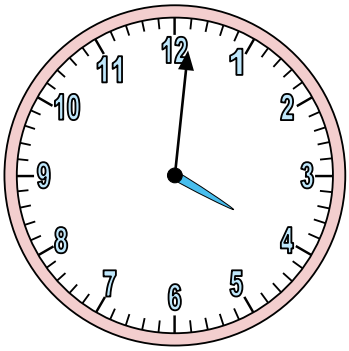

11)
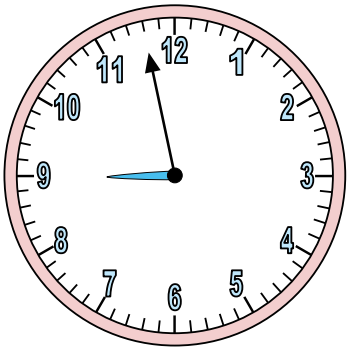

12)
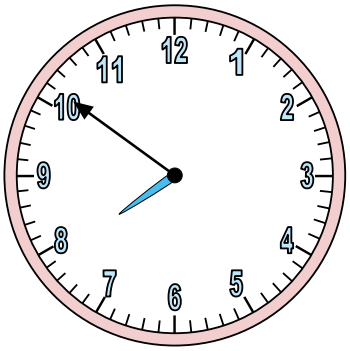

Antworten

1. **1:12**
2. **8:49**
3. **9:38**
4. **3:25**
5. **9:42**
6. **3:50**
7. **9:00**
8. **11:27**
9. **9:23**
10. **4:01**
11. **8:58**
12. **7:51**

1-10	92	83	75	67	58	50	42	33	25	17
11-12	8	0								