Lesen einer analogen Uhr

Name:

Bestimmen Sie die auf der Uhr angezeigte Zeit.

1) 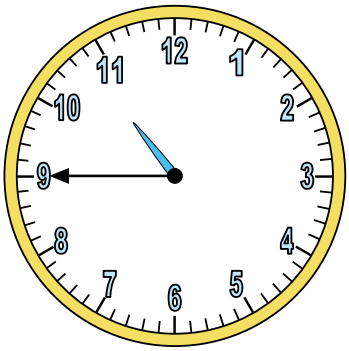

2) 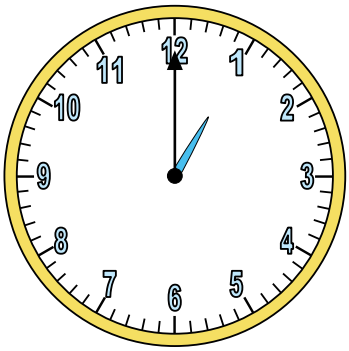

3) 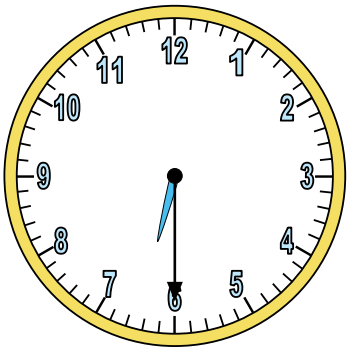

4) 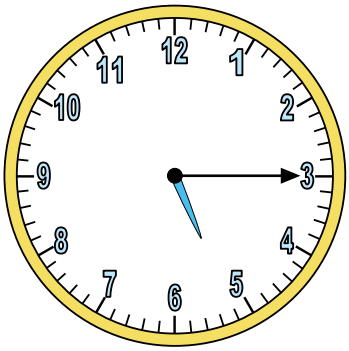

5) 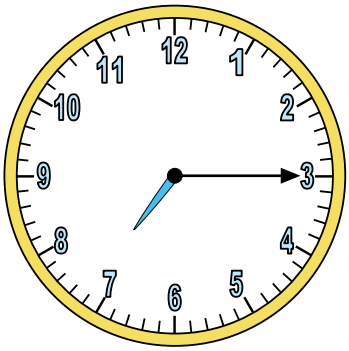

6) 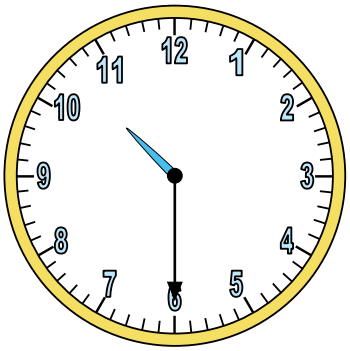

7) 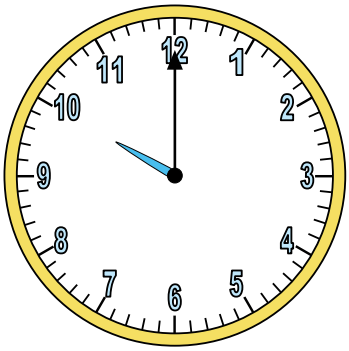

8) 

9) 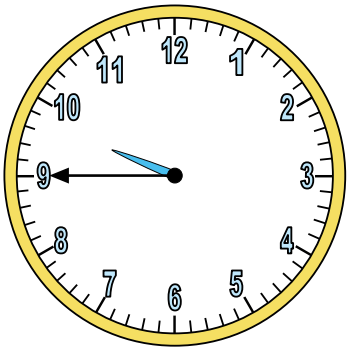

10) 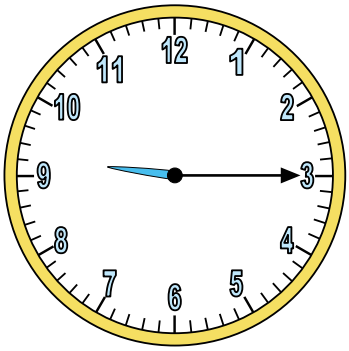

11) 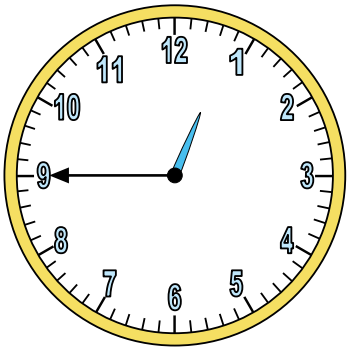

12) 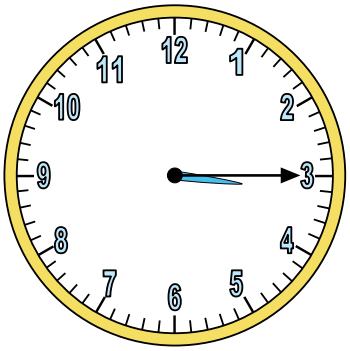

Antworten

1. _____
2. _____
3. _____
4. _____
5. _____
6. _____
7. _____
8. _____
9. _____
10. _____
11. _____
12. _____

1-10	92	83	75	67	58	50	42	33	25	17
11-12	8	0								

Lesen einer analogen Uhr

Name: **Lösungsschlüssel**

Bestimmen Sie die auf der Uhr angezeigte Zeit.

1) 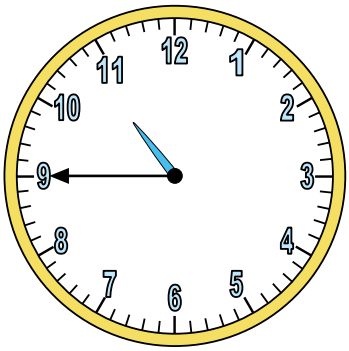

2) 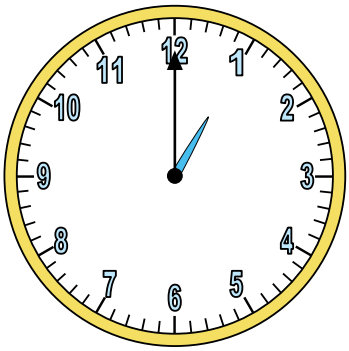

3) 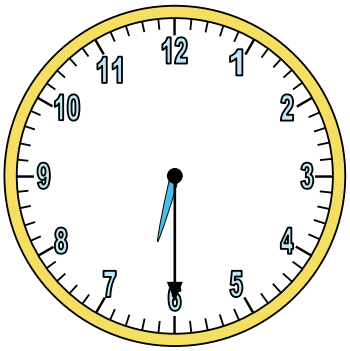

4) 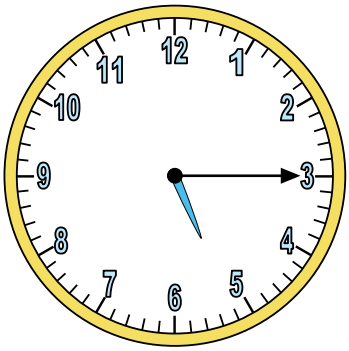

5) 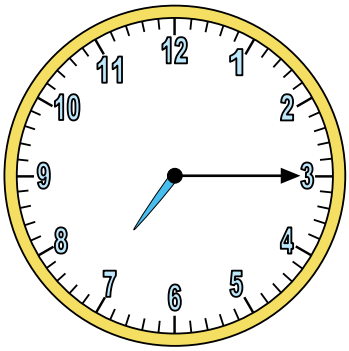

6) 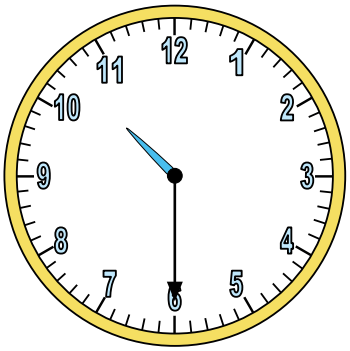

7) 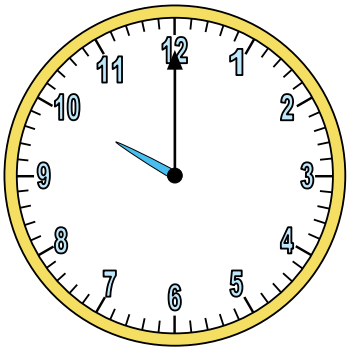

8) 

9) 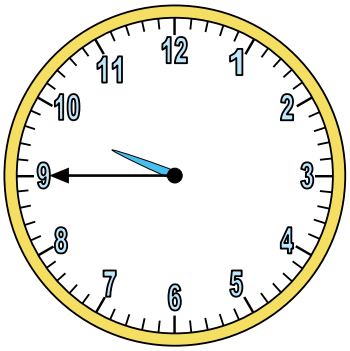

10) 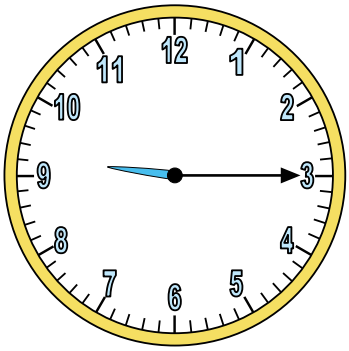

11) 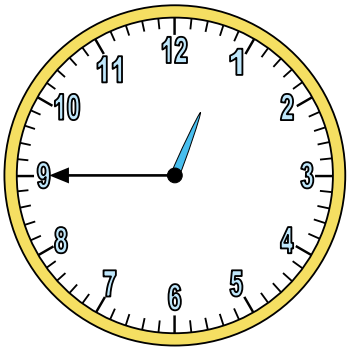

12) 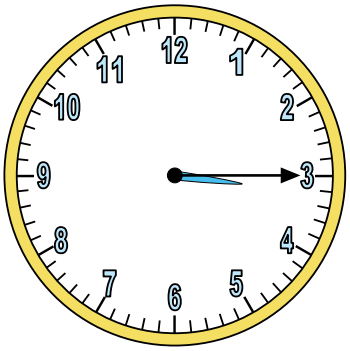

Antworten

1. **10:45**
2. **1:00**
3. **6:30**
4. **5:15**
5. **7:15**
6. **10:30**
7. **10:00**
8. **12:00**
9. **9:45**
10. **9:15**
11. **12:45**
12. **3:15**

1-10	92	83	75	67	58	50	42	33	25	17
11-12	8	0								