Finden der Startzeit mit einem Zahlenstrahl

Name:

Löse jede Aufgabe.

1) Beginn: _____
Elapsed: 2 Std. und 20 Min.
Ende: 9:25

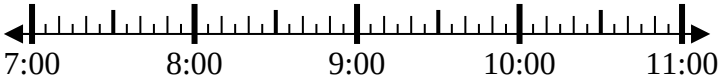

2) Beginn: _____
Elapsed: 2 Std. und 20 Min.
Ende: 7:45

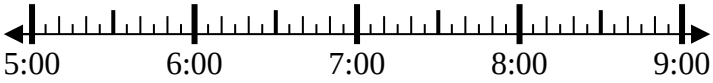

3) Beginn: _____
Elapsed: 1 Std. und 35 Min.
Ende: 5:50

4) Beginn: _____
Elapsed: 2 Std. und 40 Min.
Ende: 2:45

5) Beginn: _____
Elapsed: 1 Std. und 45 Min.
Ende: 11:50

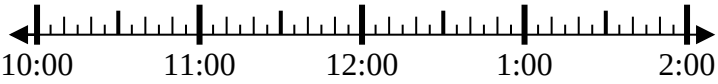

6) Beginn: _____
Elapsed: 2 Std. und 15 Min.
Ende: 2:00

7) Beginn: _____
Elapsed: 1 Std. und 40 Min.
Ende: 7:05

8) Beginn: _____
Elapsed: 1 Std. und 15 Min.
Ende: 2:40

Antworten

1. _____
2. _____
3. _____
4. _____
5. _____
6. _____
7. _____
8. _____

1-8	88	75	63	50	38	25	13	0

Finden der Startzeit mit einem Zahlenstrahl

Name: **Lösungsschlüssel**

Löse jede Aufgabe.

1) Beginn: 7:05
Elapsed: 2 Std. und 20 Min.
Ende: 9:25

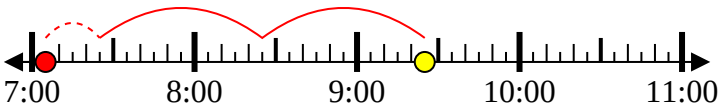

2) Beginn: 5:25
Elapsed: 2 Std. und 20 Min.
Ende: 7:45

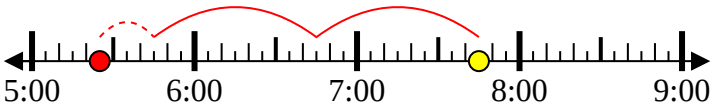

3) Beginn: 4:15
Elapsed: 1 Std. und 35 Min.
Ende: 5:50

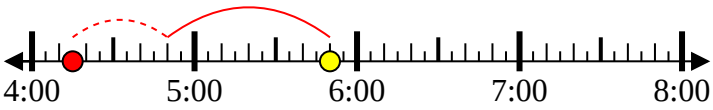

4) Beginn: 12:05
Elapsed: 2 Std. und 40 Min.
Ende: 2:45

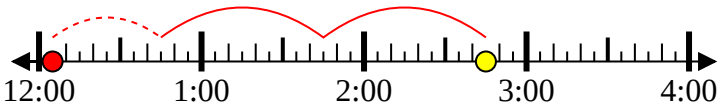

5) Beginn: 10:05
Elapsed: 1 Std. und 45 Min.
Ende: 11:50

6) Beginn: 11:45
Elapsed: 2 Std. und 15 Min.
Ende: 2:00

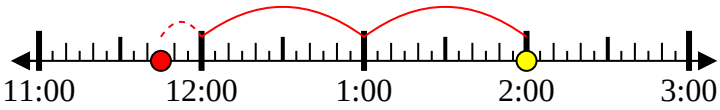

7) Beginn: 5:25
Elapsed: 1 Std. und 40 Min.
Ende: 7:05

8) Beginn: 1:25
Elapsed: 1 Std. und 15 Min.
Ende: 2:40

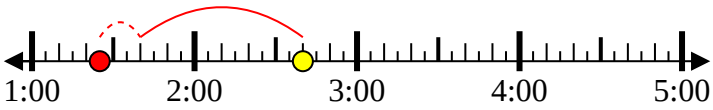

Antworten

1. **7:05**
2. **5:25**
3. **4:15**
4. **12:05**
5. **10:05**
6. **11:45**
7. **5:25**
8. **1:25**

1-8	88	75	63	50	38	25	13	0