Symmetrie bestimmen

Name:

Bestimme, ob die Linie durch jede Figur eine symmetrische Linie ist.

Bsp)

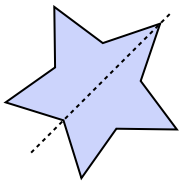

1)

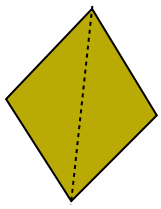

2)

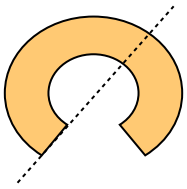

3)

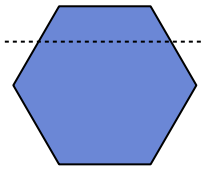

4)

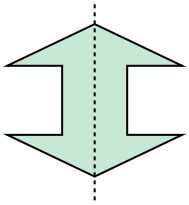

5)

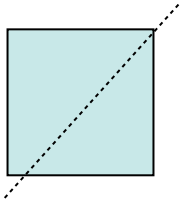

6)

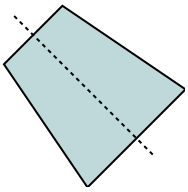

7)

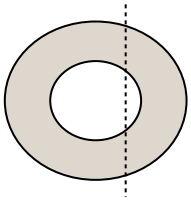

8)

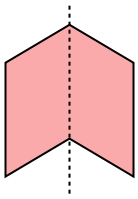

9)

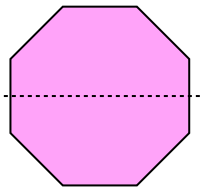

10)

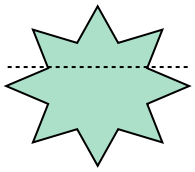

11)

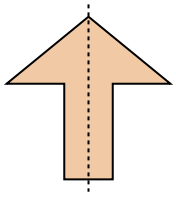

Antworten

Bsp. ja

1. _____
2. _____
3. _____
4. _____
5. _____
6. _____
7. _____
8. _____
9. _____
10. _____
11. _____

1-10	91	82	73	64	55	45	36	27	18	9
11	0									

Symmetrie bestimmen

Name: **Lösungsschlüssel**

Bestimme, ob die Linie durch jede Figur eine symmetrische Linie ist.

Bsp)

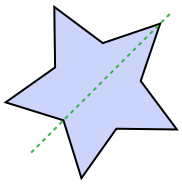

1)

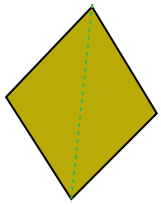

2)

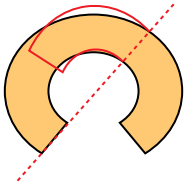

3)

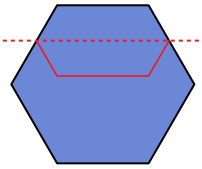

4)

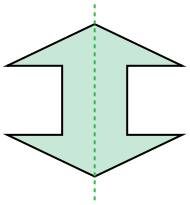

5)

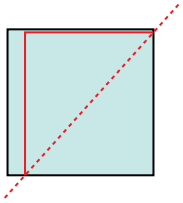

6)

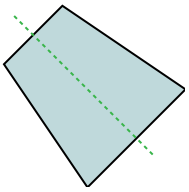

7)

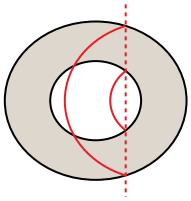

8)

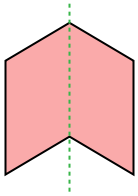

9)

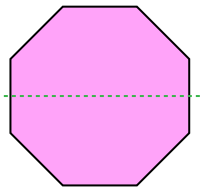

10)

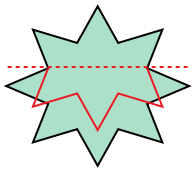

11)

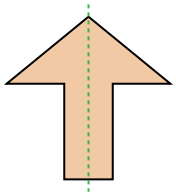

Antworten

Bsp.	ja
1.	ja
2.	no
3.	no
4.	ja
5.	no
6.	ja
7.	no
8.	ja
9.	ja
10.	no
11.	ja

1-10	91	82	73	64	55	45	36	27	18	9
11	0									