Regelmäßige Formen identifizieren

Name:

Identifiziere die Art der gezeigten Form.

1)

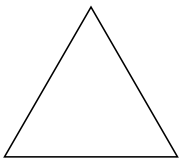

2)

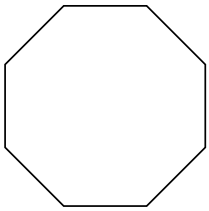

3)

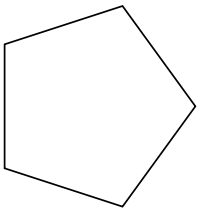

4)



5)

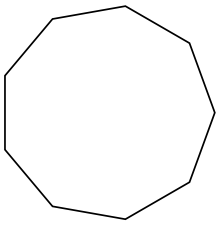

6)

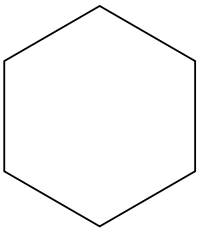

7)

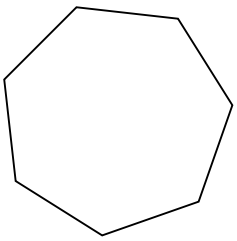

8)

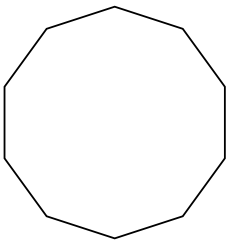

Antworten

1. _____
2. _____
3. _____
4. _____
5. _____
6. _____
7. _____
8. _____

1-8	88	75	63	50	38	25	13	0

Regelmäßige Formen identifizieren

Name: **Lösungsschlüssel**

Identifiziere die Art der gezeigten Form.

1)

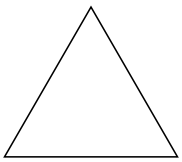

2)

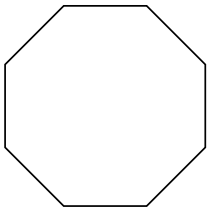

3)

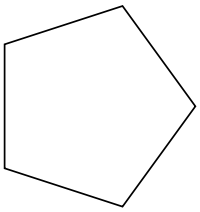

4)



5)

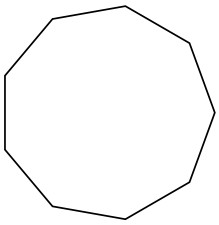

6)

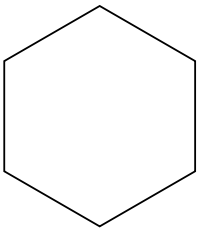

7)

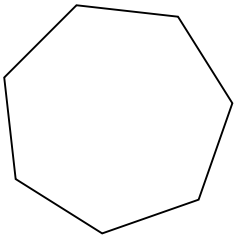

8)

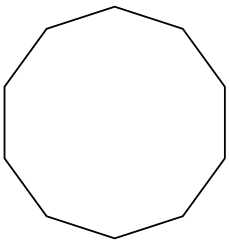

Antworten

1. **triangle**
2. **Achteck**
3. **Fünfeck**
4. **Viereck**
5. **Neuneck**
6. **Sechseck**
7. **Siebeneck**
8. **Zehneck**

1-8	88	75	63	50	38	25	13	0