Regelmäßige Formen identifizieren Name:

Identifiziere die Art der gezeigten Form.

1)

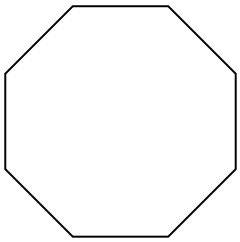

2)

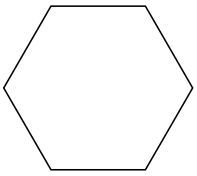

3)



4)

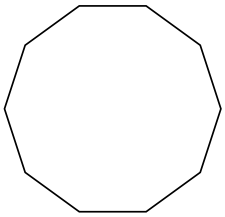

5)

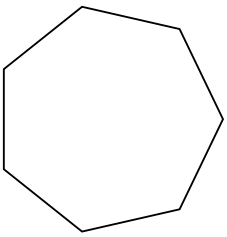

6)

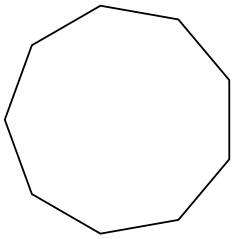

7)

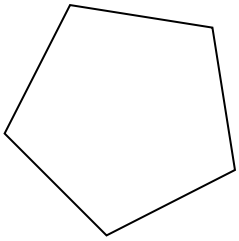

8)

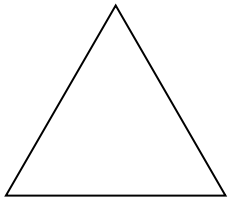

Antworten

1. _____
2. _____
3. _____
4. _____
5. _____
6. _____
7. _____
8. _____

1-8	88	75	63	50	38	25	13	0

Regelmäßige Formen identifizieren

Name: **Lösungsschlüssel**

Identifiziere die Art der gezeigten Form.

1)

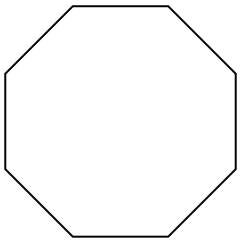

2)

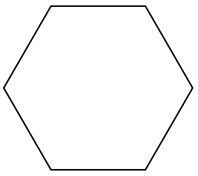

3)



4)

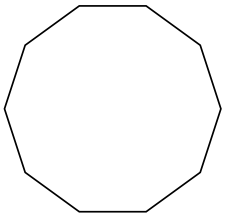

5)

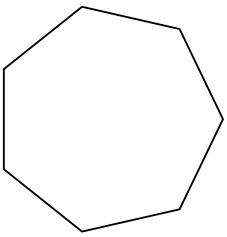

6)

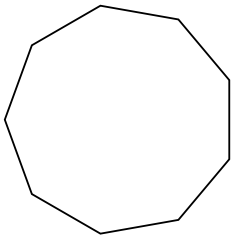

7)

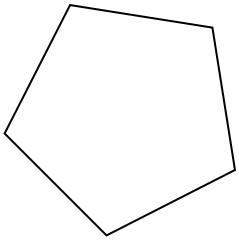

8)

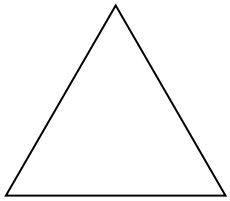

Antworten

1. **Achteck**
2. **Sechseck**
3. **Viereck**
4. **Zehneck**
5. **Siebeneck**
6. **Neuneck**
7. **Fünfeck**
8. **triangle**

1-8	88	75	63	50	38	25	13	0

Regelmäßige Formen identifizieren Name:

Identifiziere die Art der gezeigten Form.

1)

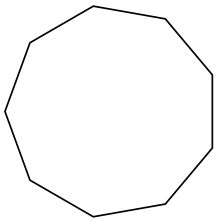

2)

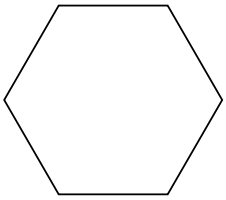

3)

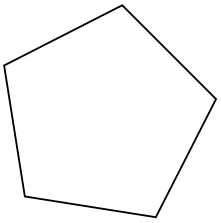

4)

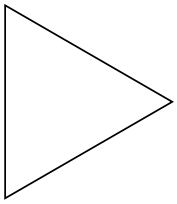

5)



6)

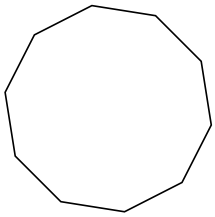

7)

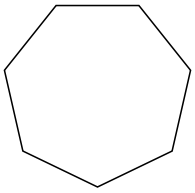

8)

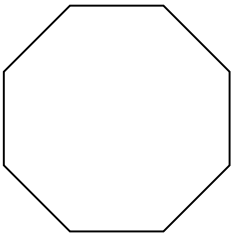

Antworten

1. _____
2. _____
3. _____
4. _____
5. _____
6. _____
7. _____
8. _____

1-8	88	75	63	50	38	25	13	0

Regelmäßige Formen identifizieren

Name: **Lösungsschlüssel**

Identifiziere die Art der gezeigten Form.

1)

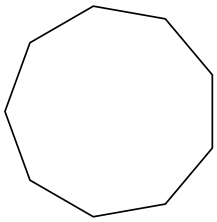

2)

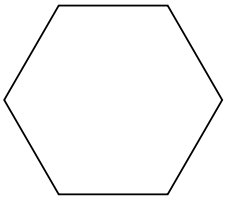

3)

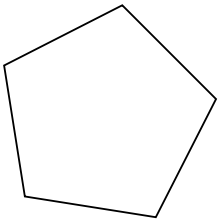

4)

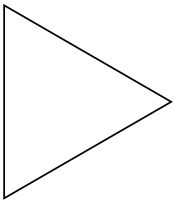

5)



6)

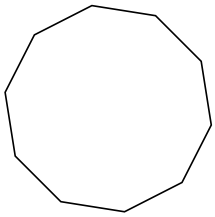

7)

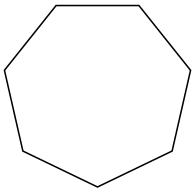

8)

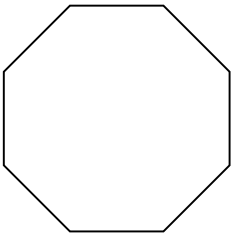

Antworten

1. **Neuneck**
2. **Sechseck**
3. **Fünfeck**
4. **triangle**
5. **Viereck**
6. **Zehneck**
7. **Siebeneck**
8. **Achteck**

1-8	88	75	63	50	38	25	13	0

Regelmäßige Formen identifizieren Name:

Identifiziere die Art der gezeigten Form.

1)

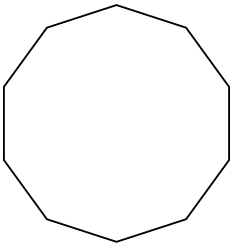

2)

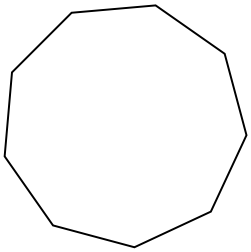

3)

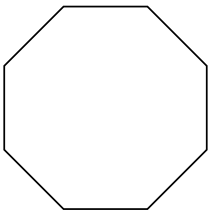

4)

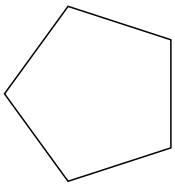

5)

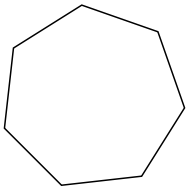

6)

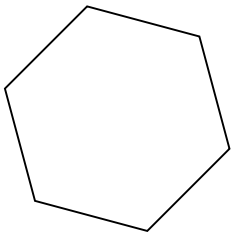

7)



8)



Antworten

1. _____
2. _____
3. _____
4. _____
5. _____
6. _____
7. _____
8. _____

1-8	88	75	63	50	38	25	13	0

Regelmäßige Formen identifizieren

Name: **Lösungsschlüssel**

Identifiziere die Art der gezeigten Form.

1)

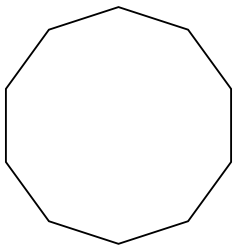

2)

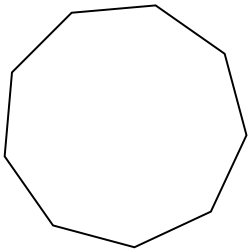

3)

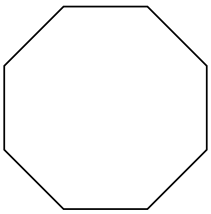

4)

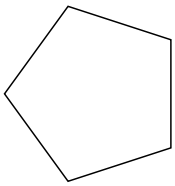

5)

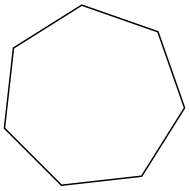

6)

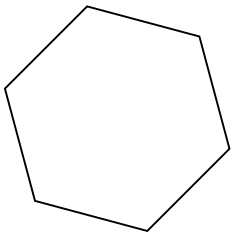

7)



8)



Antworten

1. **Zehneck**
2. **Neuneck**
3. **Achteck**
4. **Fünfeck**
5. **Siebeneck**
6. **Sechseck**
7. **triangle**
8. **Viereck**

1-8	88	75	63	50	38	25	13	0

Regelmäßige Formen identifizieren Name:

Identifiziere die Art der gezeigten Form.

1)

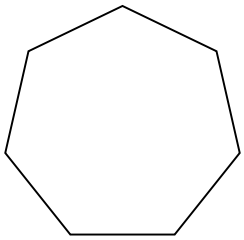

2)

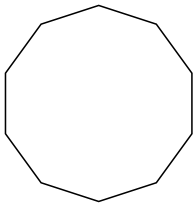

3)

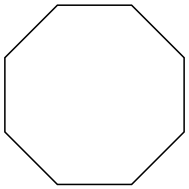

4)

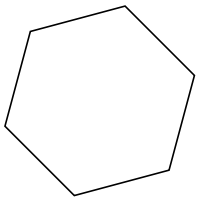

5)

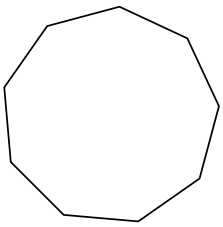

6)

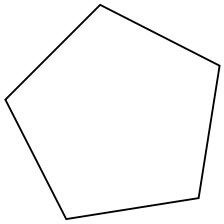

7)

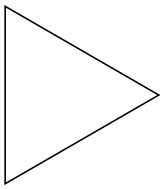

8)



Antworten

1. _____
2. _____
3. _____
4. _____
5. _____
6. _____
7. _____
8. _____

1-8	88	75	63	50	38	25	13	0

Regelmäßige Formen identifizieren

Name: **Lösungsschlüssel**

Identifiziere die Art der gezeigten Form.

1)

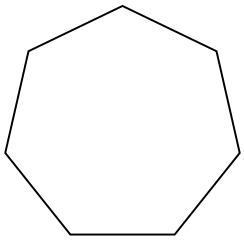

2)

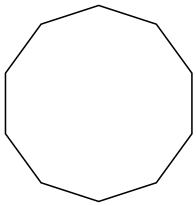

3)

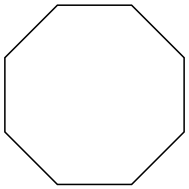

4)

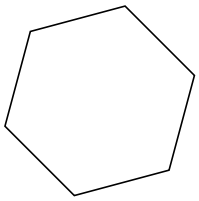

5)

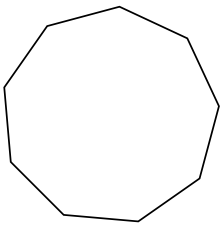

6)

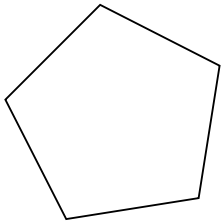

7)

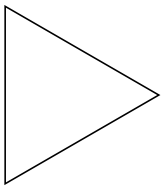

8)



Antworten

1. **Siebeneck**
2. **Zehneck**
3. **Achteck**
4. **Sechseck**
5. **Neuneck**
6. **Fünfeck**
7. **triangle**
8. **Viereck**

1-8	88	75	63	50	38	25	13	0

Regelmäßige Formen identifizieren Name:

Identifiziere die Art der gezeigten Form.

1)

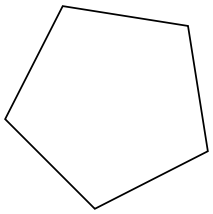

2)



3)

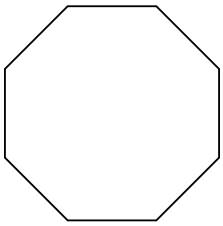

4)

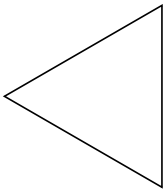

5)

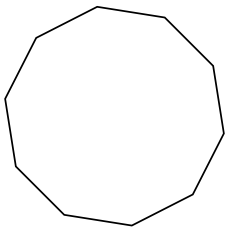

6)

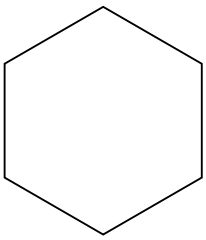

7)

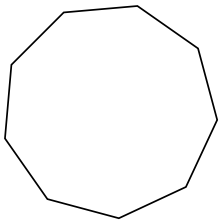

8)

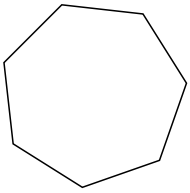

Antworten

1. _____
2. _____
3. _____
4. _____
5. _____
6. _____
7. _____
8. _____

1-8	88	75	63	50	38	25	13	0

Regelmäßige Formen identifizieren

Name: **Lösungsschlüssel**

Identifiziere die Art der gezeigten Form.

1)

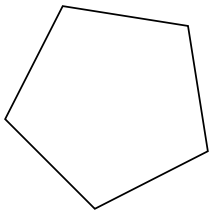

2)



3)

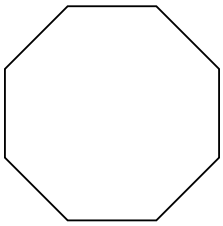

4)

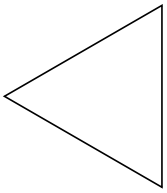

5)

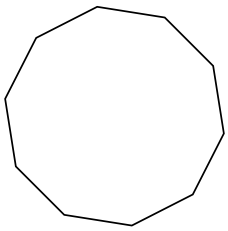

6)

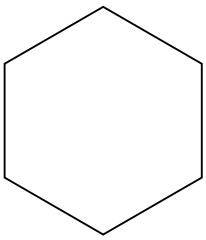

7)

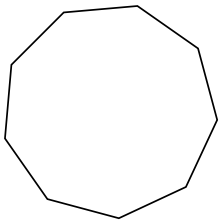

8)

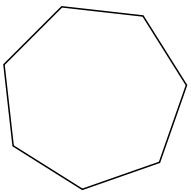

Antworten

1. **Fünfeck**
2. **Viereck**
3. **Achteck**
4. **triangle**
5. **Zehneck**
6. **Sechseck**
7. **Neuneck**
8. **Siebeneck**

1-8	88	75	63	50	38	25	13	0

Regelmäßige Formen identifizieren Name:

Identifiziere die Art der gezeigten Form.

1)

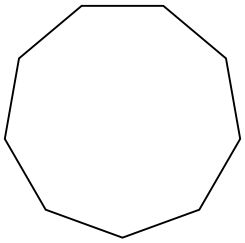

2)

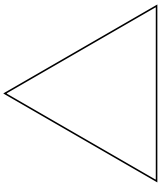

3)

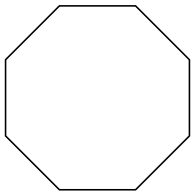

4)

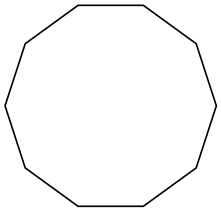

5)



6)

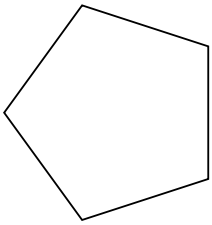

7)

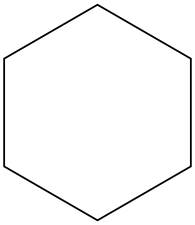

8)

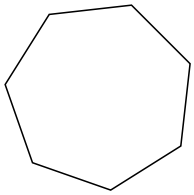

Antworten

1. _____
2. _____
3. _____
4. _____
5. _____
6. _____
7. _____
8. _____

1-8	88	75	63	50	38	25	13	0

Regelmäßige Formen identifizieren

Name: **Lösungsschlüssel**

Identifiziere die Art der gezeigten Form.

1)

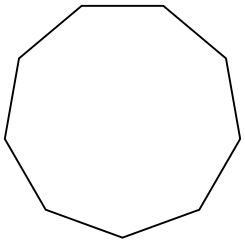

2)

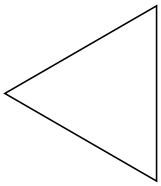

3)

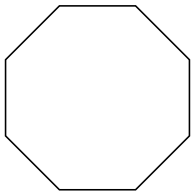

4)

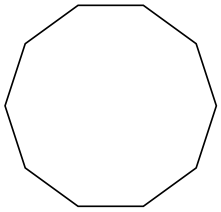

5)



6)

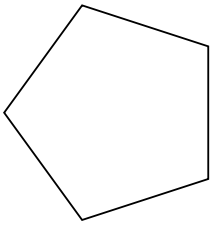

7)

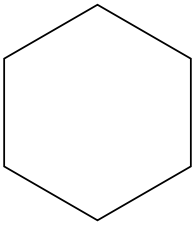

8)

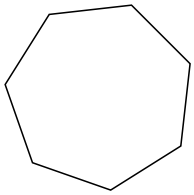

Antworten

1. **Neuneck**
2. **triangle**
3. **Achteck**
4. **Zehneck**
5. **Viereck**
6. **Fünfeck**
7. **Sechseck**
8. **Siebeneck**

1-8	88	75	63	50	38	25	13	0

Regelmäßige Formen identifizieren

Name:

Identifiziere die Art der gezeigten Form.

1)

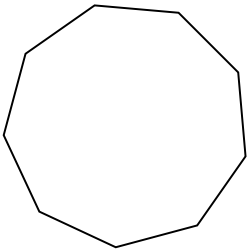

2)

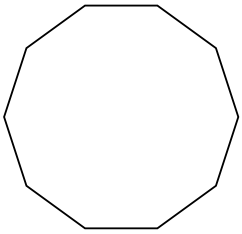

3)



4)

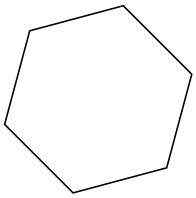

5)

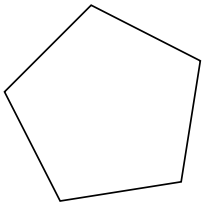

6)

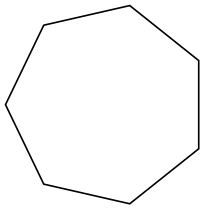

7)

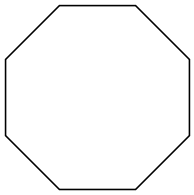

8)



Antworten

1. _____
2. _____
3. _____
4. _____
5. _____
6. _____
7. _____
8. _____

1-8	88	75	63	50	38	25	13	0

Regelmäßige Formen identifizieren

Name: **Lösungsschlüssel**

Identifiziere die Art der gezeigten Form.

1)

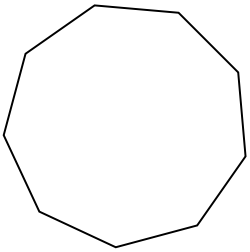

2)

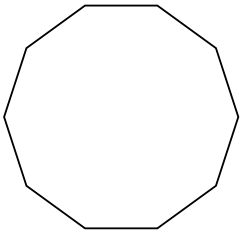

3)



4)

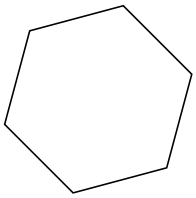

5)

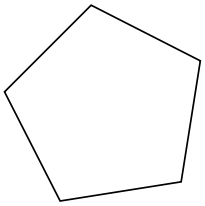

6)

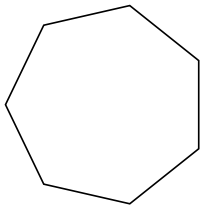

7)

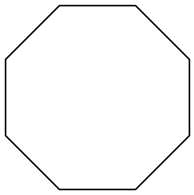

8)



Antworten

1. **Neuneck**
2. **Zehneck**
3. **triangle**
4. **Sechseck**
5. **Fünfeck**
6. **Siebeneck**
7. **Achteck**
8. **Viereck**

1-8	88	75	63	50	38	25	13	0

Regelmäßige Formen identifizieren

Name:

Identifiziere die Art der gezeigten Form.

1)

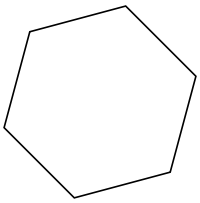

2)

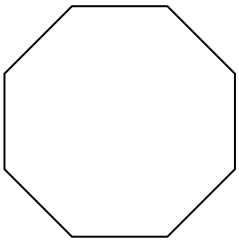

3)

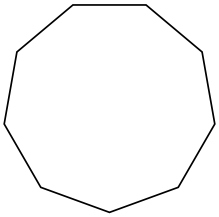

4)

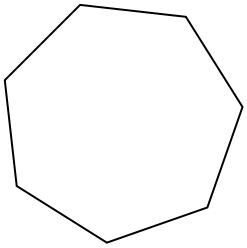

5)



6)

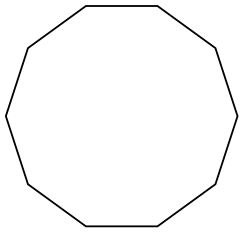

7)



8)

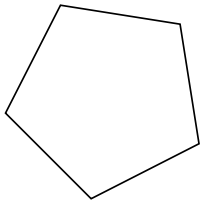

Antworten

1. _____
2. _____
3. _____
4. _____
5. _____
6. _____
7. _____
8. _____

1-8	88	75	63	50	38	25	13	0

Regelmäßige Formen identifizieren

Name: **Lösungsschlüssel**

Identifiziere die Art der gezeigten Form.

1)

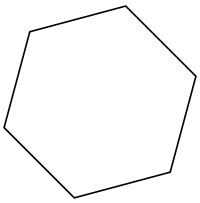

2)

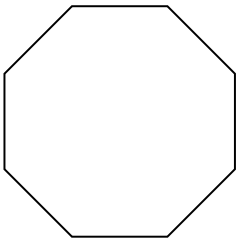

3)

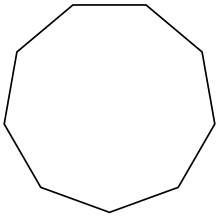

4)

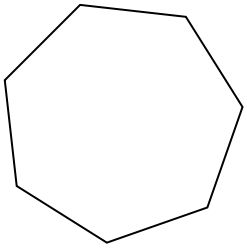

5)



6)

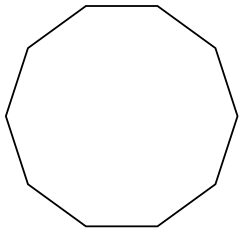

7)



8)

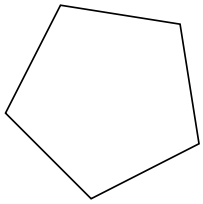

Antworten

1. **Sechseck**
2. **Achteck**
3. **Neuneck**
4. **Siebeneck**
5. **Viereck**
6. **Zehneck**
7. **triangle**
8. **Fünfeck**

1-8	88	75	63	50	38	25	13	0

Regelmäßige Formen identifizieren Name:

Identifiziere die Art der gezeigten Form.

1)

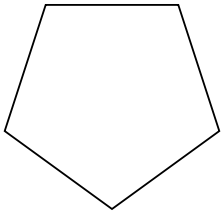

2)

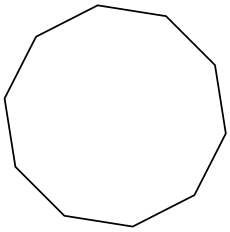

3)

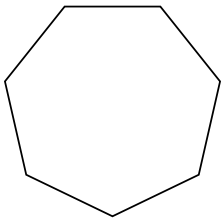

4)

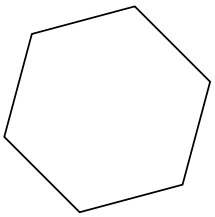

5)



6)

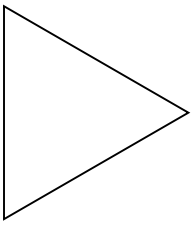

7)

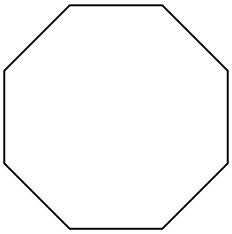

8)

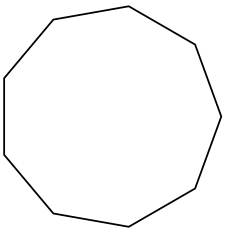

Antworten

1. _____
2. _____
3. _____
4. _____
5. _____
6. _____
7. _____
8. _____

1-8	88	75	63	50	38	25	13	0

Regelmäßige Formen identifizieren

Name: **Lösungsschlüssel**

Identifiziere die Art der gezeigten Form.

1)

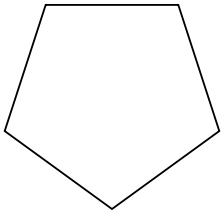

2)

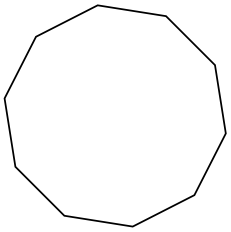

3)

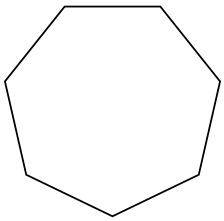

4)

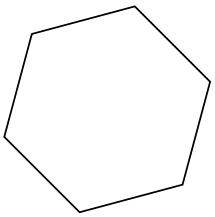

5)



6)

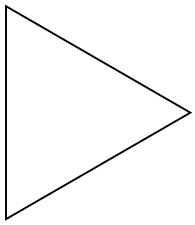

7)

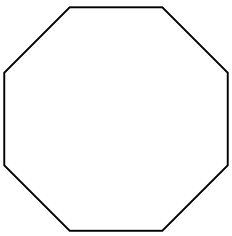

8)

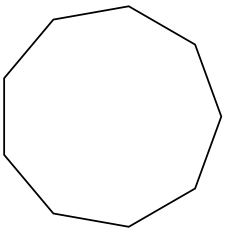

Antworten

1. **Fünfeck**
2. **Zehneck**
3. **Siebeneck**
4. **Sechseck**
5. **Viereck**
6. **triangle**
7. **Achteck**
8. **Neuneck**

1-8	88	75	63	50	38	25	13	0

Regelmäßige Formen identifizieren Name:

Identifiziere die Art der gezeigten Form.

1)

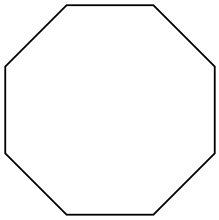

2)

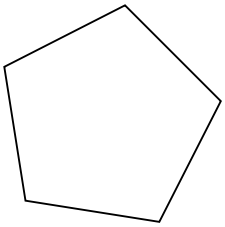

3)

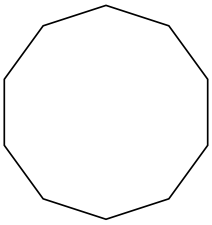

4)



5)

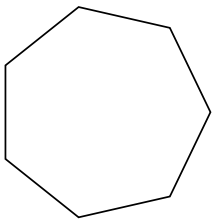

6)

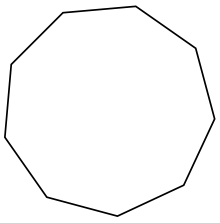

7)

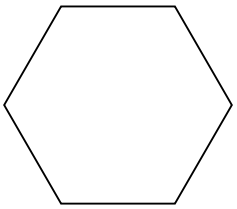

8)



Antworten

1. _____
2. _____
3. _____
4. _____
5. _____
6. _____
7. _____
8. _____

1-8	88	75	63	50	38	25	13	0

Regelmäßige Formen identifizieren

Name: **Lösungsschlüssel**

Identifiziere die Art der gezeigten Form.

1)

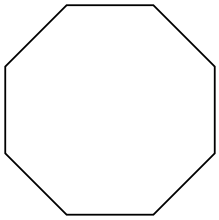

2)

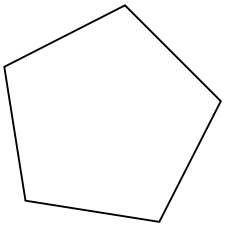

3)

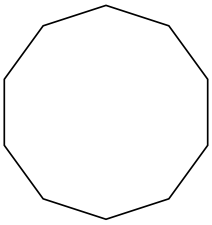

4)



5)

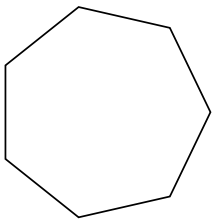

6)

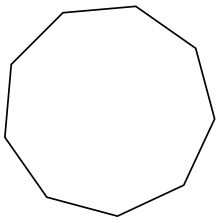

7)

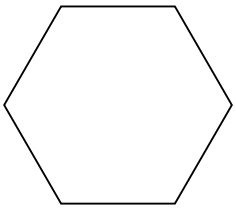

8)



Antworten

1. **Achteck**
2. **Fünfeck**
3. **Zehneck**
4. **triangle**
5. **Siebeneck**
6. **Neuneck**
7. **Sechseck**
8. **Viereck**

1-8	88	75	63	50	38	25	13	0