Formen klassifizieren

Name:

Stelle fest, um was es sich bei den gezeigten Formen handelt: Viereck, Drachenviereck,Trapez, Parallelogramm, Raute, Rechteck oder Quadrat (eine Figur kann mehrere Formen haben).

1)

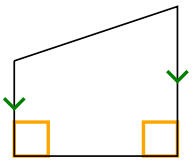

2)

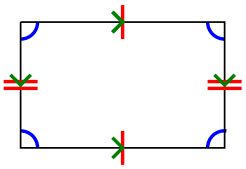

3)

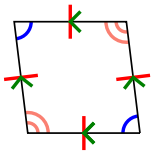

4)

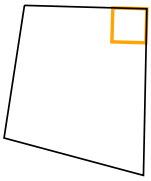

5)

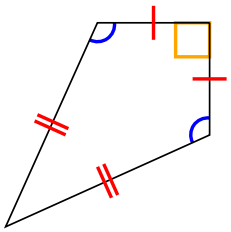

6)

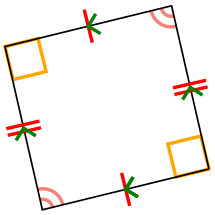

7)



8)

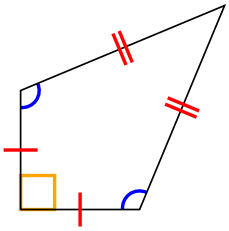

9)

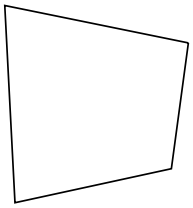

10)

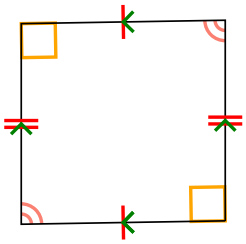

11)

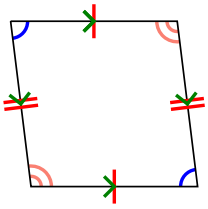

12)

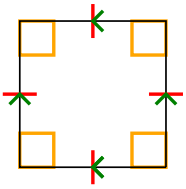

Antworten

1. _____
2. _____
3. _____
4. _____
5. _____
6. _____
7. _____
8. _____
9. _____
10. _____
11. _____
12. _____

1-10	92	83	75	67	58	50	42	33	25	17
11-12	8	0								

Formen klassifizieren

Name: **Lösungsschlüssel**

Stelle fest, um was es sich bei den gezeigten Formen handelt: Viereck, Drachenviereck,Trapez, Parallelogramm, Raute, Rechteck oder Quadrat (eine Figur kann mehrere Formen haben).

1)

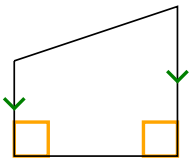

2)

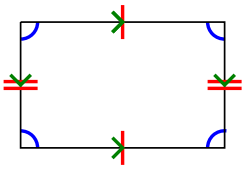

3)

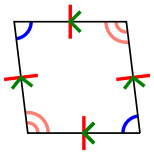

4)

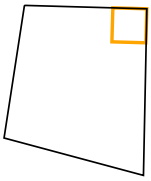

5)

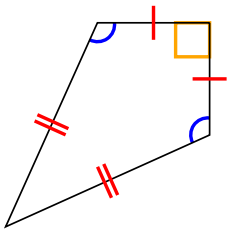

6)

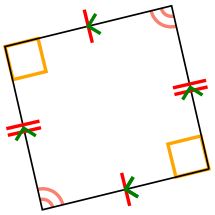

7)



8)

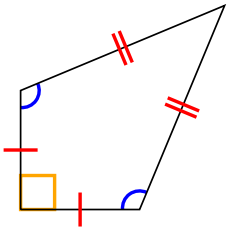

9)

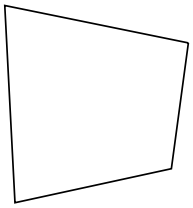

10)

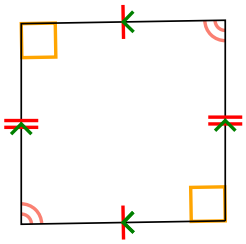

11)

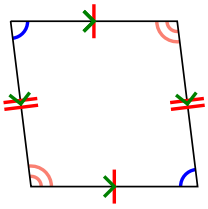

12)

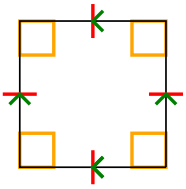

Antworten

1. Q,T
2. Q,P
3. Q,P,H
4. Q
5. Q,K
6. Q,P
7. Q
8. Q,K
9. Q
10. Q,P
11. Q,P
12. Q,P,H,R,S

Mathe

www.CommonCoreSheets.de

1-10	92	83	75	67	58	50	42	33	25	17
11-12	8	0								