Runden auf 10er (mit Zahlenstrahl)

Name:

Benutze den Zahlenstrahl um jede Zahl auf die nächste Zehnerstelle zu runden.

Bsp) 91

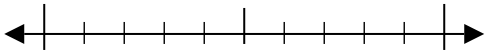

1) 98

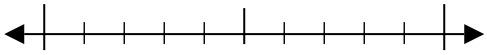

2) 47

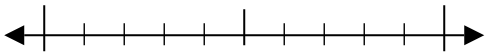

3) 29

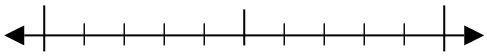

4) 381

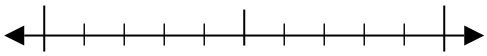

5) 223

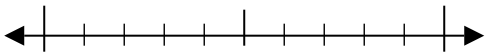

6) 992

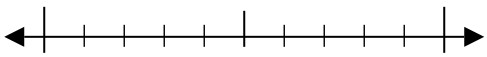

7) 540

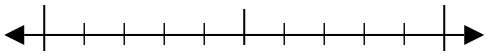

8) 6.549

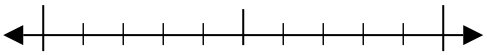

9) 3.575

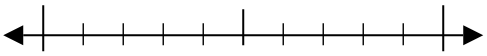

Antworten

Bsp. 90

1. _____
2. _____
3. _____
4. _____
5. _____
6. _____
7. _____
8. _____
9. _____

Runden auf 10er (mit Zahlenstrahl) Name: **Lösungsschlüssel**

Benutze den Zahlenstrahl um jede Zahl auf die nächste Zehnerstelle zu runden.

Bsp)

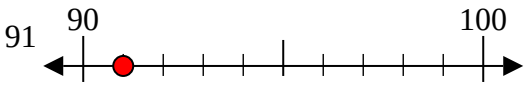

1)

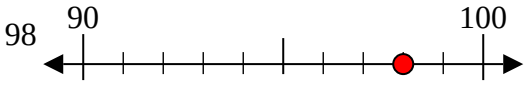

2)

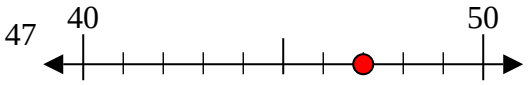

3)

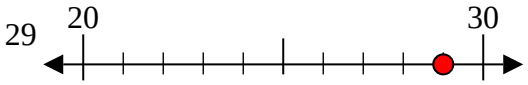

4)

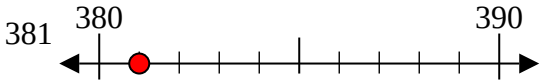

5)

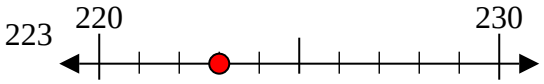

6)

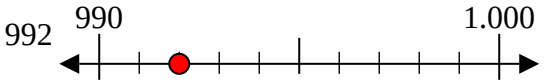

7)

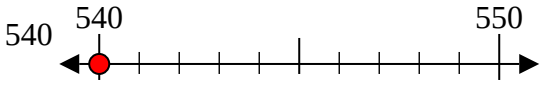

8)

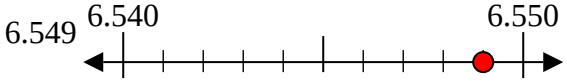

9)

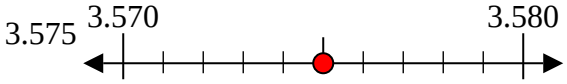

Antworten

Bsp.	90
1.	100
2.	50
3.	30
4.	380
5.	220
6.	990
7.	540
8.	6550
9.	3580