Bestimmen Sie, was der Wert von A in jedem Problem bedeutet.

1)

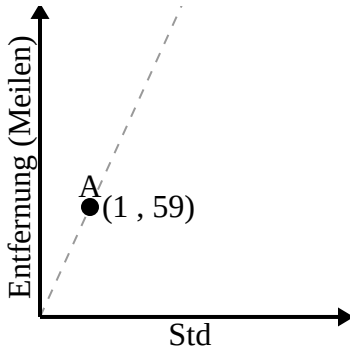

2)

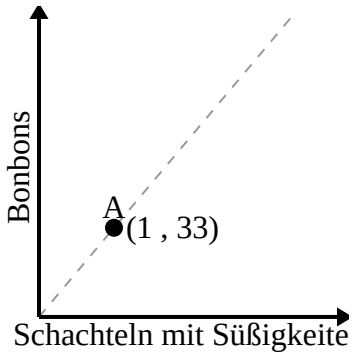

3)

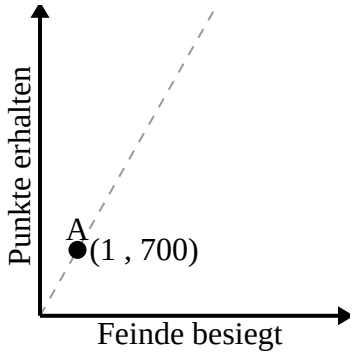

4)

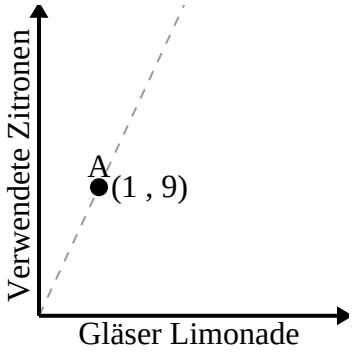

5)

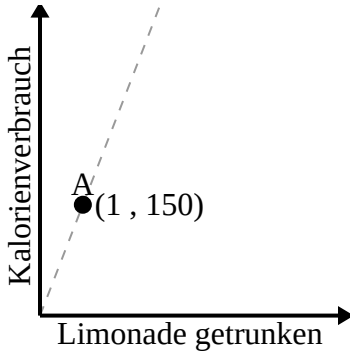

6)

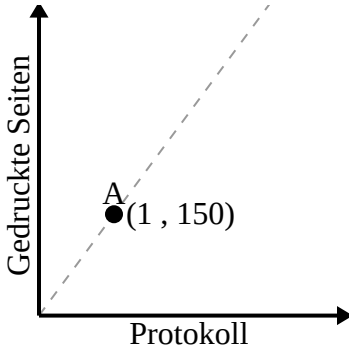

1-6	83	67	50	33	17	0

Bestimmen Sie, was der Wert von A in jedem Problem bedeutet.

1)

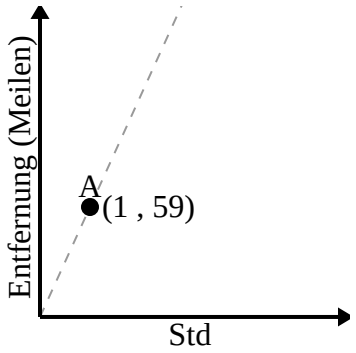

Jede Stunde werden 59 Meilen zurückgelegt.

2)

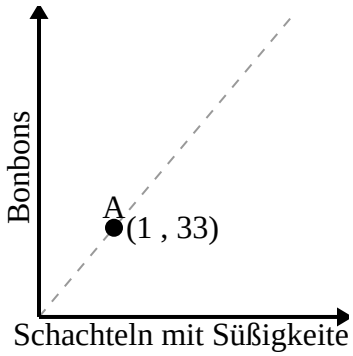

Jede Schachtel Bonbons enthält 33 Bonbons.

3)

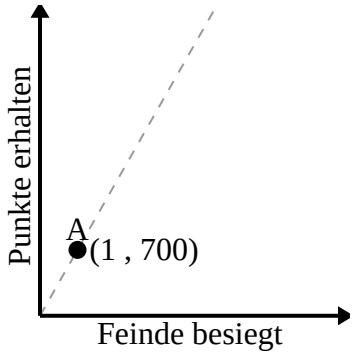

Für jeden besiegten Feind werden 700 Punkte verdient.

4)

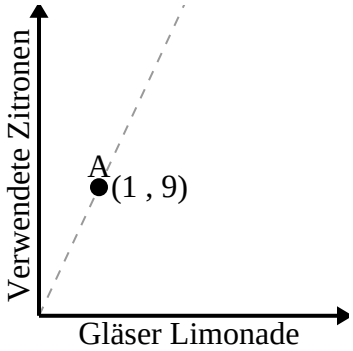

Jedes Glas Limonade benötigt 9 Zitronen.

5)

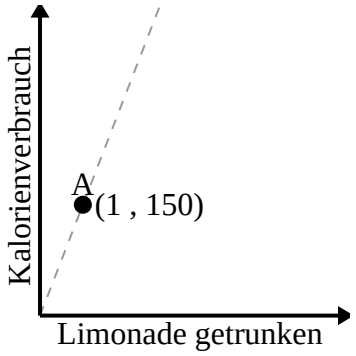

Für jede getrunkene Limonade werden 150 Kalorien verbraucht.

6)

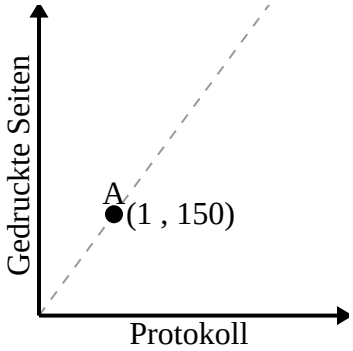

Jede Minute werden 150 Seiten gedruckt.

1-6	83	67	50	33	17	0