# Umwandeln von Multiplikationsaufgaben

Name:

**Schreibe jede Anordnung als eine Multiplikationsaufgabe um und löse sie.**

**Bsp)**



**1)**



**2)**

**3)**

**4)**

**5)**



**6)**

**7)**



**8)**



**9)**



**10)**



**11)**



## Antworten

Bsp. **6 • 7 = 42**

1. _____
2. _____
3. _____
4. _____
5. _____
6. _____
7. _____
8. _____
9. _____
10. _____
11. _____



| | | | | | | | | | | |
|---|---|---|---|---|---|---|---|---|---|---|
| 1-10 | 91 | 82 | 73 | 64 | 55 | 45 | 36 | 27 | 18 | 9 |
| 11 | 0 | | | | | | | | | |

Umwandeln von Multiplikationsaufgaben Name: **Lösungsschlüssel**

**Schreibe jede Anordnung als eine Multiplikationsaufgabe um und löse sie.**

**Bsp)** 

**1)** 

**2)**

**3)**

**4)**

**5)** 

**6)**

**7)** 

**8)** 

**9)** 

**10)** 

**11)** 

## Antworten

| | |
|---|---|
| Bsp. | 6 • 7 = 42 |
| 1. | 7 • 10 = 70 |
| 2. | 3 • 4 = 12 |
| 3. | 3 • 7 = 21 |
| 4. | 5 • 4 = 20 |
| 5. | 7 • 4 = 28 |
| 6. | 4 • 9 = 36 |
| 7. | 4 • 10 = 40 |
| 8. | 2 • 8 = 16 |
| 9. | 8 • 9 = 72 |
| 10. | 4 • 4 = 16 |
| 11. | 7 • 9 = 63 |



| | | | | | | | | | | |
|---|---|---|---|---|---|---|---|---|---|---|
| 1-10 | 91 | 82 | 73 | 64 | 55 | 45 | 36 | 27 | 18 | 9 |
| 11 | 0 | | | | | | | | | |