Umwandeln von Multiplikationsaufgaben

Name:

Schreibe jede Anordnung als eine Multiplikationsaufgabe um und löse sie.

Bsp)



1)

2)

3)

4)

5)

6)



7)

8)



9)

10)



11)



Antworten

Bsp. **8 • 5 = 40**

1. _____
2. _____
3. _____
4. _____
5. _____
6. _____
7. _____
8. _____
9. _____
10. _____
11. _____

1-10	91	82	73	64	55	45	36	27	18	9
11	0									

Umwandeln von Multiplikationsaufgaben Name: **Lösungsschlüssel**

Schreibe jede Anordnung als eine Multiplikationsaufgabe um und löse sie.

Bsp)



1)

2)

3)

4)

5)

6)



7)

8)



9)

10)



11)



Antworten

Bsp.	8 • 5 = 40
1.	9 • 3 = 27
2.	4 • 5 = 20
3.	5 • 8 = 40
4.	10 • 2 = 20
5.	5 • 6 = 30
6.	9 • 5 = 45
7.	8 • 2 = 16
8.	7 • 8 = 56
9.	2 • 4 = 8
10.	10 • 4 = 40
11.	3 • 4 = 12

1-10	91	82	73	64	55	45	36	27	18	9
11	0									