Multiplizieren mit dem Zahlenstrahl

Name:

Benutze den Zahlenstrahl um jede Aufgabe zu beantworten.

1) 2 • 8 =
8 • 2 =

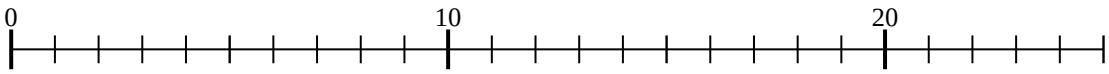

2) 2 • 2 =
2 • 2 =



3) 3 • 3 =
3 • 3 =

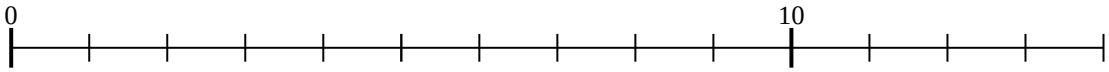

4) 5 • 4 =
4 • 5 =

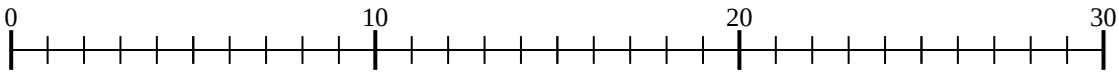

5) 4 • 3 =
3 • 4 =

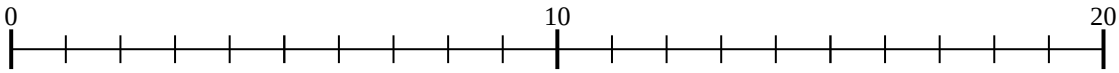

6) 5 • 6 =
6 • 5 =

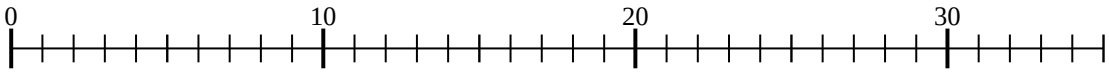

7) 3 • 8 =
8 • 3 =

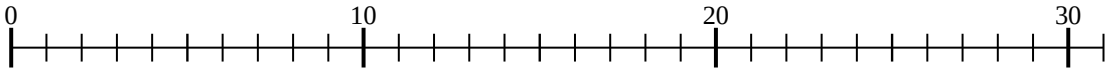

8) 3 • 7 =
7 • 3 =

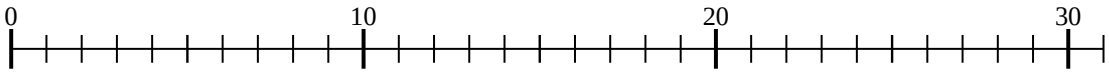

9) 4 • 6 =
6 • 4 =

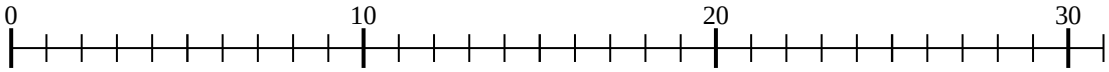

10) 4 • 4 =
4 • 4 =

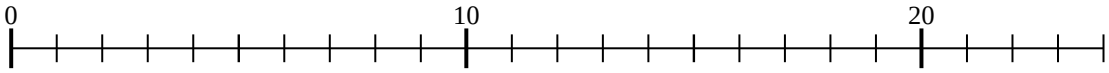

11) 3 • 4 =
4 • 3 =

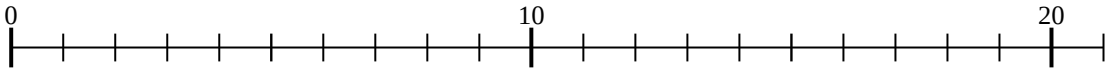

Antworten

1. _____
2. _____
3. _____
4. _____
5. _____
6. _____
7. _____
8. _____
9. _____
10. _____
11. _____

Multiplizieren mit dem Zahlenstrahl

Name: **Lösungsschlüssel**

Benutze den Zahlenstrahl um jede Aufgabe zu beantworten.

1) 2 • 8 =
8 • 2 =

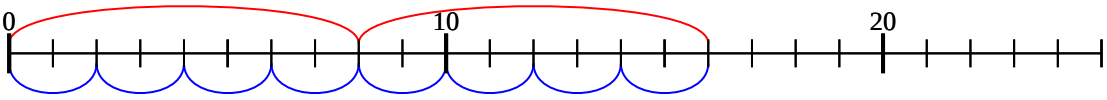

2) 2 • 2 =
2 • 2 =

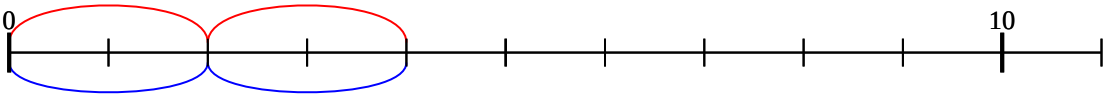

3) 3 • 3 =
3 • 3 =

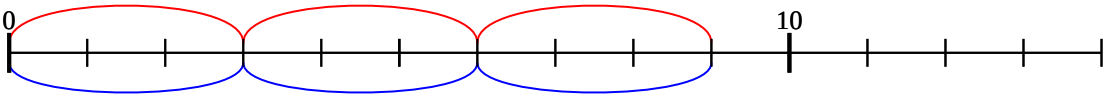

4) 5 • 4 =
4 • 5 =

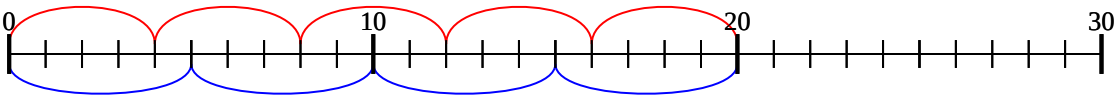

5) 4 • 3 =
3 • 4 =

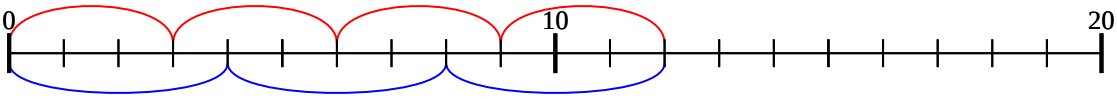

6) 5 • 6 =
6 • 5 =

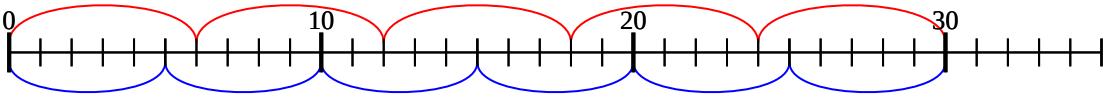

7) 3 • 8 =
8 • 3 =

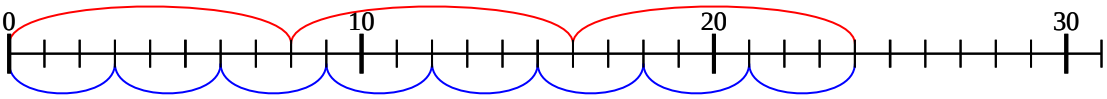

8) 3 • 7 =
7 • 3 =

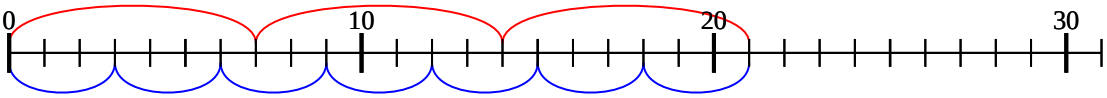

9) 4 • 6 =
6 • 4 =

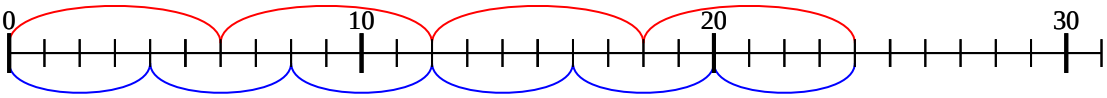

10) 4 • 4 =
4 • 4 =

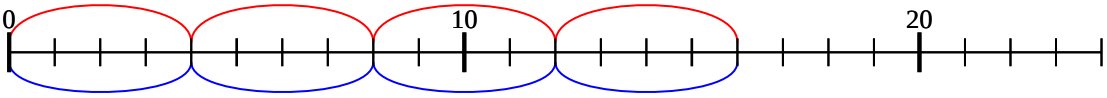

11) 3 • 4 =
4 • 3 =

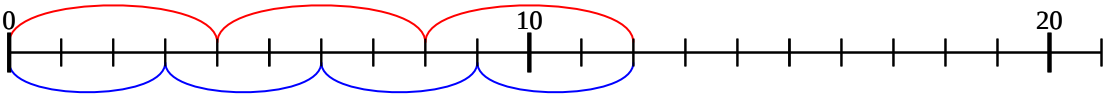

Antworten

1. **16**
2. **4**
3. **9**
4. **20**
5. **12**
6. **30**
7. **24**
8. **21**
9. **24**
10. **16**
11. **12**

1-10	91	82	73	64	55	45	36	27	18	9
11	0									