Identifizieren von Münzen

Name:

Zählen Sie die Anzahl der Viertel (25¢), Dimes (10¢), Nickels (5¢) und Pennies (1¢).

Bsp)

1)



2)



3)

4)

5)



6)

7)

8)

9)

10)

Antworten

Bsp.	1	1	4	3
1.				
2.				
3.				
4.				
5.				
6.				
7.				
8.				
9.				
10.				

1-10	90	80	70	60	50	40	30	20	10	0

Identifizieren von Münzen

Name: **Lösungsschlüssel**

Zählen Sie die Anzahl der Viertel (25¢), Dimes (10¢), Nickels (5¢) und Pennies (1¢).

Bsp)

1)



2)



3)

4)

5)



6)

7)

8)

9)

10)

Antworten

Bsp.	1	1	4	3
1.	3	2	1	3
2.	3	2	2	2
3.	2	2	2	3
4.	1	3	3	2
5.	1	2	2	4
6.	2	2	3	2
7.	4	2	2	1
8.	3	3	1	2
9.	1	2	4	2
10.	1	2	3	3

1-10	90	80	70	60	50	40	30	20	10	0