Abschätzen der Distanz (metrisch)

Name:

Stelle fest, welcher Buchstaben am besten die Länge / Höhe darstellt.

Milímetro (mm)	Centímetro (cm)	Metro (m)	Kilómetro (km)
Un milímetro equivale al grosor de una tarjeta de crédito.	10 mm = 1 cm. La parte metálica de un lápiz mide aproximadamente 1 cm. Una regla mide unos 30 centímetros.	100 cm = 1 m Desde el suelo hasta la perilla de una puerta hay aproximadamente 1 metro.	1,000 m = 1 km La mayoría de las carreteras principales tienen al menos un kilómetro de largo.
	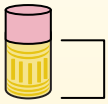	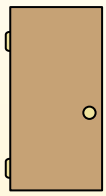	

1)



Popcorn
A. 90 zentimeters
B. 3 zentimeters
C. 2 kilometers
D. 3 millimeters

2)

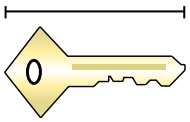

Taste
A. 15 zentimeters
B. 2 meters
C. 150 zentimeters
D. 5 zentimeters

3)

Stift
A. 30 zentimeters
B. 12 zentimeters
C. 5 meters
D. 30 millimeters

4)



Hund
A. 2 meters
B. 10 zentimeters
C. 4 meters
D. 60 zentimeters

5)

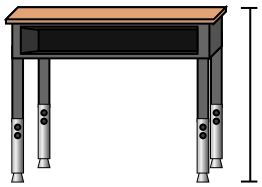

Schreibtisch
A. 2 meters
B. 15 zentimeters
C. 70 zentimeters
D. 30 zentimeters

6)



Berg
A. 3 kilometers
B. 60 zentimeters
C. 9 meters
D. 700 millimeters

7)



Apfelhöhe
A. 3 zentimeters
B. 60 zentimeters
C. 1 meter
D. 10 zentimeters

8)



Höhe der Getreidekiste
A. 3 zentimeters
B. 10 zentimeters
C. 60 zentimeters
D. 30 zentimeters

9)



Brotscheibe
A. 2 meters
B. 25 zentimeters
C. 10 zentimeters
D. 120 zentimeters

Antworten

1. _____
2. _____
3. _____
4. _____
5. _____
6. _____
7. _____
8. _____
9. _____

1-9	89	78	67	56	44	33	22	11	0

Abschätzen der Distanz (metrisch) Name: **Lösungsschlüssel**

Stelle fest, welcher Buchstaben am besten die Länge / Höhe darstellt.

Milímetro (mm)	Centímetro (cm)	Metro (m)	Kilómetro (km)
Un milímetro equivale al grosor de una tarjeta de crédito.	10 mm = 1 cm. La parte metálica de un lápiz mide aproximadamente 1 cm. Una regla mide unos 30 centímetros.	100 cm = 1 m Desde el suelo hasta la perilla de una puerta hay aproximadamente 1 metro.	1,000 m = 1 km La mayoría de las carreteras principales tienen al menos un kilómetro de largo.
	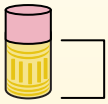	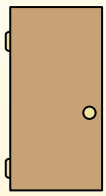	

1)



Popcorn
A. 90 zentimeters
B. 3 zentimeters
C. 2 kilometers
D. 3 millimeters

2)

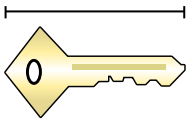

Taste
A. 15 zentimeters
B. 2 meters
C. 150 zentimeters
D. 5 zentimeters

3)

Stift
A. 30 zentimeters
B. 12 zentimeters
C. 5 meters
D. 30 millimeters

4)



Hund
A. 2 meters
B. 10 zentimeters
C. 4 meters
D. 60 zentimeters

5)

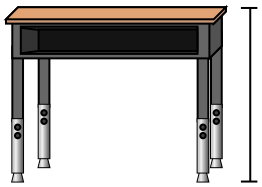

Schreibtisch
A. 2 meters
B. 15 zentimeters
C. 70 zentimeters
D. 30 zentimeters

6)



Berg
A. 3 kilometers
B. 60 zentimeters
C. 9 meters
D. 700 millimeters

7)



Apfelhöhe
A. 3 zentimeters
B. 60 zentimeters
C. 1 meter
D. 10 zentimeters

8)



Höhe der Getreidekiste
A. 3 zentimeters
B. 10 zentimeters
C. 60 zentimeters
D. 30 zentimeters

9)



Brotscheibe
A. 2 meters
B. 25 zentimeters
C. 10 zentimeters
D. 120 zentimeters

Antworten

1. B
2. D
3. B
4. D
5. C
6. A
7. D
8. D
9. C

1-9	89	78	67	56	44	33	22	11	0