Abstand in einem Koordinatensystem finden Name:

Finde den Abstand zwischen zwei Punkten. Runde deine Antwort auf die Zehntelstelle.

Bsp)

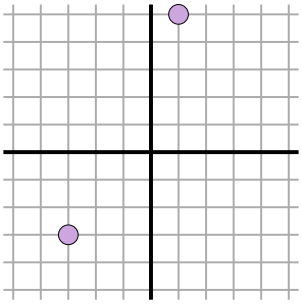

1)

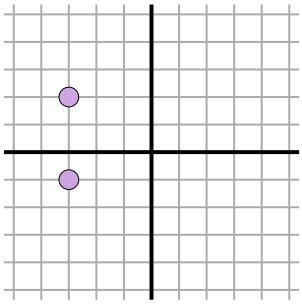

2)

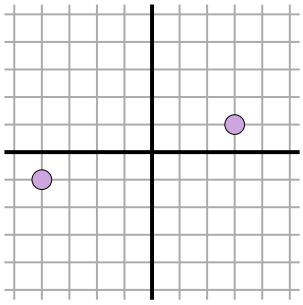

3)

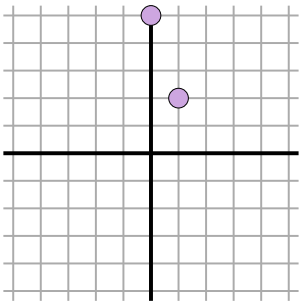

4)

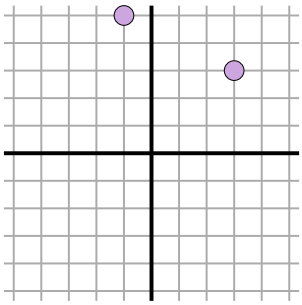

5)

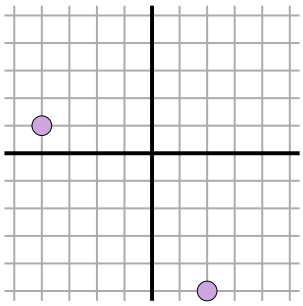

6)

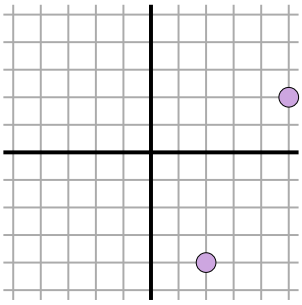

7)

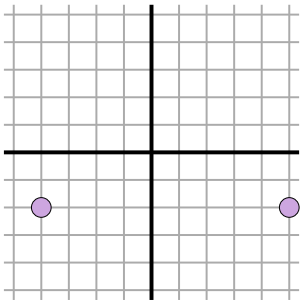

8)

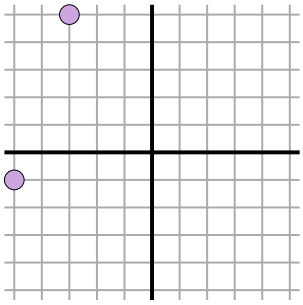

9)

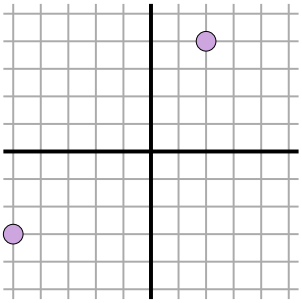

10)

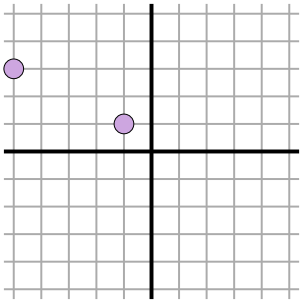

11)

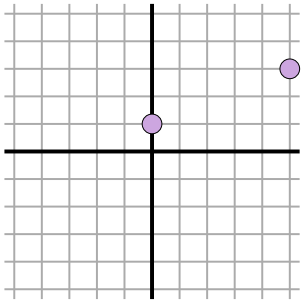

Antworten

Bsp. **8,9**

1. _____
2. _____
3. _____
4. _____
5. _____
6. _____
7. _____
8. _____
9. _____
10. _____
11. _____

1-10	91	82	73	64	55	45	36	27	18	9
11	0									

Abstand in einem Koordinatensystem finden Name: **Lösungsschlüssel**

Finde den Abstand zwischen zwei Punkten. Runde deine Antwort auf die Zehntelstelle.

Bsp)

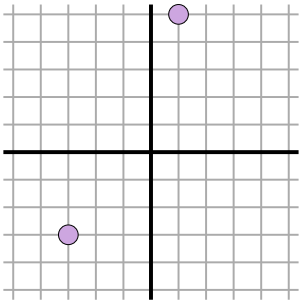

$\sqrt{(-3-1)^2 + (-3-5)^2}$

$\sqrt{(16) + (64)}$

1)

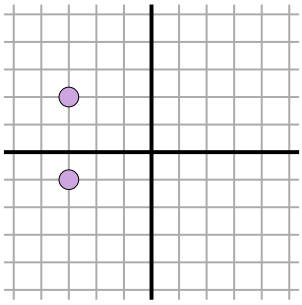

$\sqrt{(-3--3)^2 + (-1-2)^2}$

$\sqrt{(0) + (9)}$

2)

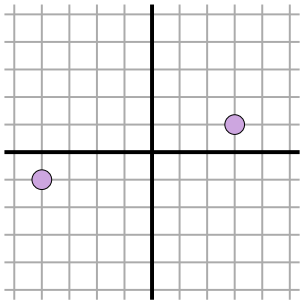

$\sqrt{(-4-3)^2 + (-1-1)^2}$

$\sqrt{(49) + (4)}$

3)

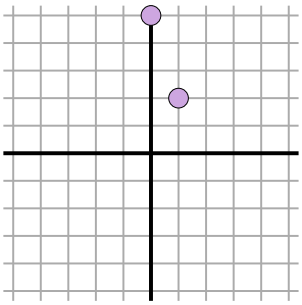

$\sqrt{(1-0)^2 + (2-5)^2}$

$\sqrt{(1) + (9)}$

4)

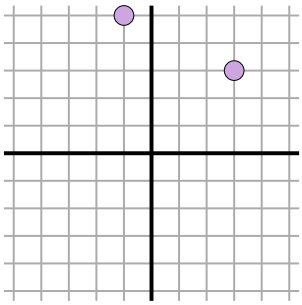

$\sqrt{(3--1)^2 + (3-5)^2}$

$\sqrt{(16) + (4)}$

5)

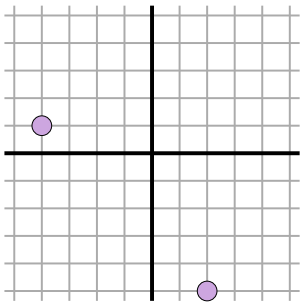

$\sqrt{(2--4)^2 + (-5-1)^2}$

$\sqrt{(36) + (36)}$

6)

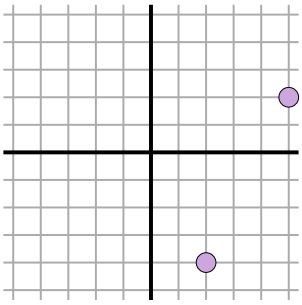

$\sqrt{(5-2)^2 + (2--4)^2}$

$\sqrt{(9) + (36)}$

7)

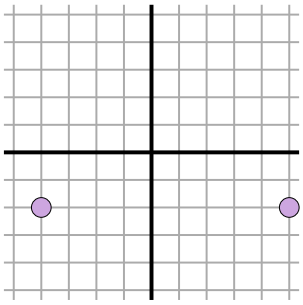

$\sqrt{(-4-5)^2 + (-2--2)^2}$

$\sqrt{(81) + (0)}$

8)

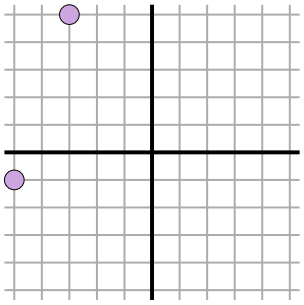

$\sqrt{(-3--5)^2 + (5--1)^2}$

$\sqrt{(4) + (36)}$

9)

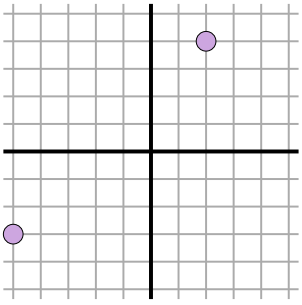

$\sqrt{(-5-2)^2 + (-3-4)^2}$

$\sqrt{(49) + (49)}$

10)

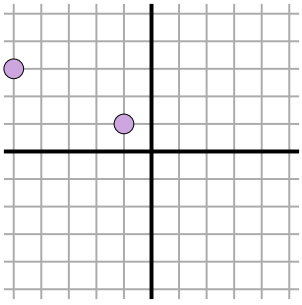

$\sqrt{(-1--5)^2 + (1-3)^2}$

$\sqrt{(16) + (4)}$

11)

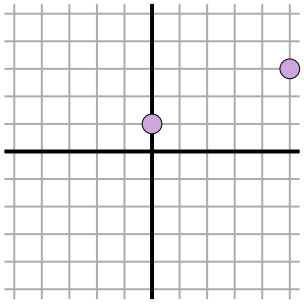

$\sqrt{(5-0)^2 + (3-1)^2}$

$\sqrt{(25) + (4)}$

Antworten

Bsp.	8,9
1.	3
2.	7,3
3.	3,2
4.	4,5
5.	8,5
6.	6,7
7.	9
8.	6,3
9.	9,9
10.	4,5
11.	5,4

1-10	91	82	73	64	55	45	36	27	18	9
11	0									