Erstellen von Rechtecken mit einem Koordinatenraster Name:

Finden Sie die Koordinaten von Punkt D, um ein Rechteck zu erstellen.

Bsp)

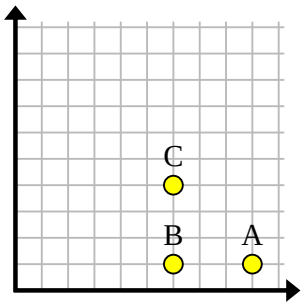

1)

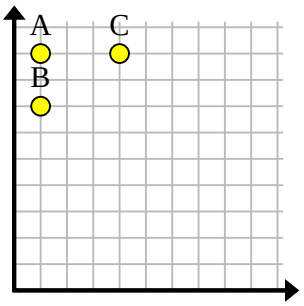

2)

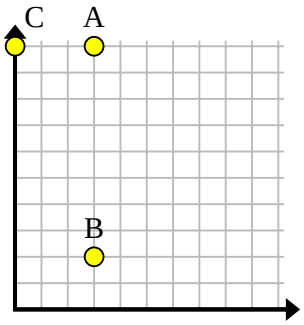

3)

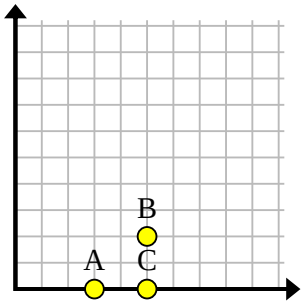

4)

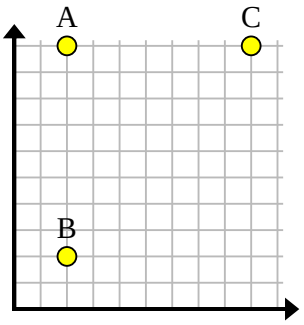

5)

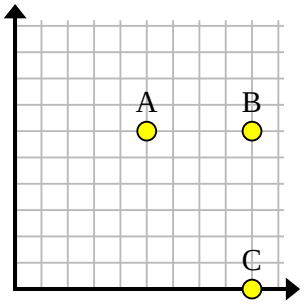

6)

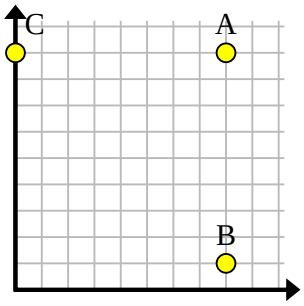

7)

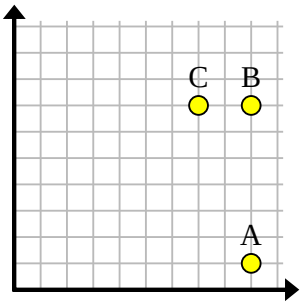

8)

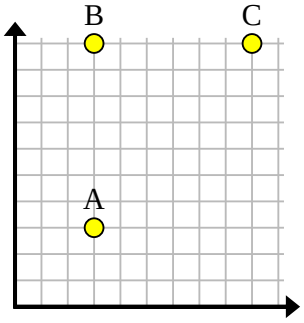

9)

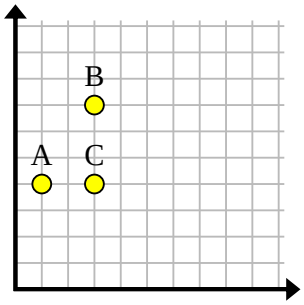

10)

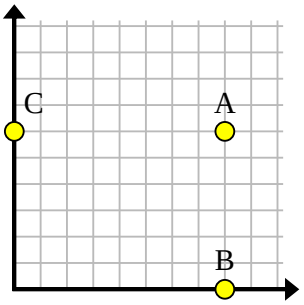

11)

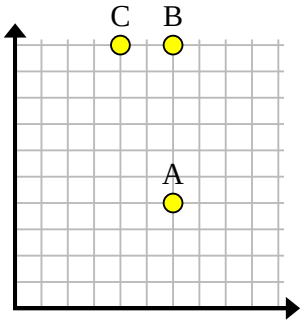

Antworten

Bsp. (9,4)

1. _____
2. _____
3. _____
4. _____
5. _____
6. _____
7. _____
8. _____
9. _____
10. _____
11. _____

Erstellen von Rechtecken mit einem Koordinatenraster Name: **Lösungsschlüssel**

Finden Sie die Koordinaten von Punkt D, um ein Rechteck zu erstellen.

Bsp)

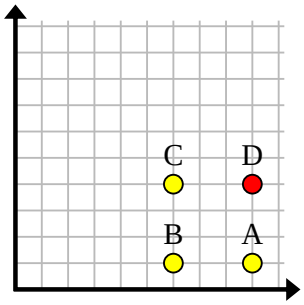

1)

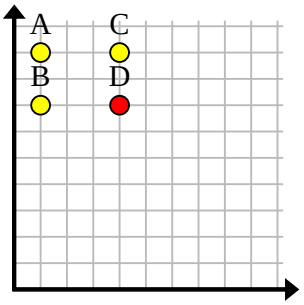

2)

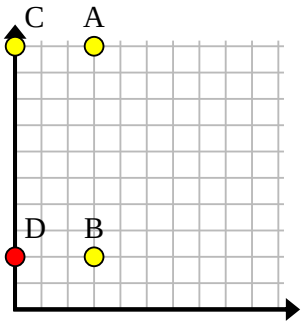

3)

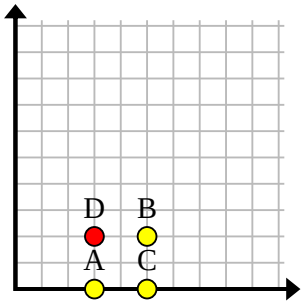

4)

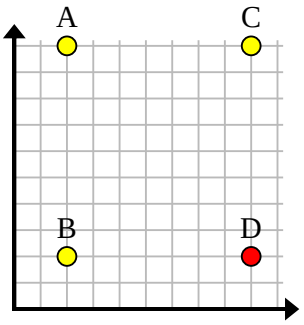

5)

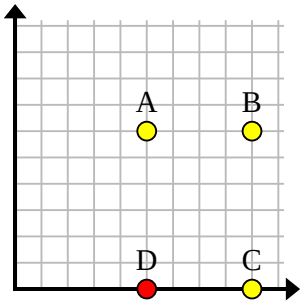

6)

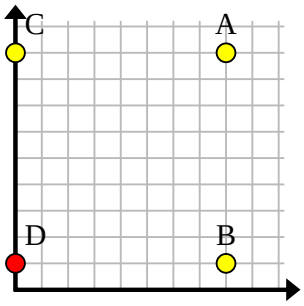

7)

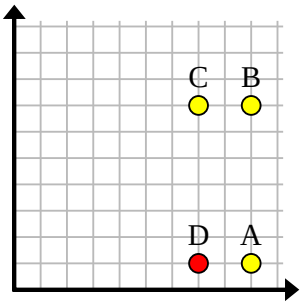

8)

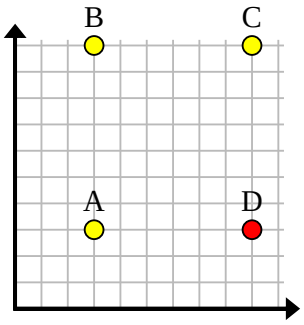

9)

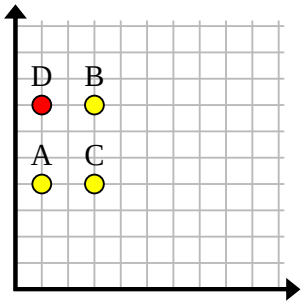

10)

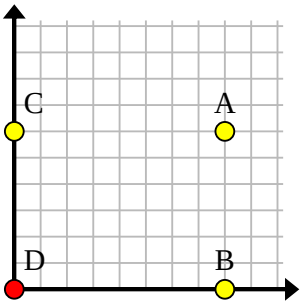

11)

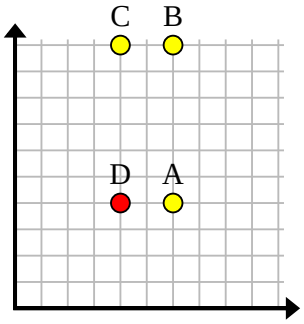

Antworten

Bsp.	(9,4)
1.	(4,7)
2.	(0,2)
3.	(3,2)
4.	(9,2)
5.	(5,0)
6.	(0,1)
7.	(7,1)
8.	(9,3)
9.	(1,7)
10.	(0,0)
11.	(4,4)