Gemischte Brüche subtrahieren - visuell

Name:

Wende das visuelle Modell an um jede Aufgabe zu lösen.

$4\,{}^{3}\!/_{5} - 2\,{}^{4}\!/_{5} = ?$

Para resolver un problema de resta de fracciones, una estrategia es sombrear primero la cantidad inicial ($4\,{}^{3}\!/_{5}$)

Em seguida, marque os inteiros (2).

Finalmente, marque la fracción ${}^{4}\!/_{5}$.

Ahora podemos ver que $4\,{}^{3}\!/_{5} - 2\,{}^{4}\!/_{5} = 1\,{}^{4}\!/_{5}$

1) $5\frac{2}{3} - 3\frac{2}{3} =$

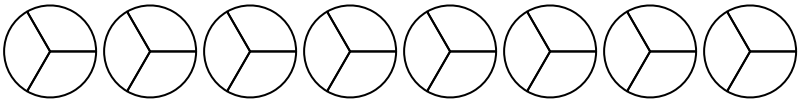

2) $3\frac{1}{4} - 1\frac{1}{4} =$

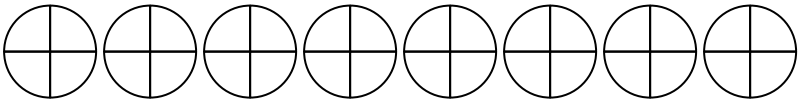

3) $7\frac{2}{5} - 2\frac{4}{5} =$

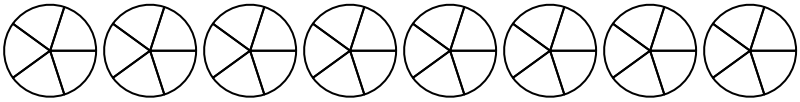

4) $4\frac{4}{5} - 2\frac{3}{5} =$

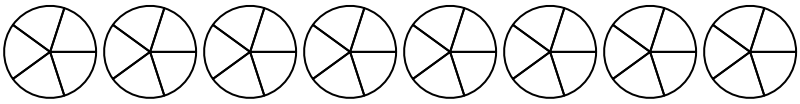

5) $3\frac{5}{10} - 1\frac{6}{10} =$

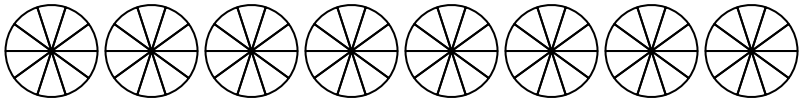

6) $6\frac{8}{10} - 4\frac{3}{10} =$

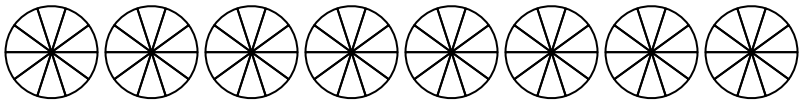

7) $4\frac{3}{4} - 1\frac{1}{4} =$

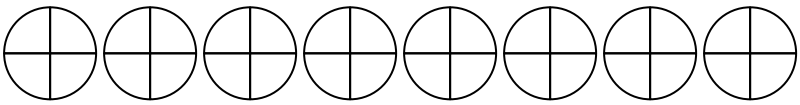

8) $5\frac{1}{3} - 2\frac{1}{3} =$

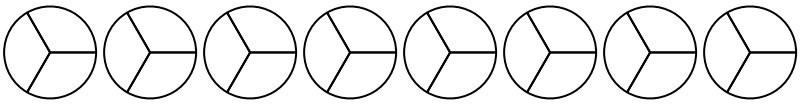

9) $5\frac{2}{4} - 3\frac{3}{4} =$

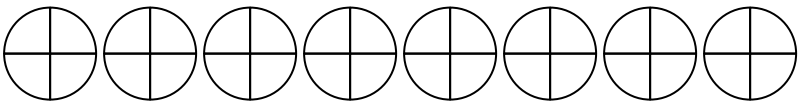

10) $4\frac{1}{3} - 1\frac{1}{3} =$

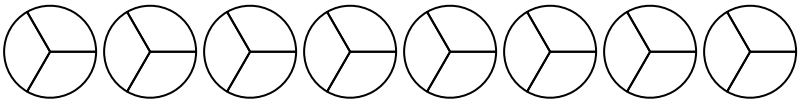

Antworten

1. _____
2. _____
3. _____
4. _____
5. _____
6. _____
7. _____
8. _____
9. _____
10. _____

1-10	90	80	70	60	50	40	30	20	10	0

Gemischte Brüche subtrahieren - visuell

Name: **Lösungsschlüssel**

Wende das visuelle Modell an um jede Aufgabe zu lösen.

$4\,{}^{3}\!/_{5} - 2\,{}^{4}\!/_{5} = ?$

Para resolver un problema de resta de fracciones, una estrategia es sombrear primero la cantidad inicial ($4\,{}^{3}\!/_{5}$)

Em seguida, marque os inteiros (2).

Finalmente, marque la fracción ${}^{4}\!/_{5}$.

Ahora podemos ver que $4\,{}^{3}\!/_{5} - 2\,{}^{4}\!/_{5} = 1\,{}^{4}\!/_{5}$

1) $5\frac{2}{3} - 3\frac{2}{3} =$

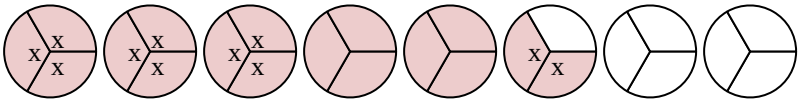

2) $3\frac{1}{4} - 1\frac{1}{4} =$

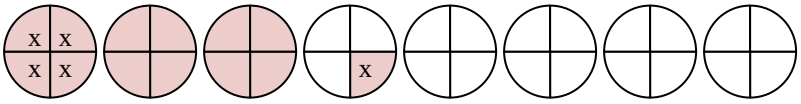

3) $7\frac{2}{5} - 2\frac{4}{5} =$

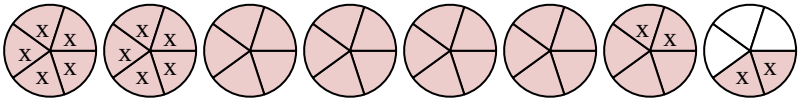

4) $4\frac{4}{5} - 2\frac{3}{5} =$

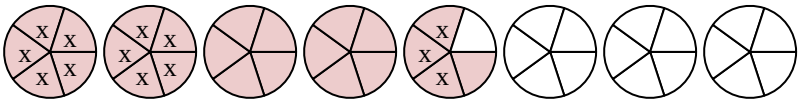

5) $3\frac{5}{10} - 1\frac{6}{10} =$

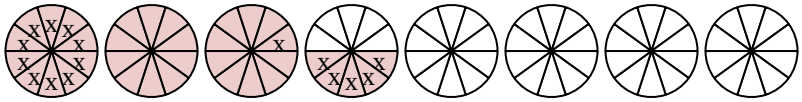

6) $6\frac{8}{10} - 4\frac{3}{10} =$

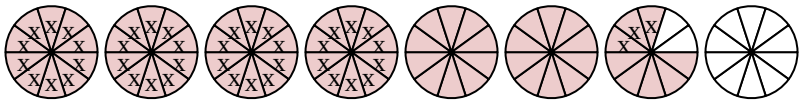

7) $4\frac{3}{4} - 1\frac{1}{4} =$

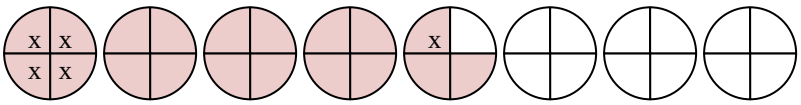

8) $5\frac{1}{3} - 2\frac{1}{3} =$

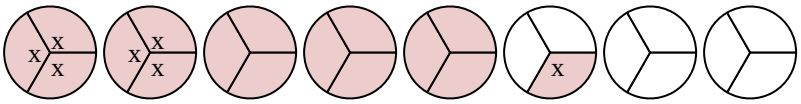

9) $5\frac{2}{4} - 3\frac{3}{4} =$

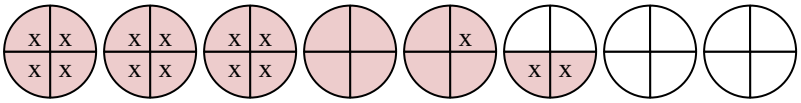

10) $4\frac{1}{3} - 1\frac{1}{3} =$

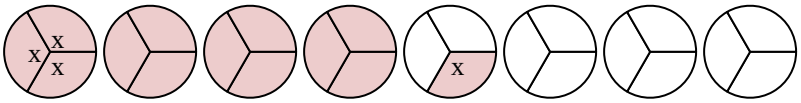

Antworten

1. $2\,{}^{0}\!/_{3}$
2. $2\,{}^{0}\!/_{4}$
3. $4\,{}^{3}\!/_{5}$
4. $2\,{}^{1}\!/_{5}$
5. $1\,{}^{9}\!/_{10}$
6. $2\,{}^{5}\!/_{10}$
7. $3\,{}^{2}\!/_{4}$
8. $3\,{}^{0}\!/_{3}$
9. $1\,{}^{3}\!/_{4}$
10. $3\,{}^{0}\!/_{3}$

1-10	90	80	70	60	50	40	30	20	10	0