Division mit einem Zahlenstrahl

Name:

Benutze den Zahlenstrahl um jede Aufgabe zu lösen. Die erste Aufgabe ist bereíts als Beispiel gelöst.

1) $3:\frac{3}{6}$

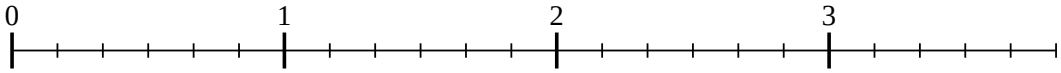

2) $7:\frac{3}{4}$

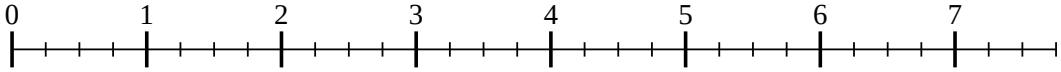

3) $5:\frac{2}{3}$

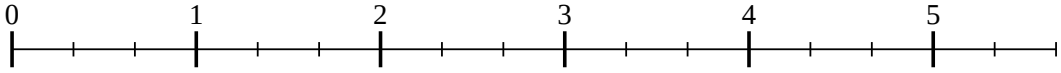

4) $2:\frac{5}{6}$

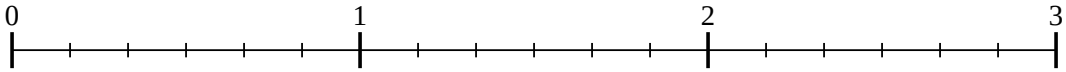

5) $4:\frac{2}{6}$

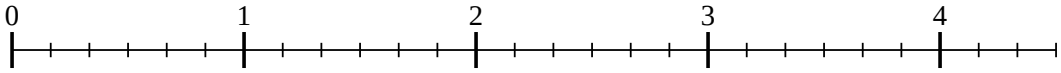

6) $4:\frac{2}{3}$

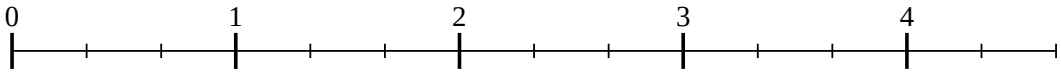

7) $2:\frac{2}{3}$

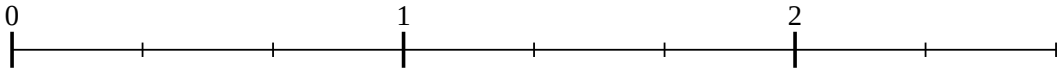

8) $3:\frac{2}{4}$

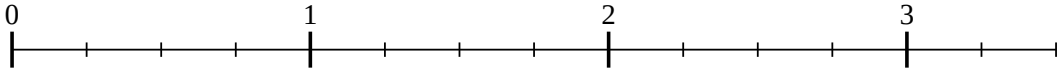

9) $6:\frac{2}{5}$

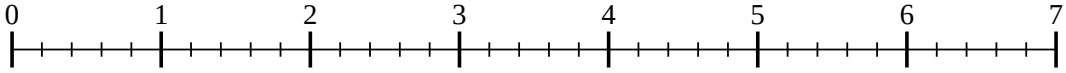

Antworten

1. _____
2. _____
3. _____
4. _____
5. _____
6. _____
7. _____
8. _____
9. _____

1-9	89	78	67	56	44	33	22	11	0

Division mit einem Zahlenstrahl

Name: **Lösungsschlüssel**

Benutze den Zahlenstrahl um jede Aufgabe zu lösen. Die erste Aufgabe ist bereits als Beispiel gelöst.

1) $3 : \frac{3}{6}$

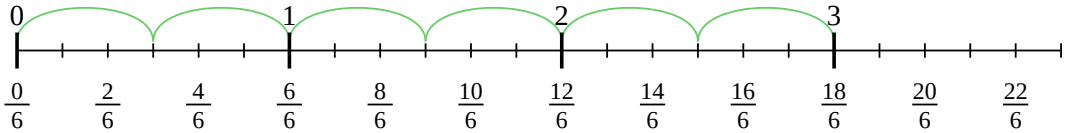

2) $7 : \frac{3}{4}$

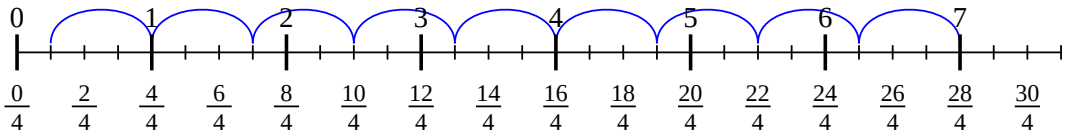

3) $5 : \frac{2}{3}$

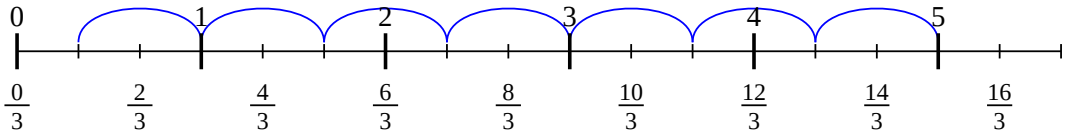

4) $2 : \frac{5}{6}$

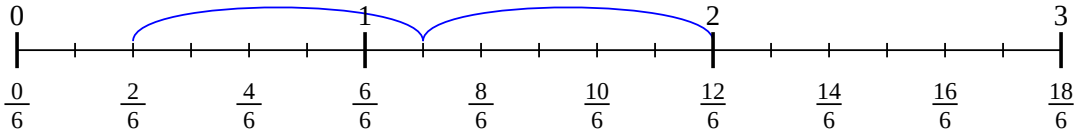

5) $4 : \frac{2}{6}$

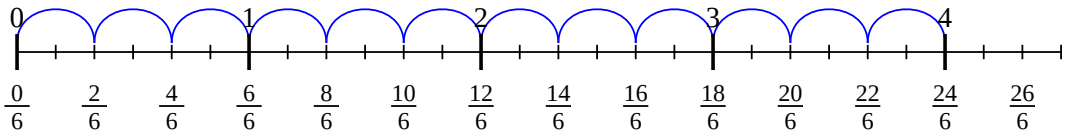

6) $4 : \frac{2}{3}$

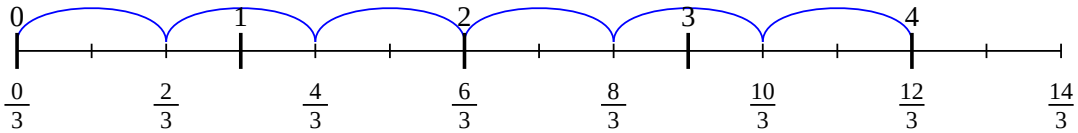

7) $2 : \frac{2}{3}$

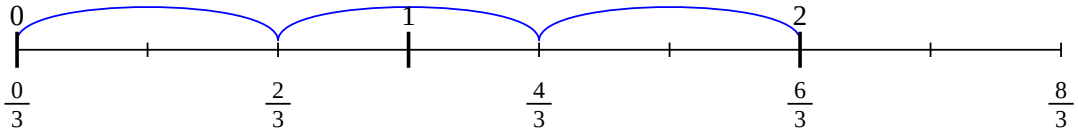

8) $3 : \frac{2}{4}$

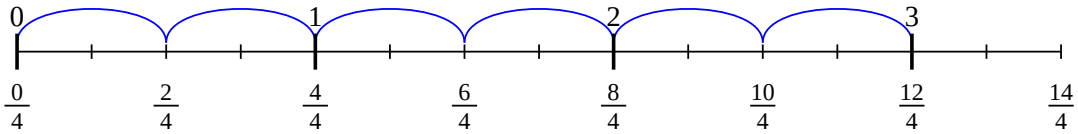

9) $6 : \frac{2}{5}$

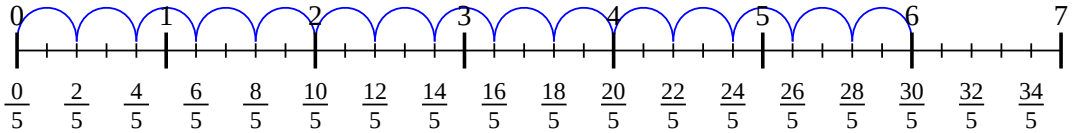

Antworten

1. $18/3$
2. $28/3$
3. $15/2$
4. $12/5$
5. $24/2$
6. $12/2$
7. $6/2$
8. $12/2$
9. $30/2$

1-9	89	78	67	56	44	33	22	11	0