Division mit einem Zahlenstrahl

Name:

Benutze den Zahlenstrahl zur Lösung jeder Aufgabe.

1) 15:5=

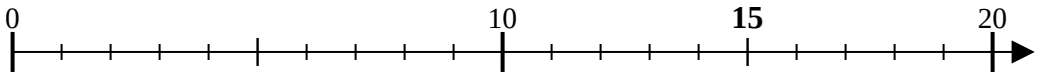

2) 16:8=

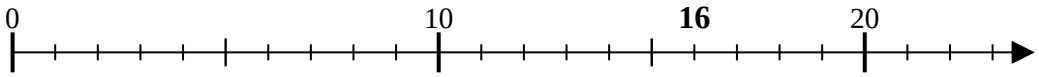

3) 8:2=

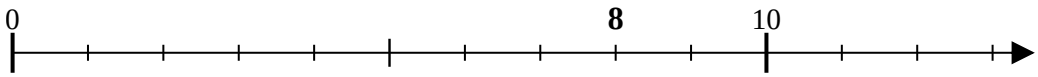

4) 36:9=

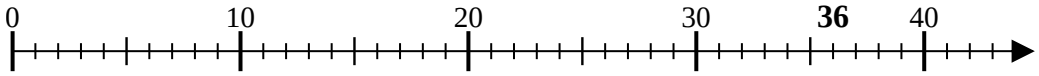

5) 10:5=

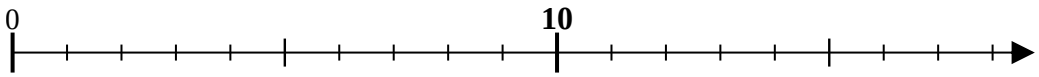

6) 16:4=

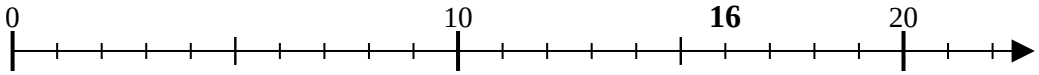

7) 6:2=

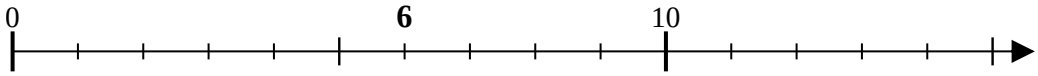

8) 12:6=

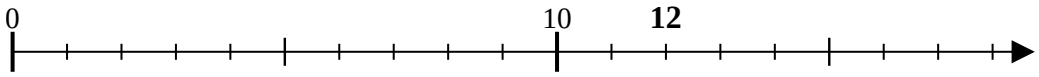

9) 6:3=

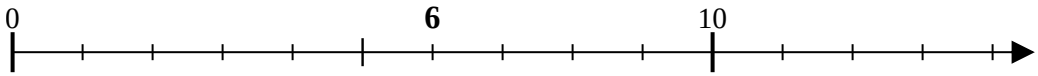

10) 18:9=

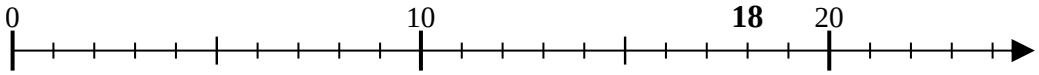

11) 45:9=

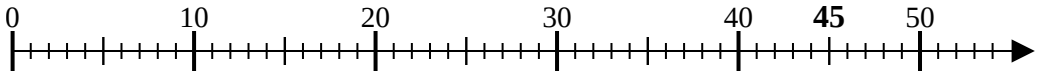

Antworten

1. _____
2. _____
3. _____
4. _____
5. _____
6. _____
7. _____
8. _____
9. _____
10. _____
11. _____

1-10	91	82	73	64	55	45	36	27	18	9
11	0									

Division mit einem Zahlenstrahl

Name: **Lösungsschlüssel**

Benutze den Zahlenstrahl zur Lösung jeder Aufgabe.

1) 15:5=

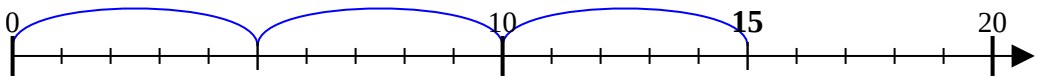

2) 16:8=

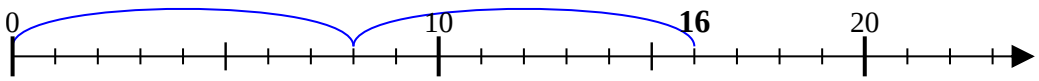

3) 8:2=

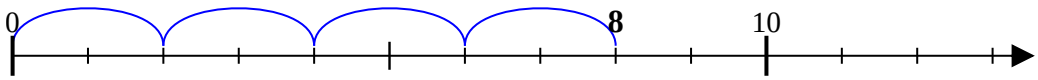

4) 36:9=

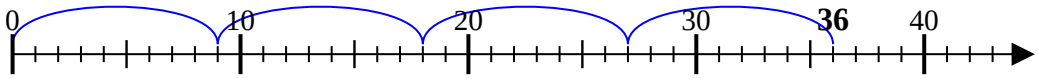

5) 10:5=

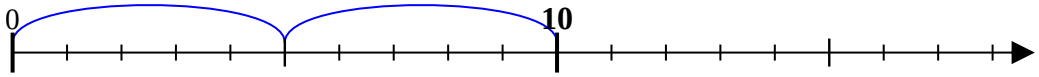

6) 16:4=

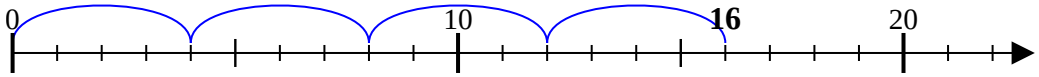

7) 6:2=

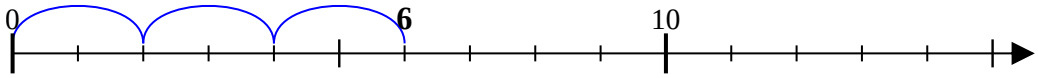

8) 12:6=

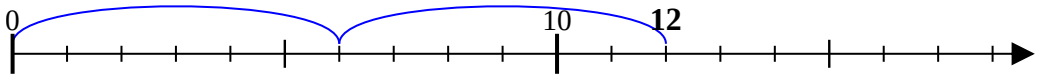

9) 6:3=

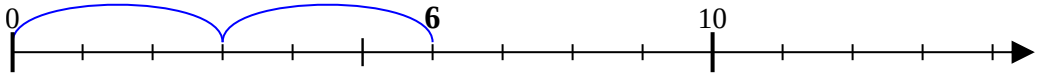

10) 18:9=

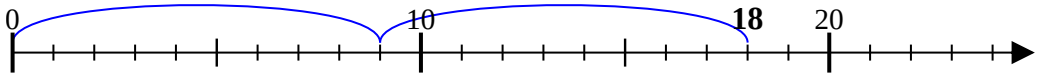

11) 45:9=

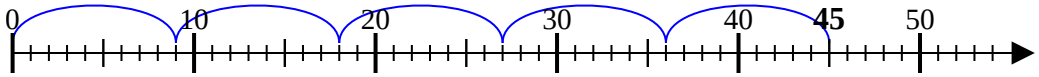

Antworten

1. 3
2. 2
3. 4
4. 4
5. 2
6. 4
7. 3
8. 2
9. 2
10. 2
11. 5

1-10	91	82	73	64	55	45	36	27	18	9
11	0									