Dezimalwert mit Blöcken ermitteln

Name:

Verwenden Sie den Block auf der linken Seite, um den Wert des Satzes von Blöcken auf der rechten Seite zu ermitteln.

1)  = 1 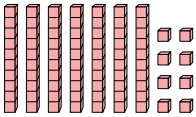

2) 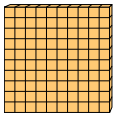 = 1 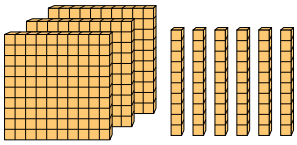

3) 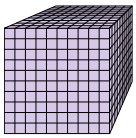 = 1 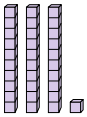

4) 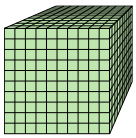 = 1 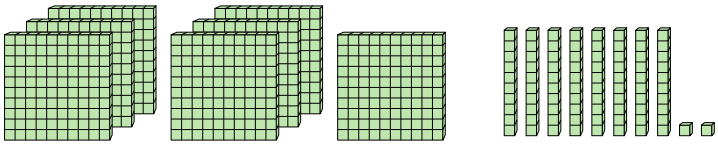

5)  = 1 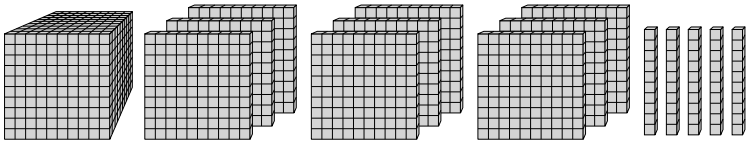

6)  = 1 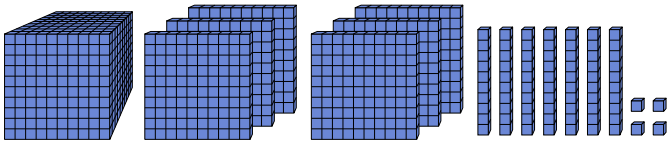

7)  = 1 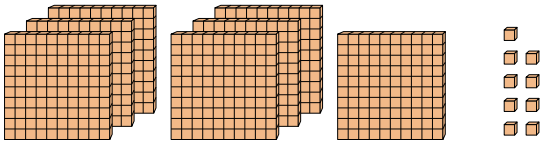

8)  = 1 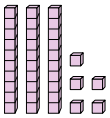

9) 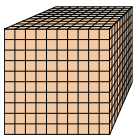 = 1 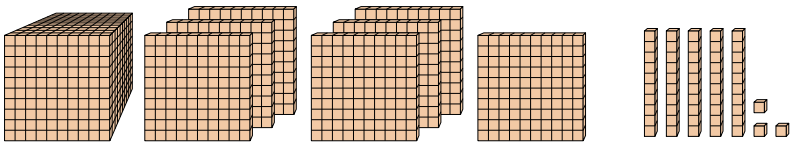

10) 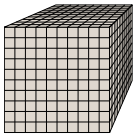 = 1 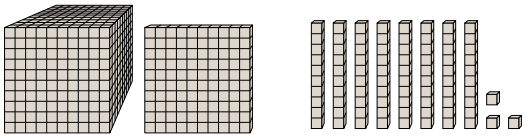

Antworten

1. _____
2. _____
3. _____
4. _____
5. _____
6. _____
7. _____
8. _____
9. _____
10. _____

1-10	90	80	70	60	50	40	30	20	10	0

Dezimalwert mit Blöcken ermitteln

Name: **Lösungsschlüssel**

Verwenden Sie den Block auf der linken Seite, um den Wert des Satzes von Blöcken auf der rechten Seite zu ermitteln.

1) 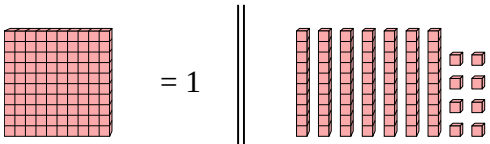

2) 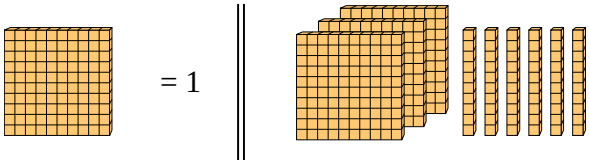

3) 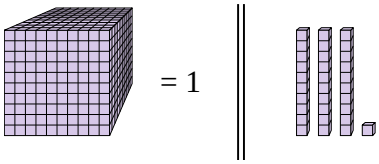

4) 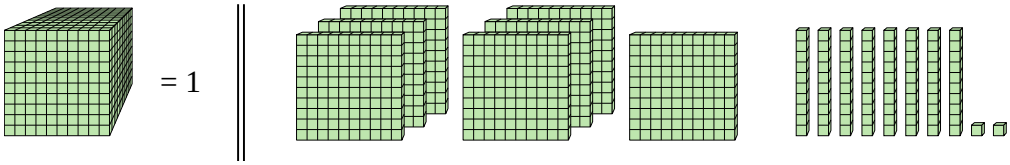

5) 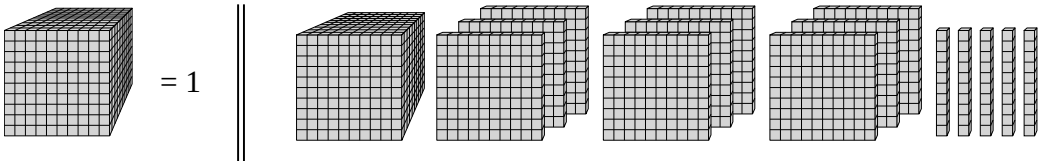

6) 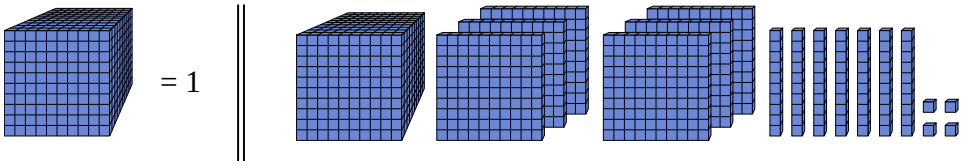

7) 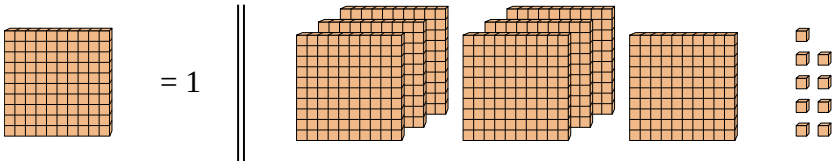

8) 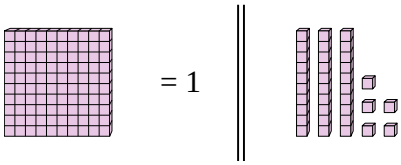

9) 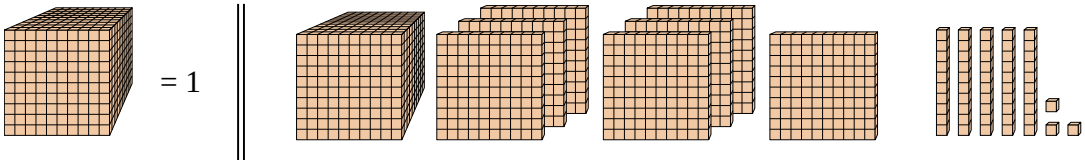

10) 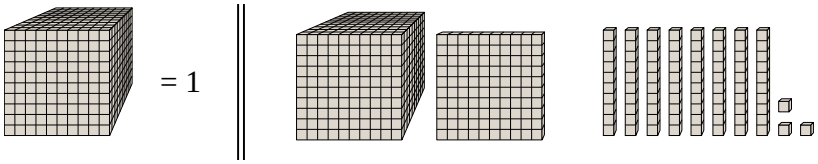

Antworten

1. **0,78**
2. **3,6**
3. **0,031**
4. **0,782**
5. **1,95**
6. **1,674**
7. **7,09**
8. **0,35**
9. **1,753**
10. **1,183**

1-10	90	80	70	60	50	40	30	20	10	0