Formen zählen

Name:

Zählen Sie die Anzahl der gezeigten Formen.

1)



2)

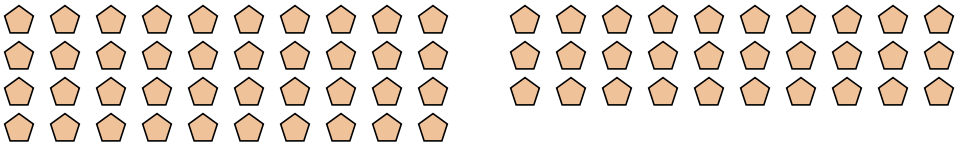

3)



4)

5)

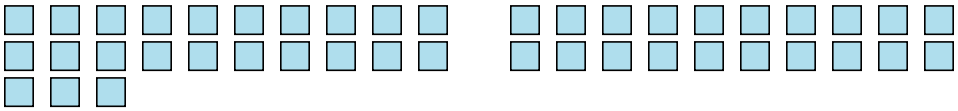

Antworten

1. _____
2. _____
3. _____
4. _____
5. _____

1-5	80	60	40	20	0

Formen zählen

Name: **Lösungsschlüssel**

Zählen Sie die Anzahl der gezeigten Formen.

1)



2)

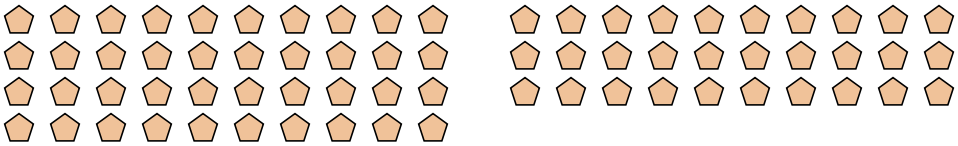

3)



4)

5)

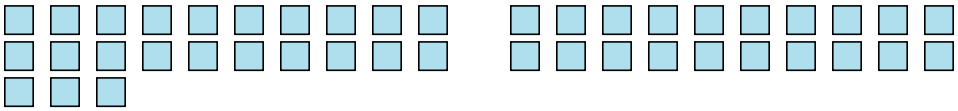

Antworten

1. **102**
2. **70**
3. **81**
4. **9**
5. **43**

1-5	80	60	40	20	0