Formen zählen

Name:

Zählen Sie die Anzahl der gezeigten Formen.

1)

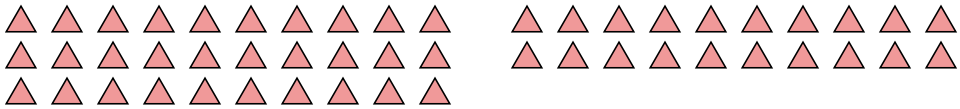

2)

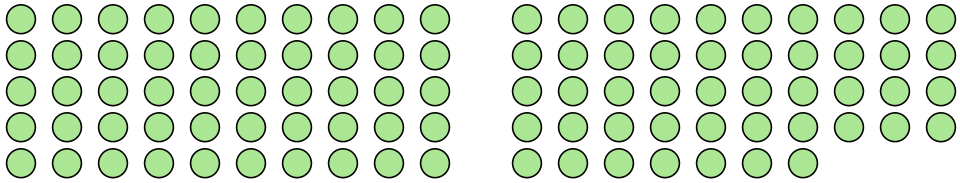

3)

4)

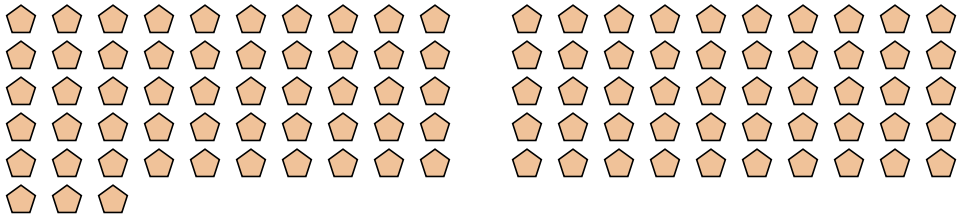

5)

Antworten

1. _____
2. _____
3. _____
4. _____
5. _____

1-5	80	60	40	20	0

Formen zählen

Name: **Lösungsschlüssel**

Zählen Sie die Anzahl der gezeigten Formen.

1)

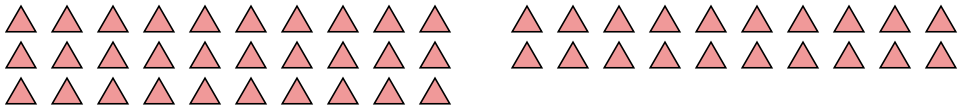

2)

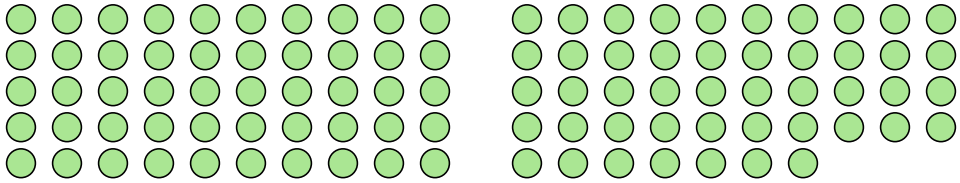

3)

4)

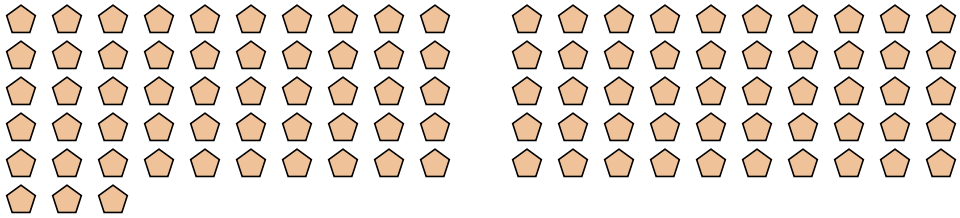

5)

Antworten

1. **50**
2. **97**
3. **27**
4. **103**
5. **64**

1-5	80	60	40	20	0