Zählen von Zehnergruppen Name:

Bestimme die Anzahl der Zehnergruppe. Dann ermittle die ganze Anzahl der kleinen Blocks.

1)



2)

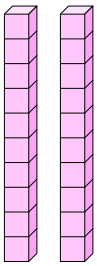

3)

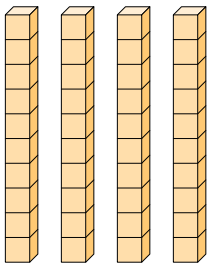

4)

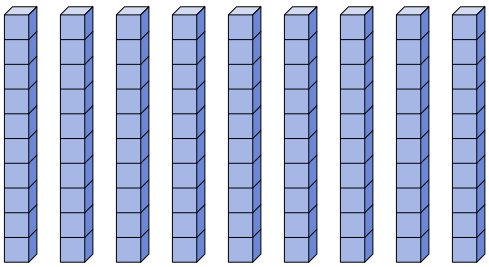

5)

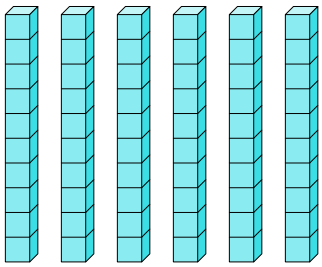

6)

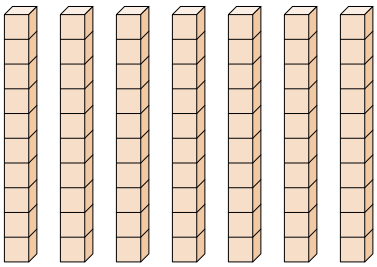

7)

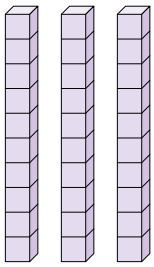

8)

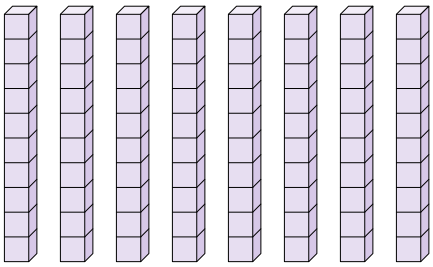

Antworten

1. _____ _____
2. _____ _____
3. _____ _____
4. _____ _____
5. _____ _____
6. _____ _____
7. _____ _____
8. _____ _____

1-8	88	75	63	50	38	25	13	0

Zählen von Zehnergruppen

Name: **Lösungsschlüssel**

Bestimme die Anzahl der Zehnergruppe. Dann ermittle die ganze Anzahl der kleinen Blocks.

1)



2)

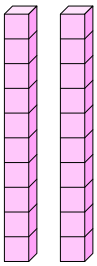

3)

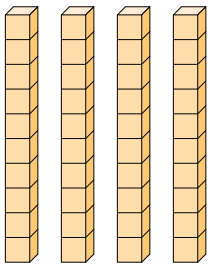

4)

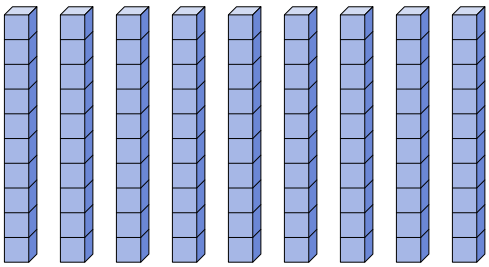

5)

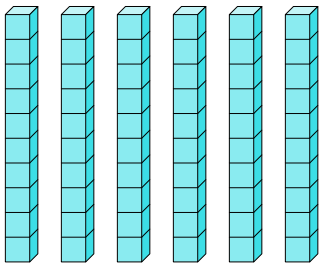

6)

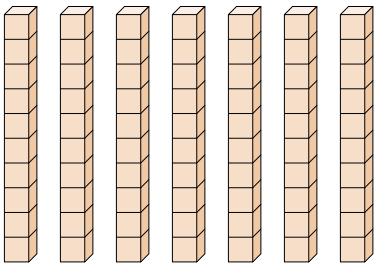

7)

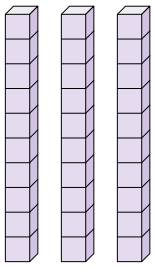

8)

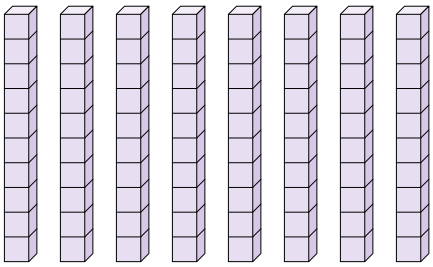

Antworten

1.	5	50
2.	2	20
3.	4	40
4.	9	90
5.	6	60
6.	7	70
7.	3	30
8.	8	80

1-8	88	75	63	50	38	25	13	0