Flächenberechnung mit partiellen Blöcken Name:

Berechne die Fläche des jeweils schattierten Bereiches. Jeder Block entspricht 1 Quadrateinheit (u^2).

1)

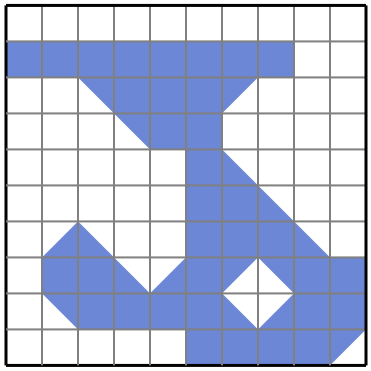

2)

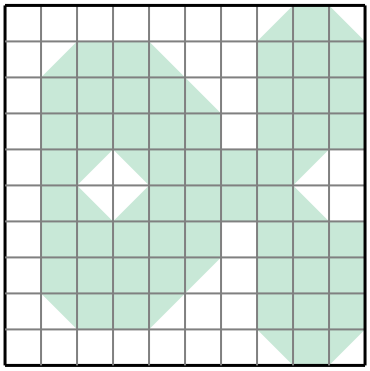

3)

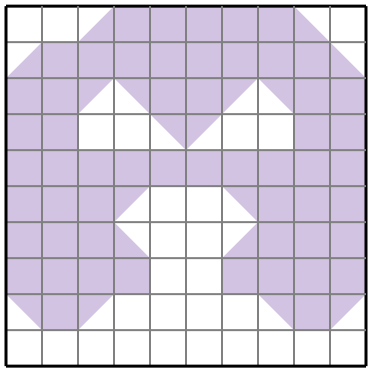

4)



5)

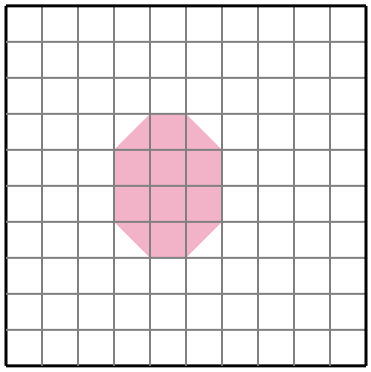

6)



7)

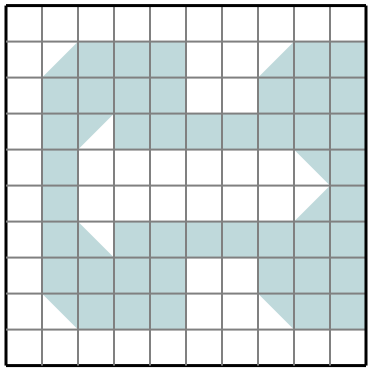

8)

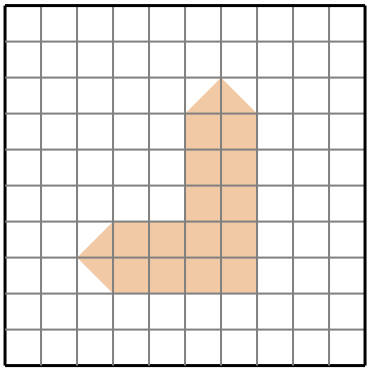

Antworten

1. _____
2. _____
3. _____
4. _____
5. _____
6. _____
7. _____
8. _____

1-8	88	75	63	50	38	25	13	0

Berechne die Fläche des jeweils schattierten Bereiches. Jeder Block entspricht 1 Quadrateinheit (u^2).

1)

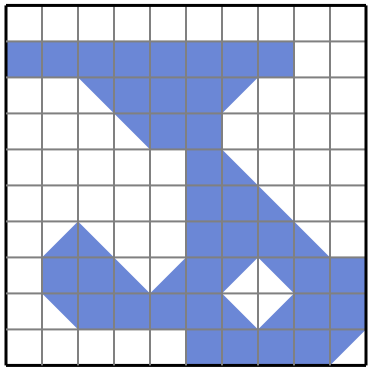

0
8
4
2,5
1,5
2,5
4,5
7
7,5
4,5

2)

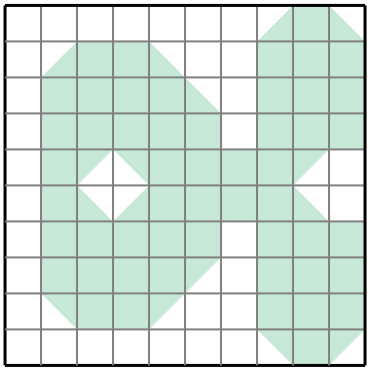

2
6
7,5
8
6,5
6,5
8
7,5
6
2

3)

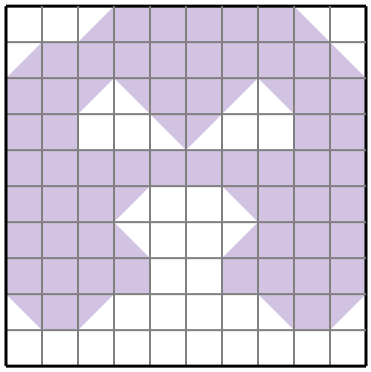

6
9
8
5
10
7
7
8
4
0

4)



5,5
6,5
5
4
4
4
4
5
8
7

5)

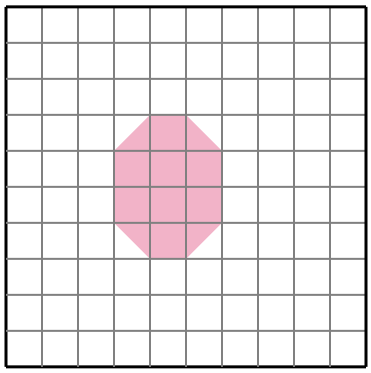

0
0
0
2
3
3
2
0
0
0

6)



0
4,5
5
6,5
6
5
4,5
4
5,5
0

7)

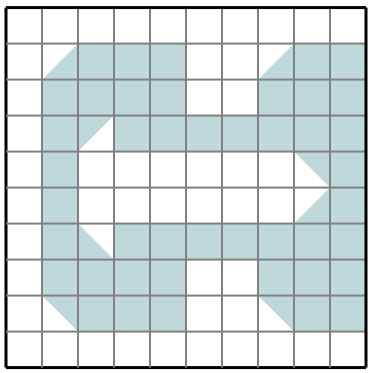

0
6
7
8,5
2,5
2,5
8,5
7
6
0

8)

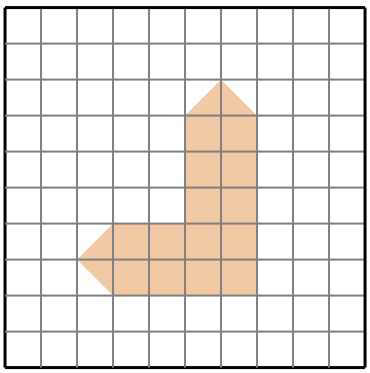

0
0
1
2
2
2
4,5
4,5
0
0

Antworten

1. **42 u^2**
2. **60 u^2**
3. **64 u^2**
4. **53 u^2**
5. **10 u^2**
6. **41 u^2**
7. **48 u^2**
8. **16 u^2**

1-8	88	75	63	50	38	25	13	0