Kreisfläche und Kreisumfang Name:

Berechne die Kreisfläche und den Kreisumfang jedes Kreises. Die Kreise sind nicht maßstäblich.

1)

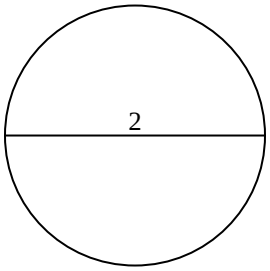

2)

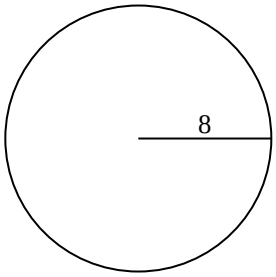

3)

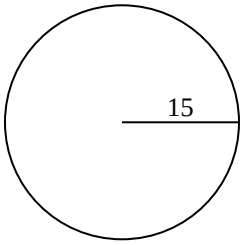

4)

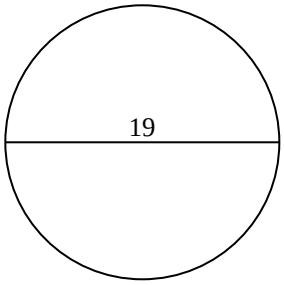

5)

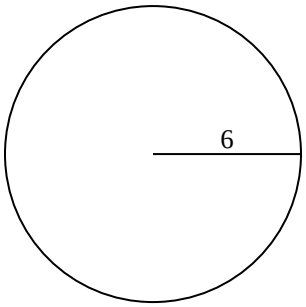

6)

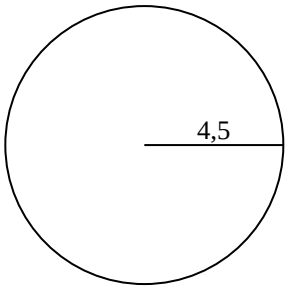

7)

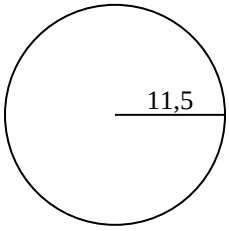

8)

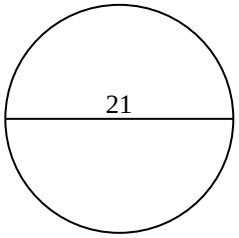

9)

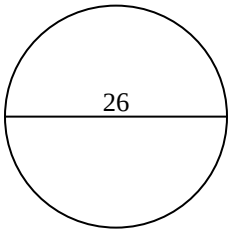

10)

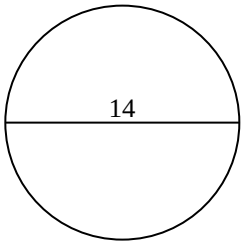

Antworten

1. _____ _____
2. _____ _____
3. _____ _____
4. _____ _____
5. _____ _____
6. _____ _____
7. _____ _____
8. _____ _____
9. _____ _____
10. _____ _____

1-10	90	80	70	60	50	40	30	20	10	0

Kreisfläche und Kreisumfang

Name: **Lösungsschlüssel**

Berechne die Kreisfläche und den Kreisumfang jedes Kreises. Die Kreise sind nicht maßstäblich.

1)

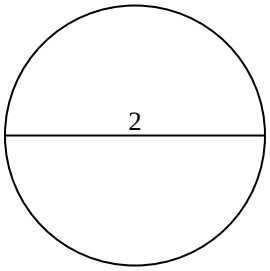

2)

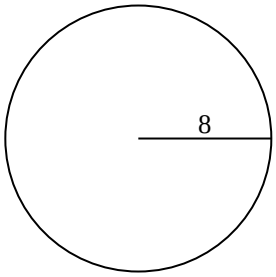

3)

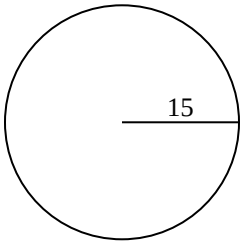

4)

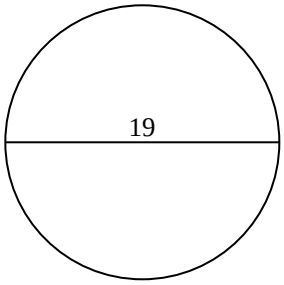

5)

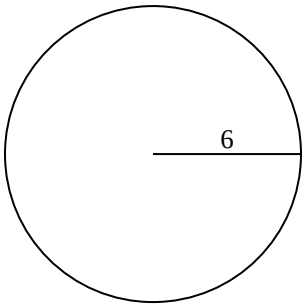

6)

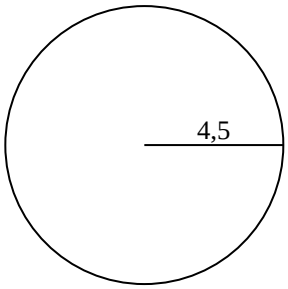

7)

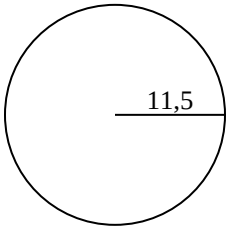

8)

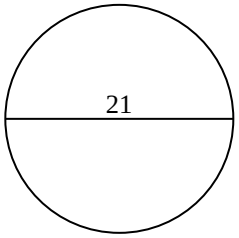

9)

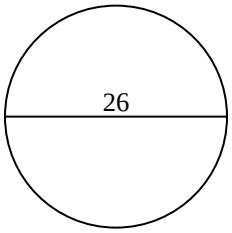

10)

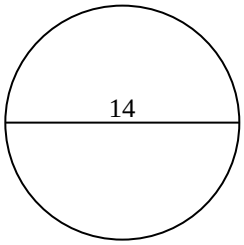

Antworten

1.	3,1	6,3
2.	201,1	50,3
3.	706,9	94,2
4.	283,5	59,7
5.	113,1	37,7
6.	63,6	28,3
7.	415,5	72,3
8.	346,4	66
9.	530,9	81,7
10.	153,9	44

1-10	90	80	70	60	50	40	30	20	10	0

Kreisfläche und Kreisumfang Name:

Berechne die Kreisfläche und den Kreisumfang jedes Kreises. Die Kreise sind nicht maßstäblich.

81,7	72,3	706,9	346,4	94,2
6,3	530,9	415,5	37,7	66
3,1	28,3	63,6	50,3	201,1
113,1	59,7	283,5		

1)

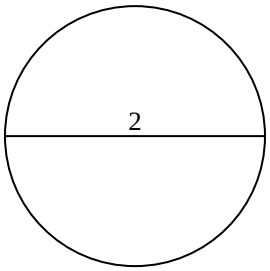

2)

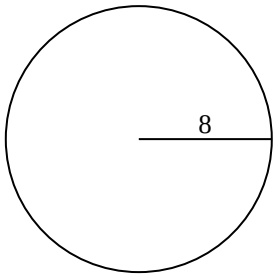

3)

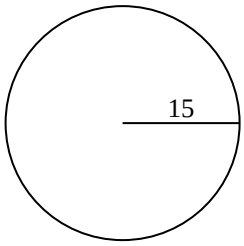

4)

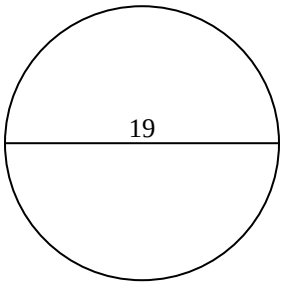

5)

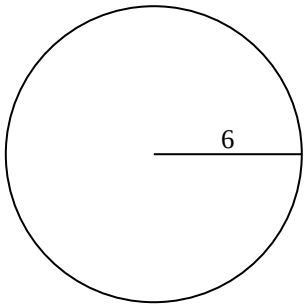

6)

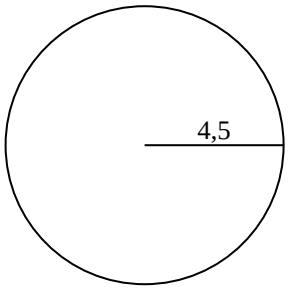

7)

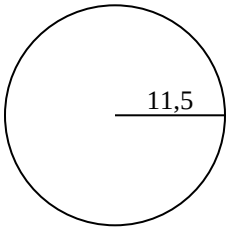

8)

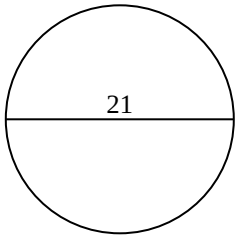

9)

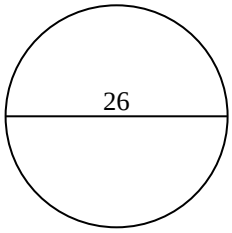

Antworten

1. _____ _____
2. _____ _____
3. _____ _____
4. _____ _____
5. _____ _____
6. _____ _____
7. _____ _____
8. _____ _____
9. _____ _____

1-9	89	78	67	56	44	33	22	11	0