Kleinere Einheiten identifizieren

Name:

Bestimme die Anzahl der kleinen Teilstücke, die aus dem größeren Stück gemacht werden können.

Bsp) $2\frac{1}{4}$

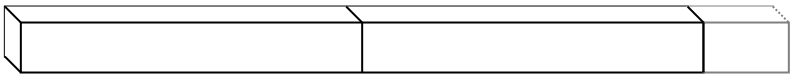

1) $6\frac{1}{2}$

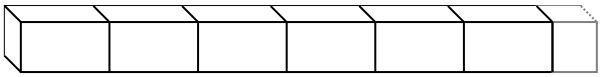

2) $2\frac{1}{4}$

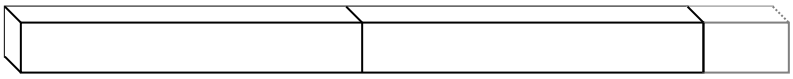

3) $8\frac{4}{5}$

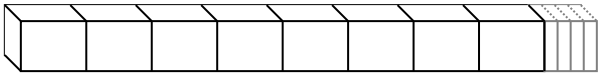

4) $7\frac{2}{3}$

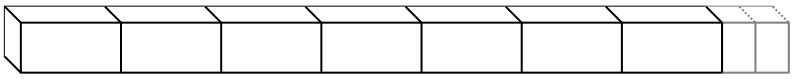

5) $3\frac{2}{5}$



6) $6\frac{1}{3}$

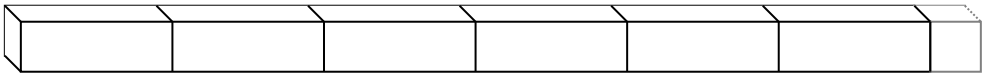

7) $1\frac{2}{4}$



8) $5\frac{1}{5}$



9) $2\frac{2}{3}$



10) $3\frac{3}{5}$



Antworten

Bsp. 9

1. _____
2. _____
3. _____
4. _____
5. _____
6. _____
7. _____
8. _____
9. _____
10. _____

Kleinere Einheiten identifizieren

Name: **Lösungsschlüssel**

Bestimme die Anzahl der kleinen Teilstücke, die aus dem größeren Stück gemacht werden können.

Bsp) $2\frac{1}{4}$

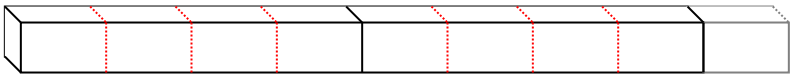

1) $6\frac{1}{2}$

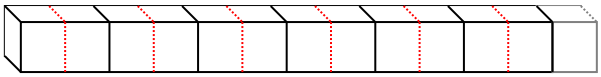

2) $2\frac{1}{4}$

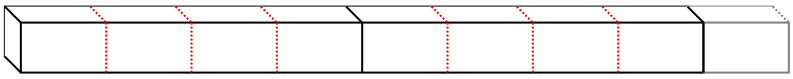

3) $8\frac{4}{5}$

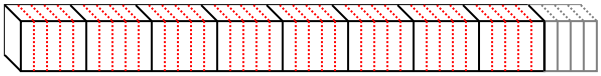

4) $7\frac{2}{3}$

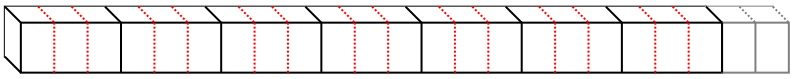

5) $3\frac{2}{5}$

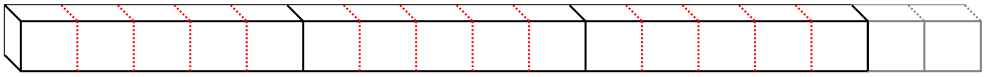

6) $6\frac{1}{3}$

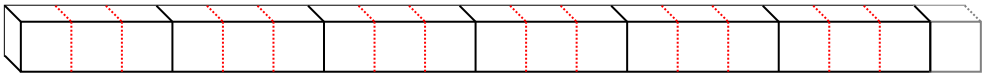

7) $1\frac{2}{4}$

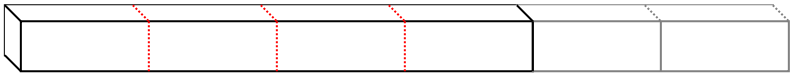

8) $5\frac{1}{5}$

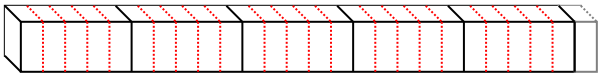

9) $2\frac{2}{3}$

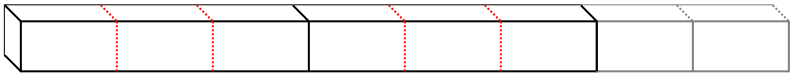

10) $3\frac{3}{5}$

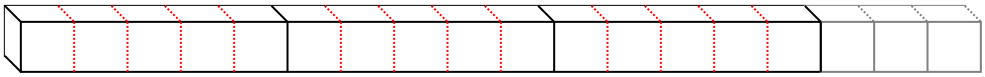

Antworten

Bsp.	9
1.	13
2.	9
3.	44
4.	23
5.	17
6.	19
7.	6
8.	26
9.	8
10.	18