Fehlende Winkel finden

Name:

Finden Sie den Wert von Winkel 'A' und Winkel 'B'.

1)

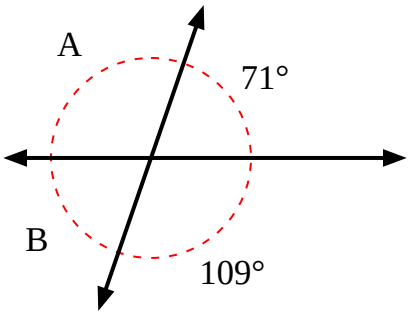

2)

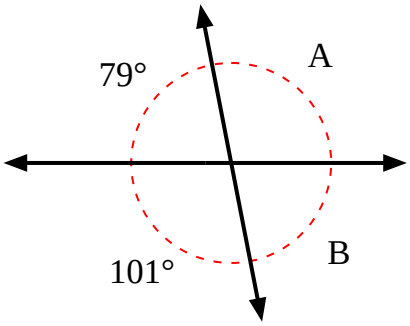

3)

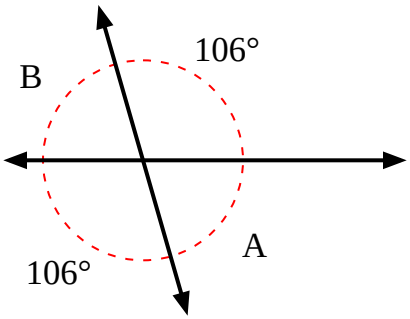

4)

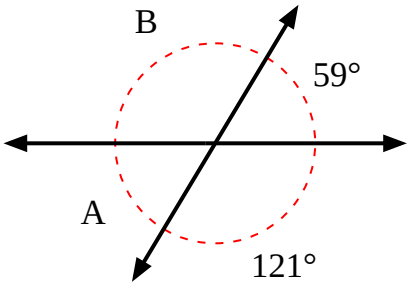

5)

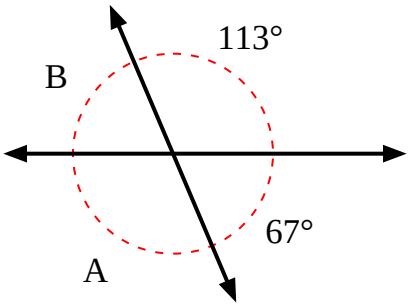

6)

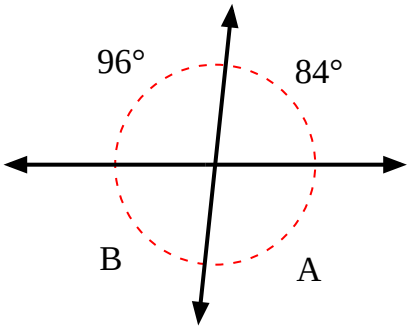

7)

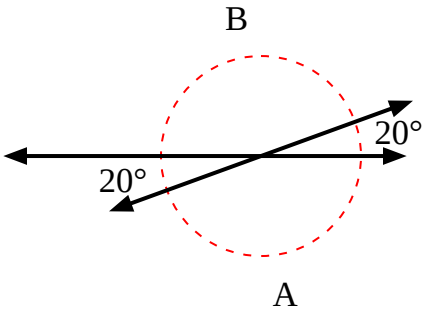

8)

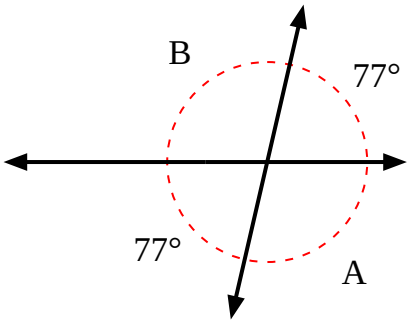

Antworten

1. _____ _____
2. _____ _____
3. _____ _____
4. _____ _____
5. _____ _____
6. _____ _____
7. _____ _____
8. _____ _____

1-8	88	75	63	50	38	25	13	0

Fehlende Winkel finden

Name: **Lösungsschlüssel**

Finden Sie den Wert von Winkel 'A' und Winkel 'B'.

1)

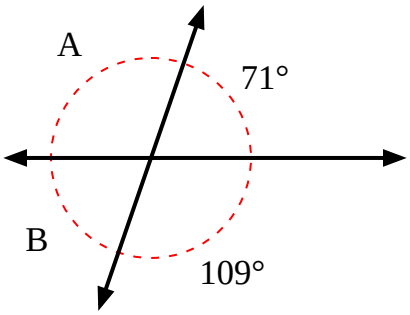

2)

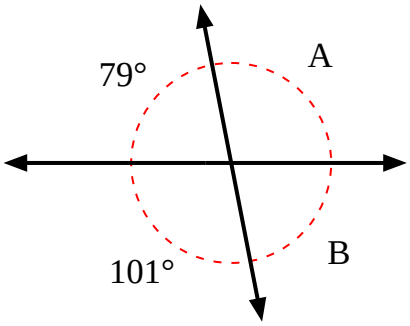

3)

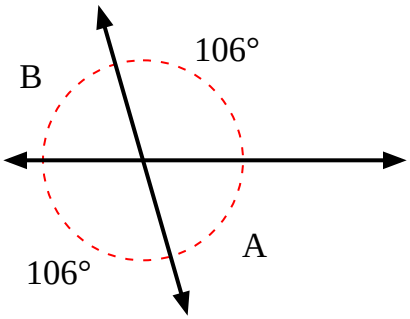

4)

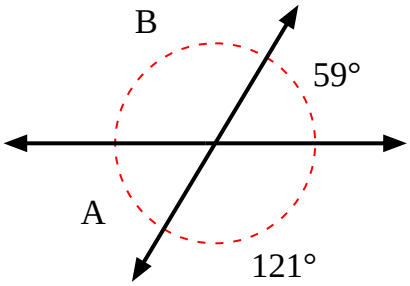

5)

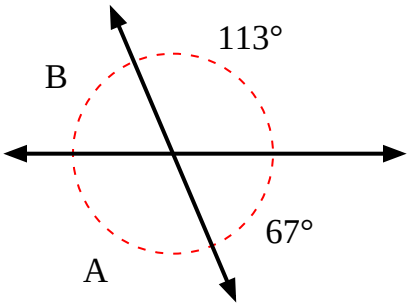

6)

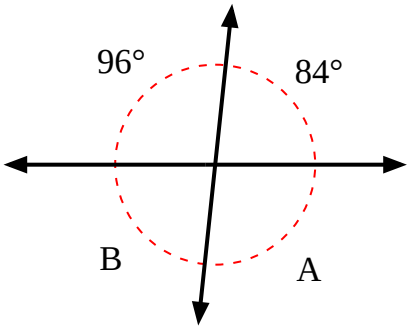

7)

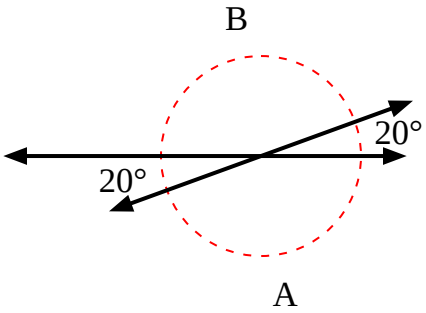

8)

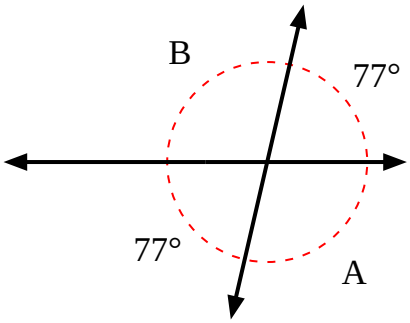

Antworten

1.	109°	71°
2.	101°	79°
3.	74°	74°
4.	59°	121°
5.	113°	67°
6.	96°	84°
7.	160°	160°
8.	103°	103°

1-8	88	75	63	50	38	25	13	0