Finden von fehlenden Winkeln

Name:

Finde den Größenwert von 'A'.

1)

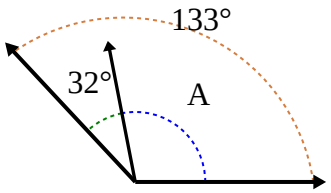

2)

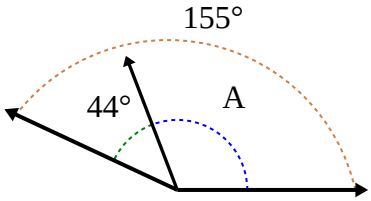

3)

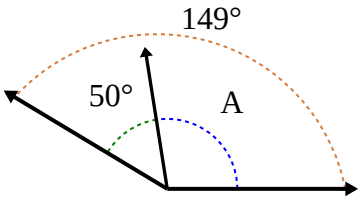

4)

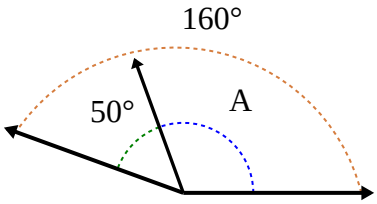

5)

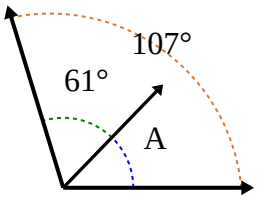

6)

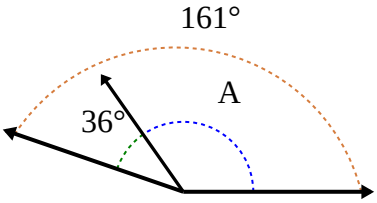

7)

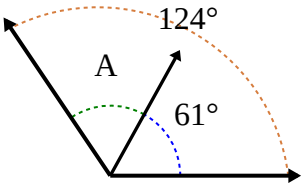

8)

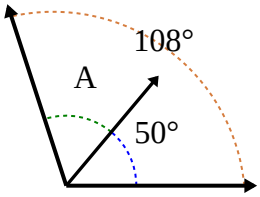

9)

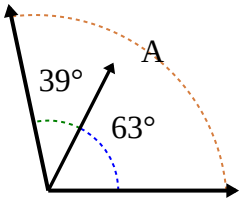

10)

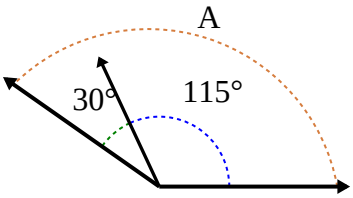

11)

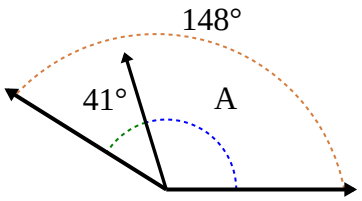

12)

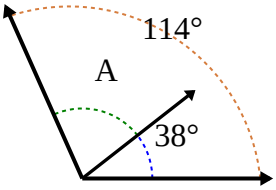

Antworten

1. _____
2. _____
3. _____
4. _____
5. _____
6. _____
7. _____
8. _____
9. _____
10. _____
11. _____
12. _____

1-10	92	83	75	67	58	50	42	33	25	17
11-12	8	0								

Finden von fehlenden Winkeln

Name: **Lösungsschlüssel**

Finde den Größenwert von 'A'.

1)

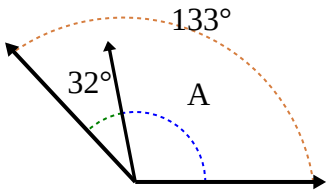

2)

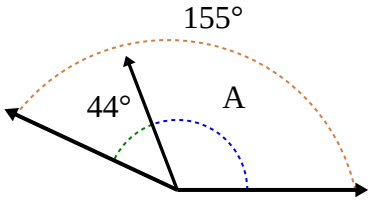

3)

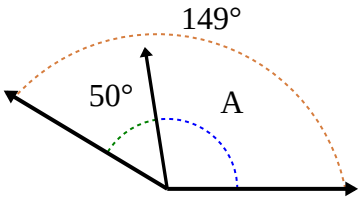

4)

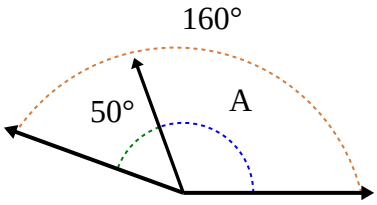

5)

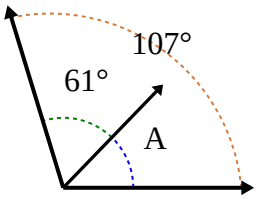

6)

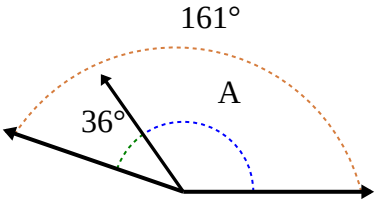

7)

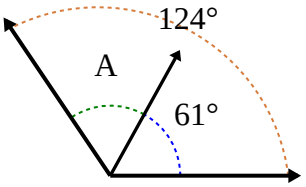

8)

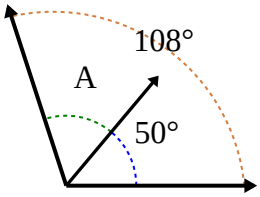

9)

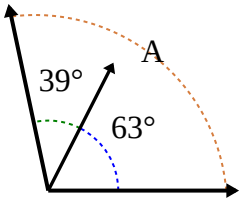

10)

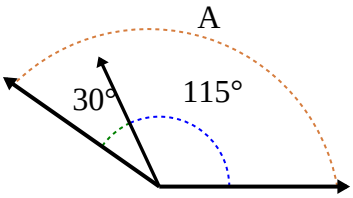

11)

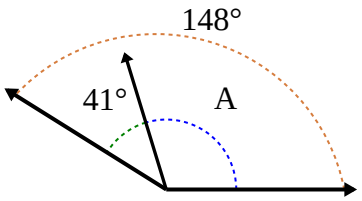

12)

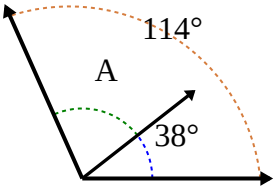

Antworten

1. **101**
2. **111**
3. **99**
4. **110**
5. **46**
6. **125**
7. **63**
8. **58**
9. **102**
10. **145**
11. **107**
12. **76**

1-10	92	83	75	67	58	50	42	33	25	17
11-12	8	0								

Finden von fehlenden Winkeln

Name:

Finde den Größenwert von 'A'.

1)

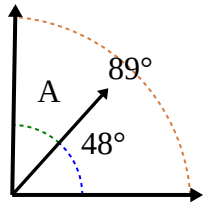

2)

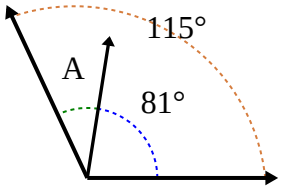

3)

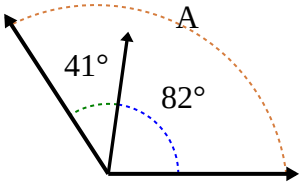

4)

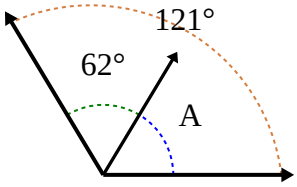

5)

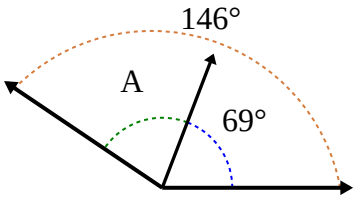

6)

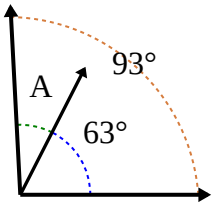

7)

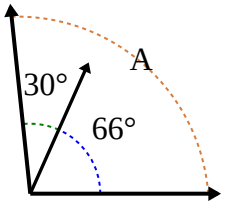

8)

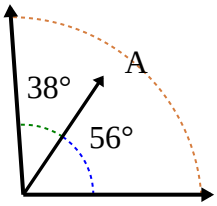

9)

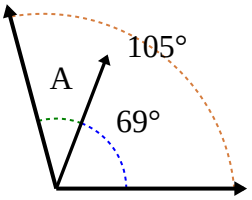

10)

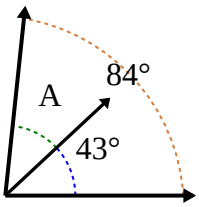

11)

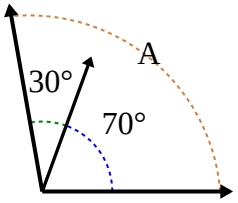

12)

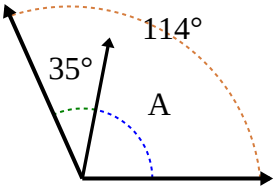

Antworten

1. _____
2. _____
3. _____
4. _____
5. _____
6. _____
7. _____
8. _____
9. _____
10. _____
11. _____
12. _____

1-10	92	83	75	67	58	50	42	33	25	17
11-12	8	0								

Finden von fehlenden Winkeln

Name: **Lösungsschlüssel**

Finde den Größenwert von 'A'.

1)

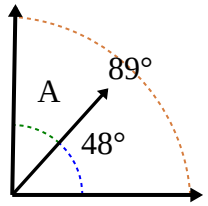

2)

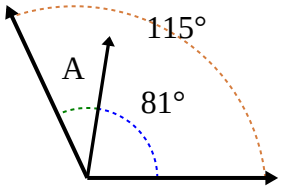

3)

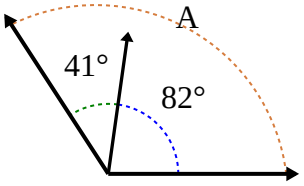

4)

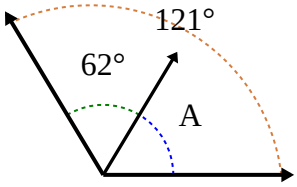

5)

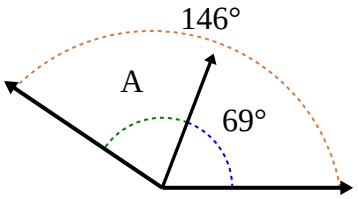

6)

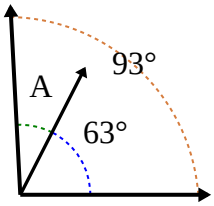

7)

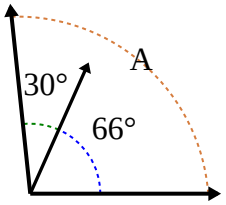

8)

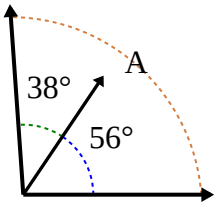

9)

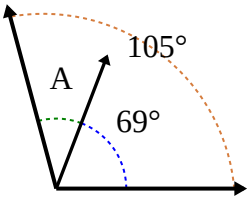

10)

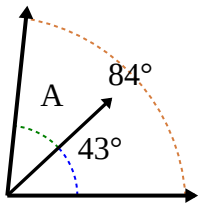

11)

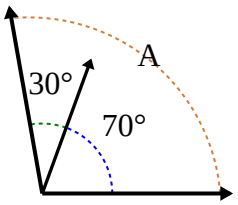

12)

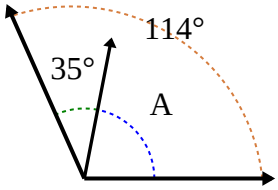

Antworten

1. **41**
2. **34**
3. **123**
4. **59**
5. **77**
6. **30**
7. **96**
8. **94**
9. **36**
10. **41**
11. **100**
12. **79**

1-10	92	83	75	67	58	50	42	33	25	17
11-12	8	0								

Finden von fehlenden Winkeln

Name:

Finde den Größenwert von 'A'.

1)

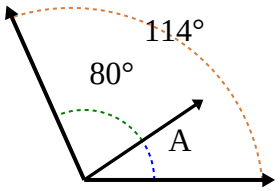

2)

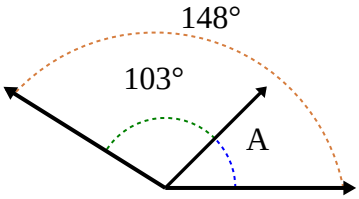

3)

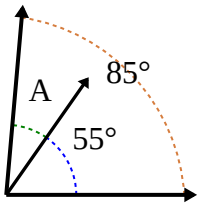

4)

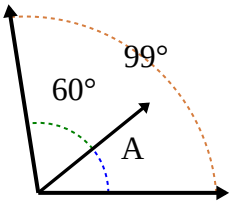

5)

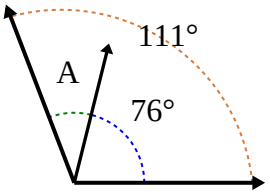

6)

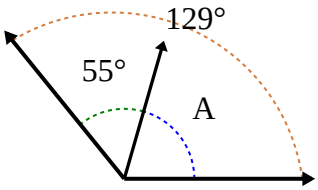

7)

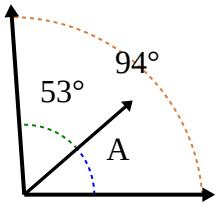

8)

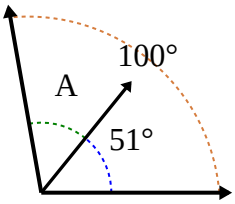

9)

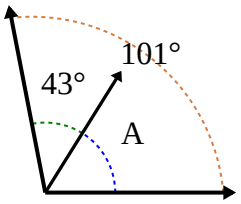

10)

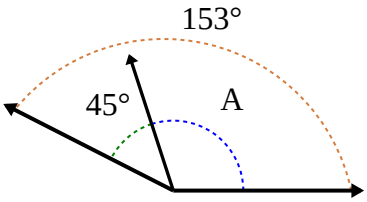

11)

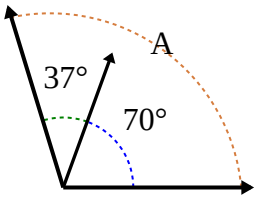

12)

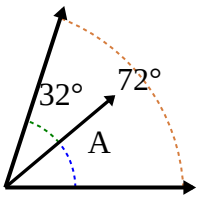

Antworten

1. _____
2. _____
3. _____
4. _____
5. _____
6. _____
7. _____
8. _____
9. _____
10. _____
11. _____
12. _____

1-10	92	83	75	67	58	50	42	33	25	17
11-12	8	0								

Finden von fehlenden Winkeln

Name: **Lösungsschlüssel**

Finde den Größenwert von 'A'.

1)

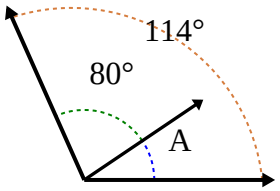

2)

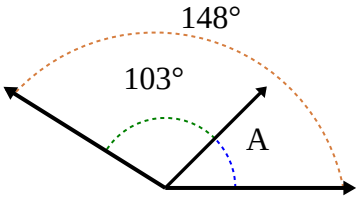

3)

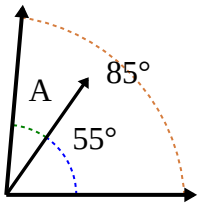

4)

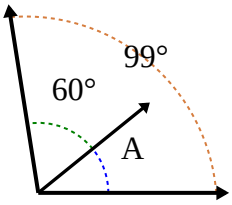

5)

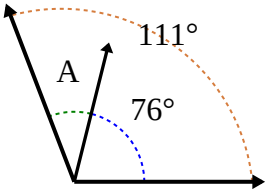

6)

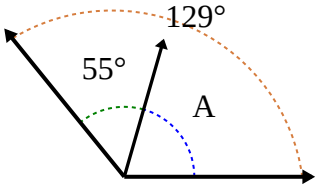

7)

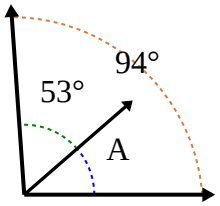

8)

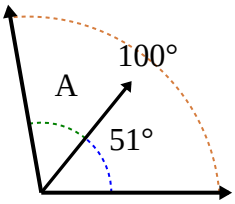

9)

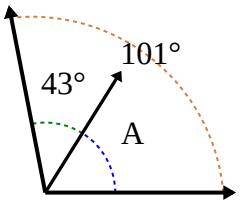

10)

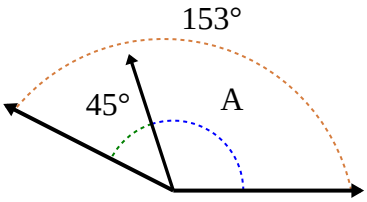

11)

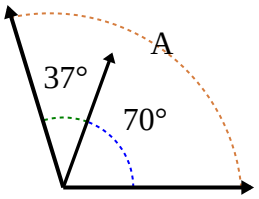

12)

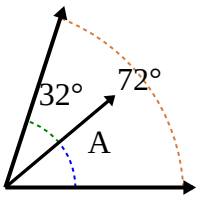

Antworten

1. **34**
2. **45**
3. **30**
4. **39**
5. **35**
6. **74**
7. **41**
8. **49**
9. **58**
10. **108**
11. **107**
12. **40**

1-10	92	83	75	67	58	50	42	33	25	17
11-12	8	0								

Finden von fehlenden Winkeln

Name:

Finde den Größenwert von 'A'.

1)

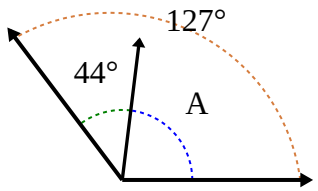

2)

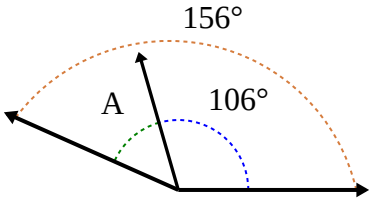

3)

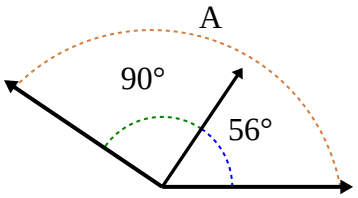

4)

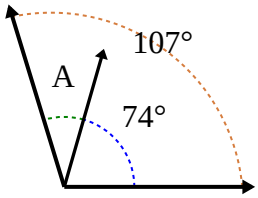

5)

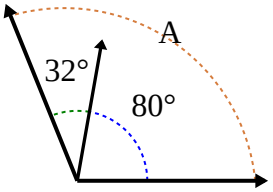

6)

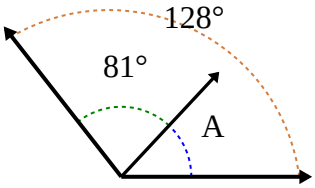

7)

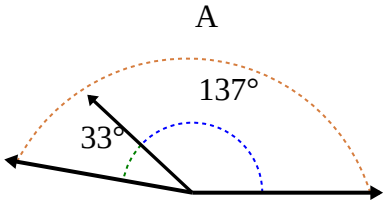

8)

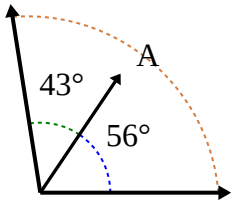

9)

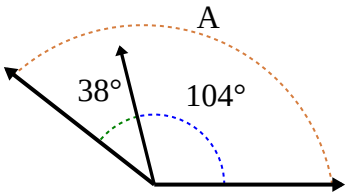

10)

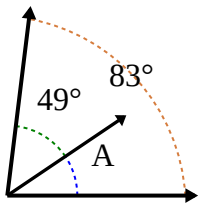

11)

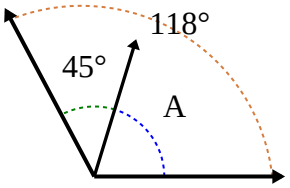

12)

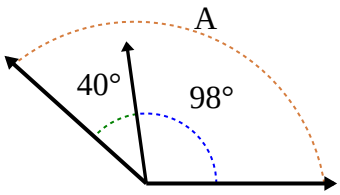

Antworten

1. _____
2. _____
3. _____
4. _____
5. _____
6. _____
7. _____
8. _____
9. _____
10. _____
11. _____
12. _____

1-10	92	83	75	67	58	50	42	33	25	17
11-12	8	0								

Finden von fehlenden Winkeln

Name: **Lösungsschlüssel**

Finde den Größenwert von 'A'.

1)

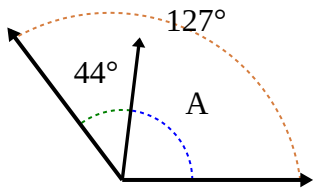

2)

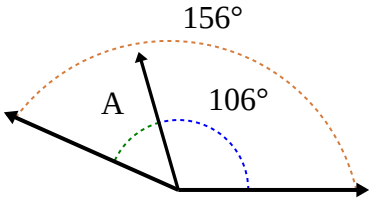

3)

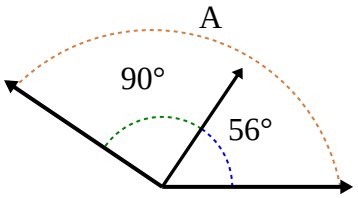

4)

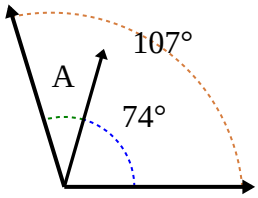

5)

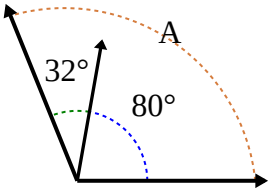

6)

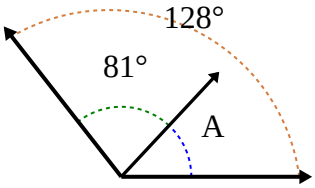

7)

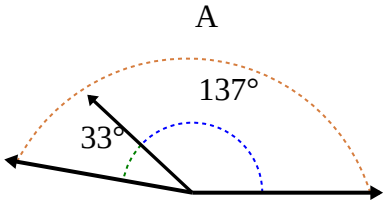

8)

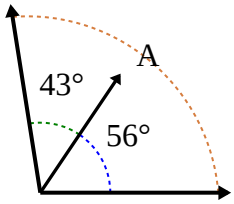

9)

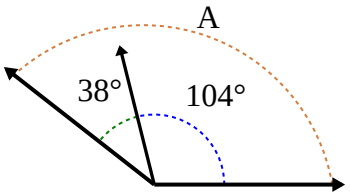

10)

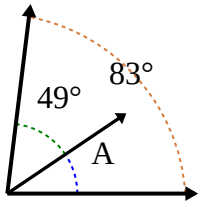

11)

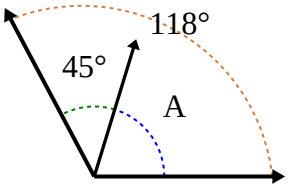

12)

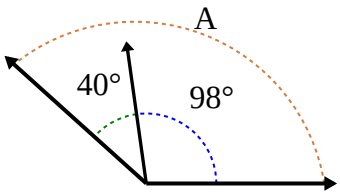

Antworten

1. **83**
2. **50**
3. **146**
4. **33**
5. **112**
6. **47**
7. **170**
8. **99**
9. **142**
10. **34**
11. **73**
12. **138**

1-10	92	83	75	67	58	50	42	33	25	17
11-12	8	0								

Finden von fehlenden Winkeln

Name:

Finde den Größenwert von 'A'.

1)

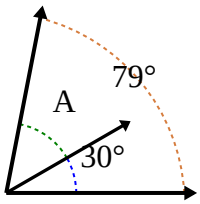

2)

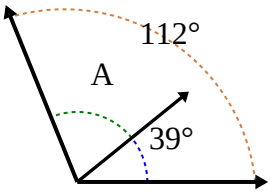

3)

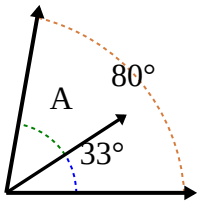

4)

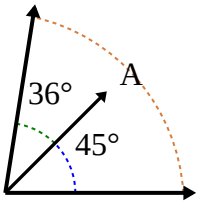

5)

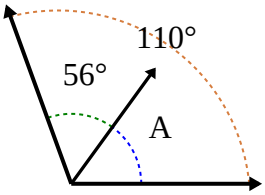

6)

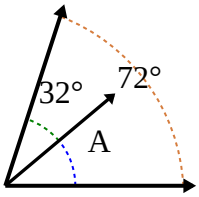

7)

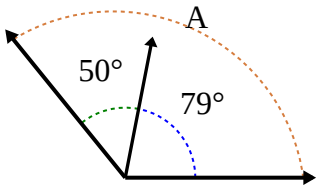

8)

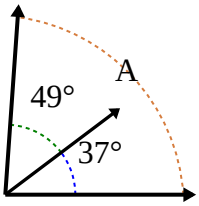

9)

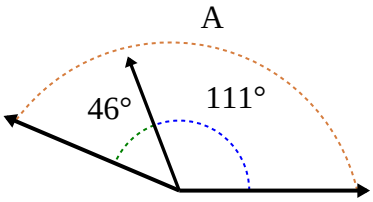

10)

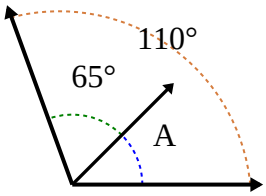

11)

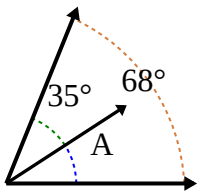

12)

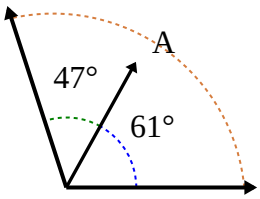

Antworten

1. _____
2. _____
3. _____
4. _____
5. _____
6. _____
7. _____
8. _____
9. _____
10. _____
11. _____
12. _____

1-10	92	83	75	67	58	50	42	33	25	17
11-12	8	0								

Finden von fehlenden Winkeln

Name: **Lösungsschlüssel**

Finde den Größenwert von 'A'.

1)

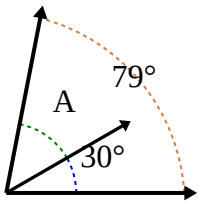

2)

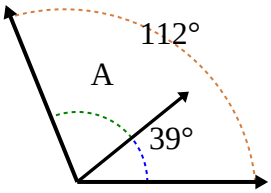

3)

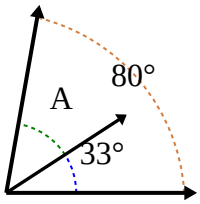

4)

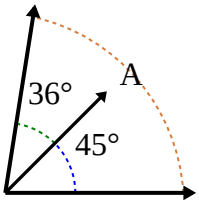

5)

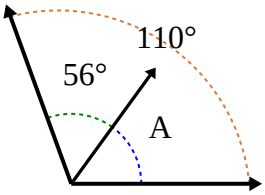

6)

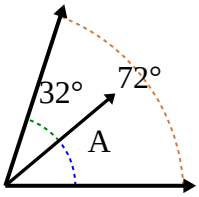

7)

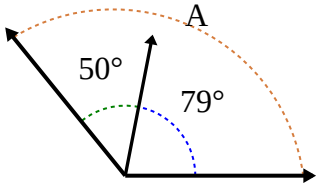

8)

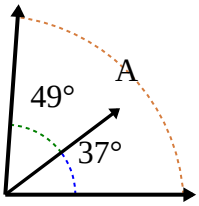

9)

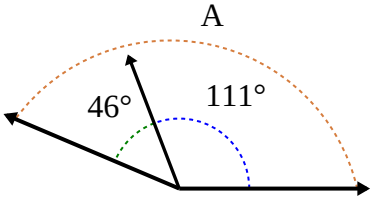

10)

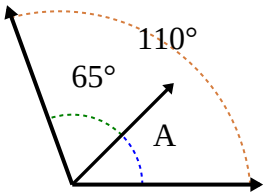

11)

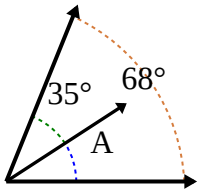

12)

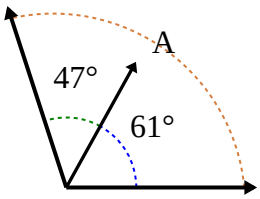

Antworten

1. **49**
2. **73**
3. **47**
4. **81**
5. **54**
6. **40**
7. **129**
8. **86**
9. **157**
10. **45**
11. **33**
12. **108**

1-10	92	83	75	67	58	50	42	33	25	17
11-12	8	0								

Finden von fehlenden Winkeln

Name:

Finde den Größenwert von 'A'.

1)

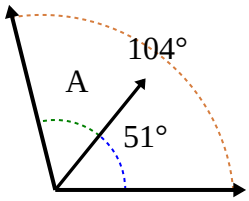

2)

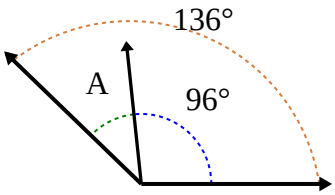

3)

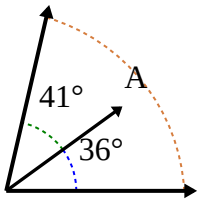

4)

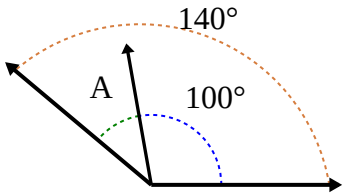

5)

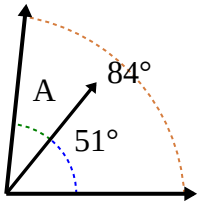

6)

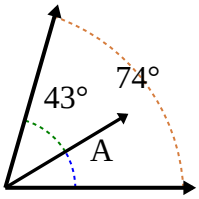

7)

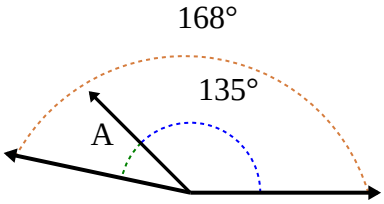

8)

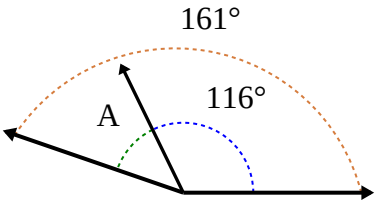

9)

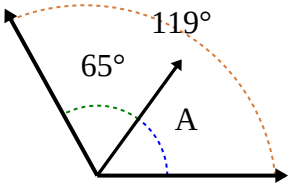

10)

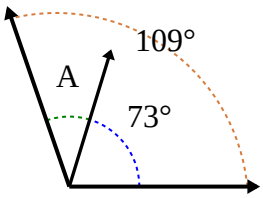

11)

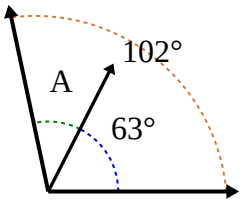

12)

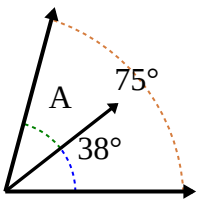

Antworten

1. _____
2. _____
3. _____
4. _____
5. _____
6. _____
7. _____
8. _____
9. _____
10. _____
11. _____
12. _____

1-10	92	83	75	67	58	50	42	33	25	17
11-12	8	0								

Finden von fehlenden Winkeln

Name: **Lösungsschlüssel**

Finde den Größenwert von 'A'.

1)

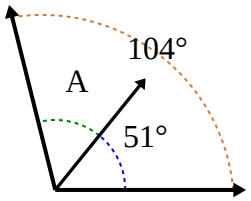

2)

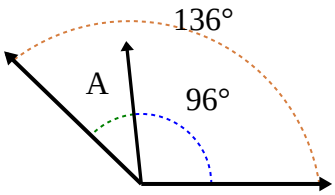

3)

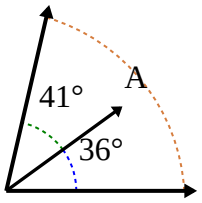

4)

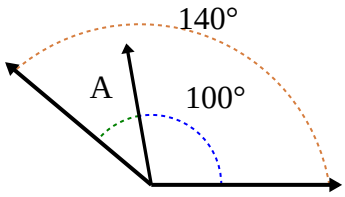

5)

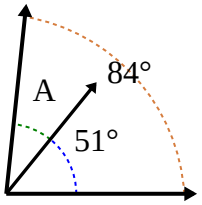

6)

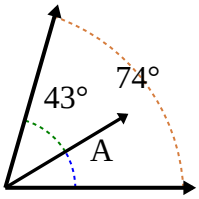

7)

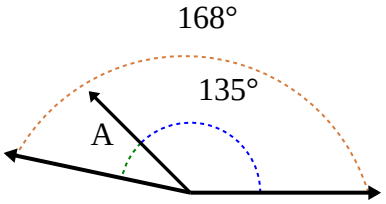

8)

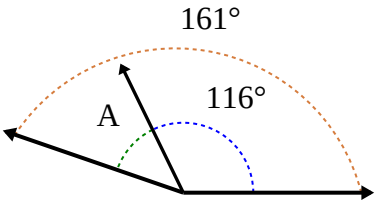

9)

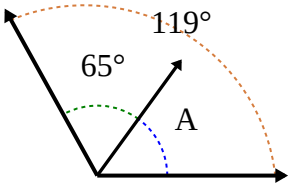

10)

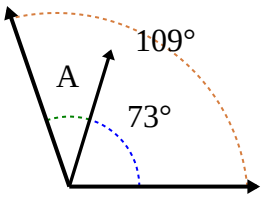

11)

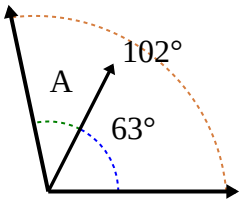

12)

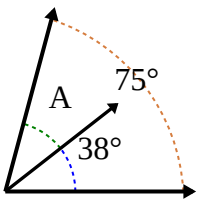

Antworten

1. **53**
2. **40**
3. **77**
4. **40**
5. **33**
6. **31**
7. **33**
8. **45**
9. **54**
10. **36**
11. **39**
12. **37**

1-10	92	83	75	67	58	50	42	33	25	17
11-12	8	0								

Finden von fehlenden Winkeln

Name:

Finde den Größenwert von 'A'.

1)

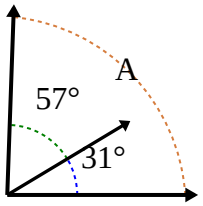

2)

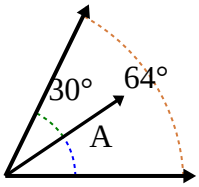

3)

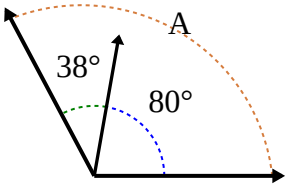

4)

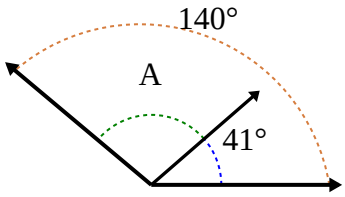

5)

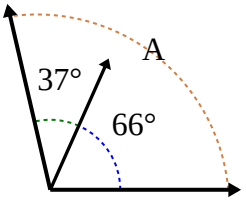

6)

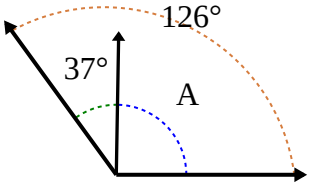

7)

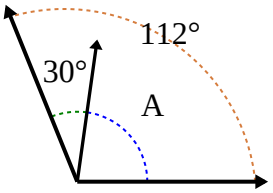

8)

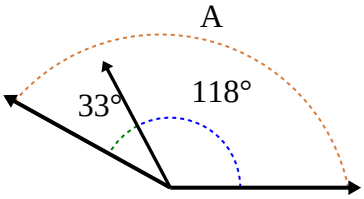

9)

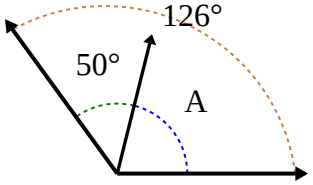

10)

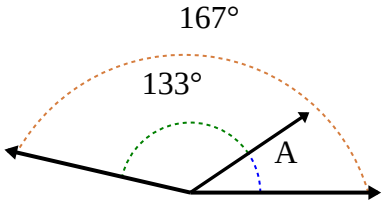

11)

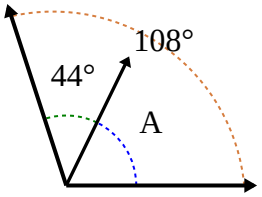

12)

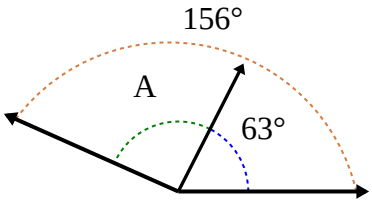

Antworten

1. _____
2. _____
3. _____
4. _____
5. _____
6. _____
7. _____
8. _____
9. _____
10. _____
11. _____
12. _____

1-10	92	83	75	67	58	50	42	33	25	17
11-12	8	0								

Finden von fehlenden Winkeln

Name: **Lösungsschlüssel**

Finde den Größenwert von 'A'.

1)

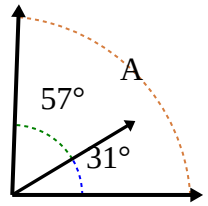

2)

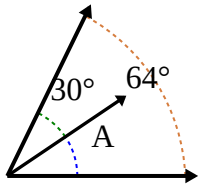

3)

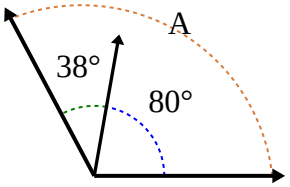

4)

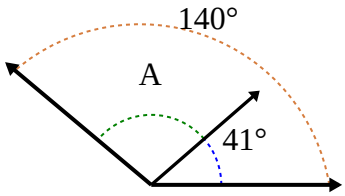

5)

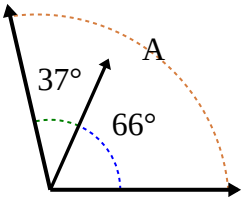

6)

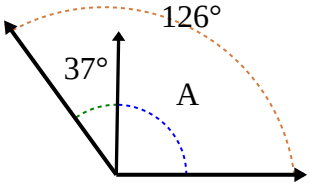

7)

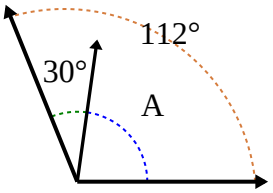

8)

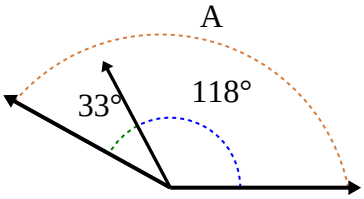

9)

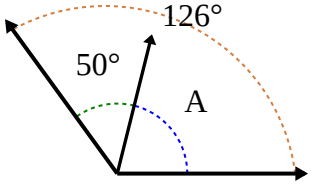

10)

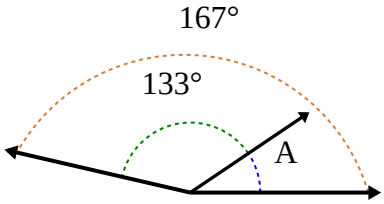

11)

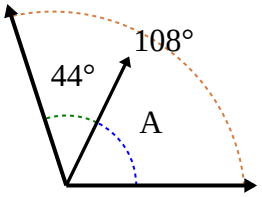

12)

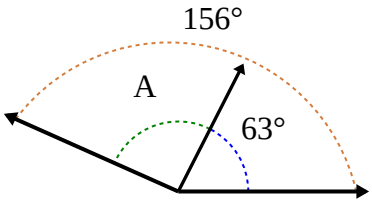

Antworten

1. **88**
2. **34**
3. **118**
4. **99**
5. **103**
6. **89**
7. **82**
8. **151**
9. **76**
10. **34**
11. **64**
12. **93**

1-10	92	83	75	67	58	50	42	33	25	17
11-12	8	0								

Finden von fehlenden Winkeln

Name:

Finde den Größenwert von 'A'.

1)

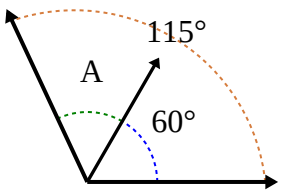

2)

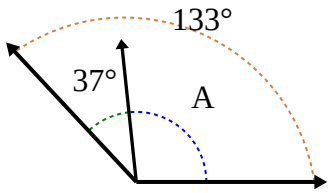

3)

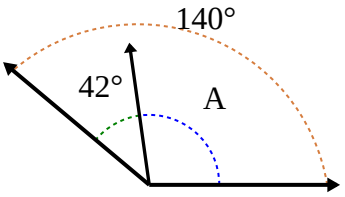

4)

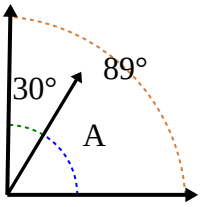

5)

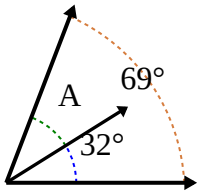

6)

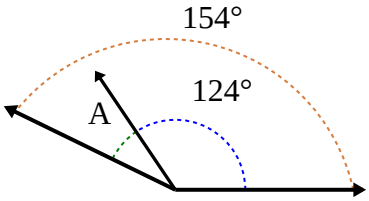

7)

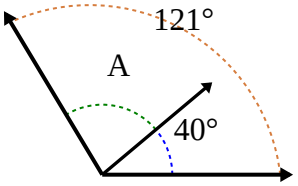

8)

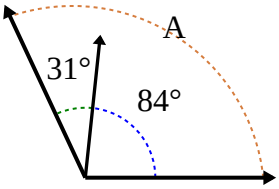

9)

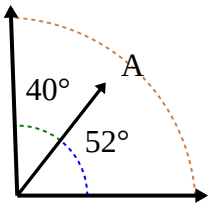

10)

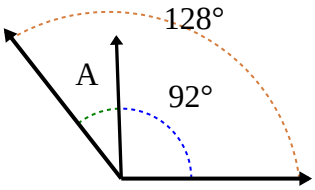

11)

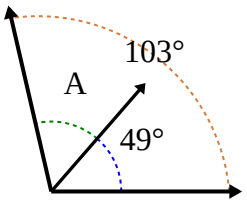

12)

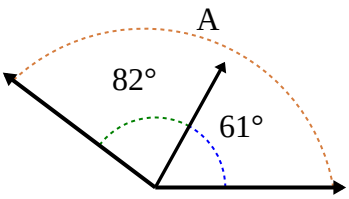

Antworten

1. _____
2. _____
3. _____
4. _____
5. _____
6. _____
7. _____
8. _____
9. _____
10. _____
11. _____
12. _____

1-10	92	83	75	67	58	50	42	33	25	17
11-12	8	0								

Finden von fehlenden Winkeln

Name: **Lösungsschlüssel**

Finde den Größenwert von 'A'.

1)

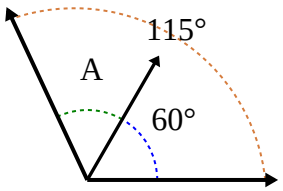

2)

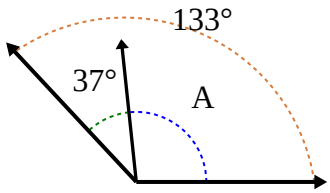

3)

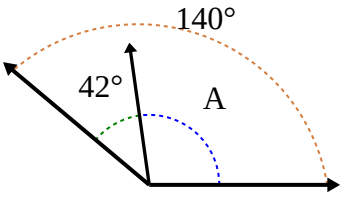

4)

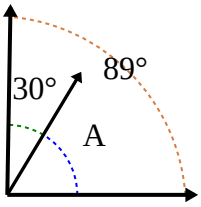

5)

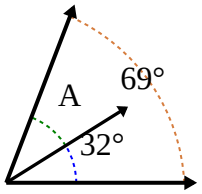

6)

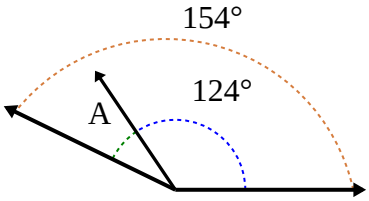

7)

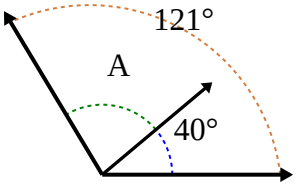

8)

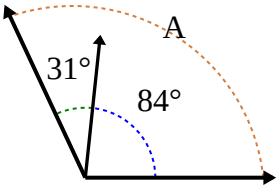

9)

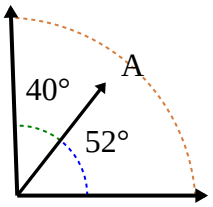

10)

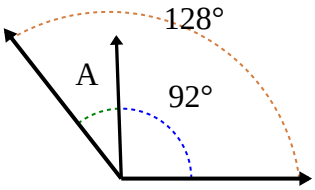

11)

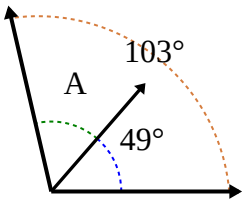

12)

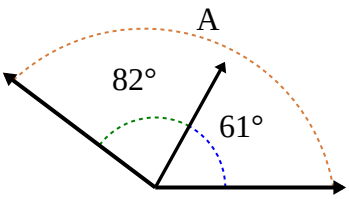

Antworten

1. **55**
2. **96**
3. **98**
4. **59**
5. **37**
6. **30**
7. **81**
8. **115**
9. **92**
10. **36**
11. **54**
12. **143**

1-10	92	83	75	67	58	50	42	33	25	17
11-12	8	0								

Finden von fehlenden Winkeln Name:

Finde den Größenwert von 'A'.

1)

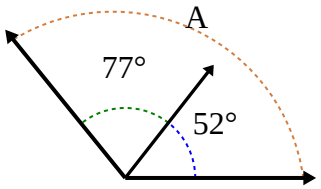

2)

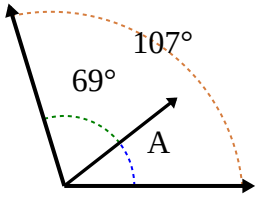

3)

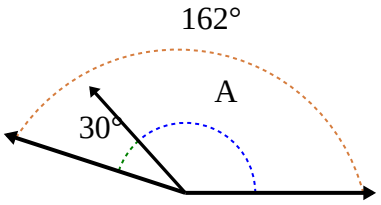

4)

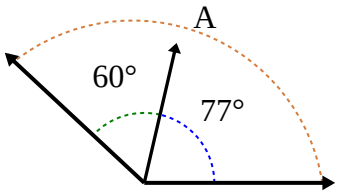

5)

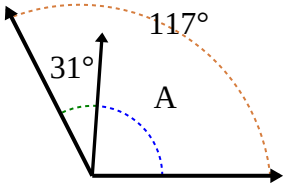

6)

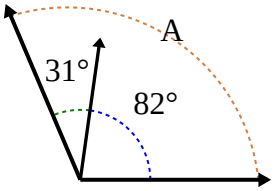

7)

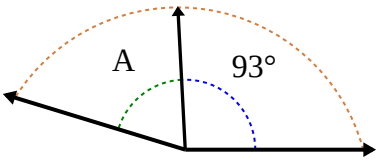

8)

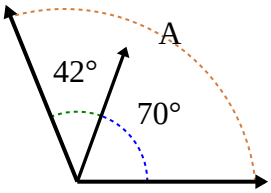

9)

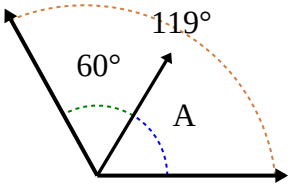

10)

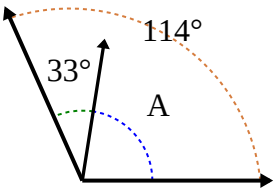

11)

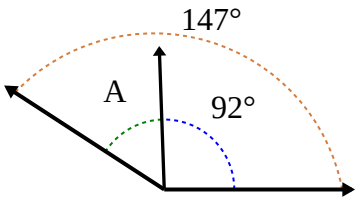

12)

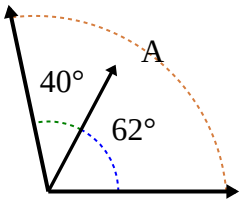

Antworten

1. _____
2. _____
3. _____
4. _____
5. _____
6. _____
7. _____
8. _____
9. _____
10. _____
11. _____
12. _____

1-10	92	83	75	67	58	50	42	33	25	17
11-12	8	0								

Finden von fehlenden Winkeln

Name: **Lösungsschlüssel**

Finde den Größenwert von 'A'.

1)

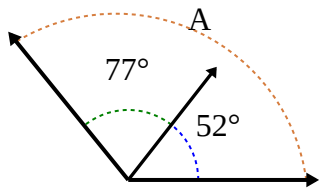

2)

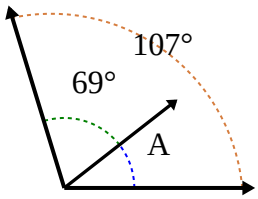

3)

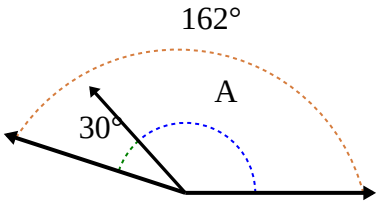

4)

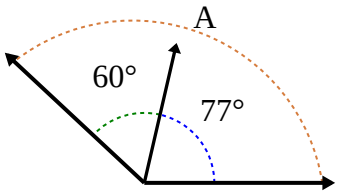

5)

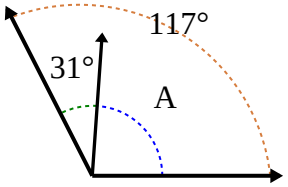

6)

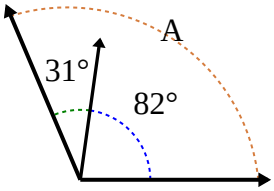

7)

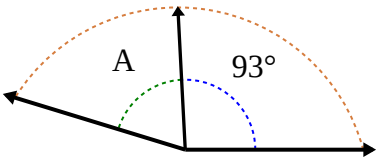

8)

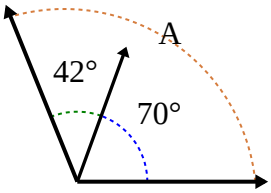

9)

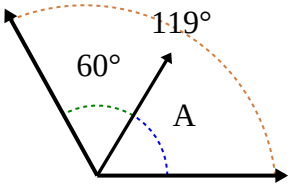

10)

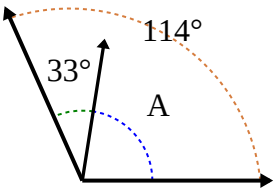

11)

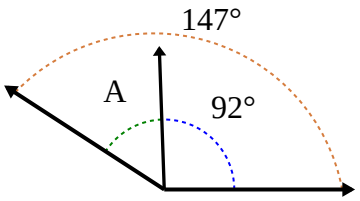

12)

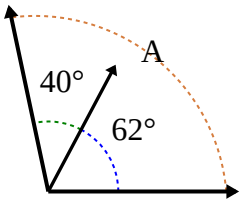

Antworten

1. **129**
2. **38**
3. **132**
4. **137**
5. **86**
6. **113**
7. **70**
8. **112**
9. **59**
10. **81**
11. **55**
12. **102**

1-10	92	83	75	67	58	50	42	33	25	17
11-12	8	0								

Finden von fehlenden Winkeln

Name:

Finde den Größenwert von 'A'.

1)

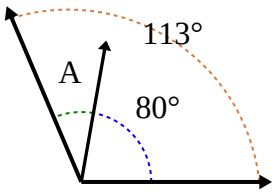

2)

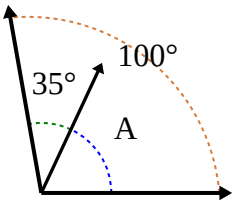

3)

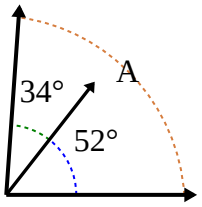

4)

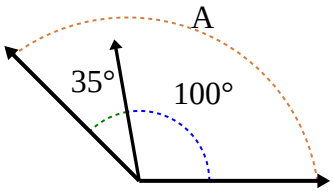

5)

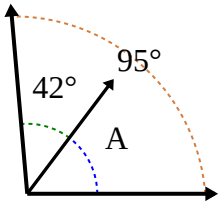

6)

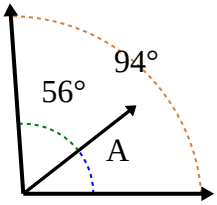

7)

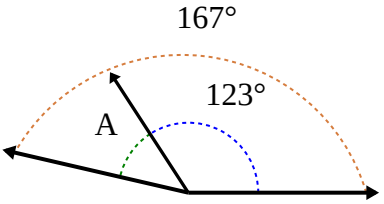

8)

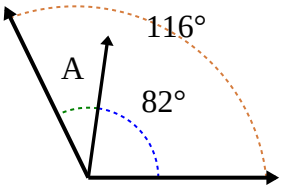

9)

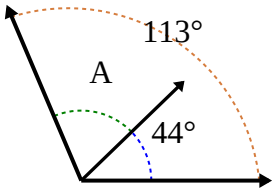

10)

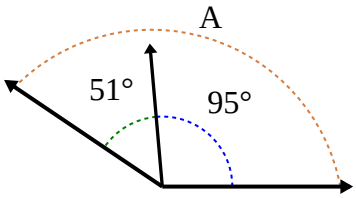

11)

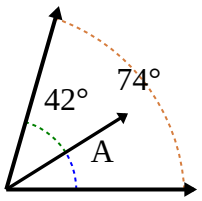

12)

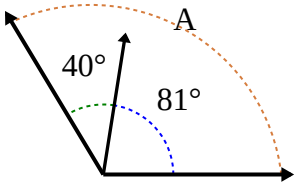

Antworten

1. _____
2. _____
3. _____
4. _____
5. _____
6. _____
7. _____
8. _____
9. _____
10. _____
11. _____
12. _____

1-10	92	83	75	67	58	50	42	33	25	17
11-12	8	0								

Finden von fehlenden Winkeln

Name: **Lösungsschlüssel**

Finde den Größenwert von 'A'.

1)

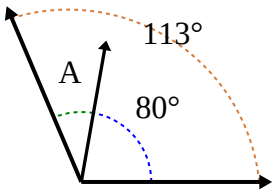

2)

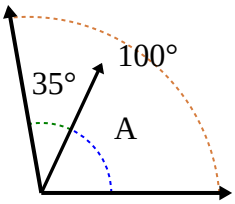

3)

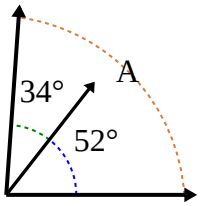

4)

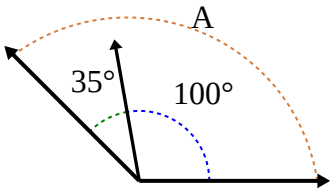

5)

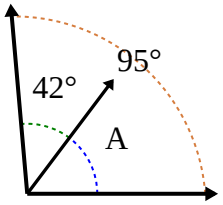

6)

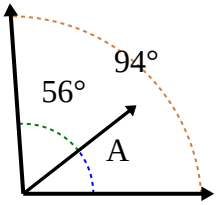

7)

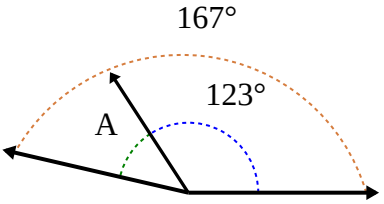

8)

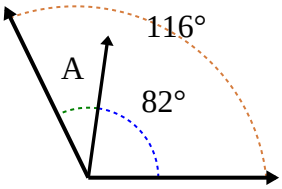

9)

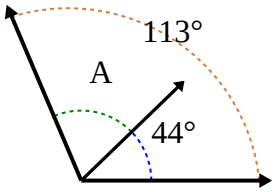

10)

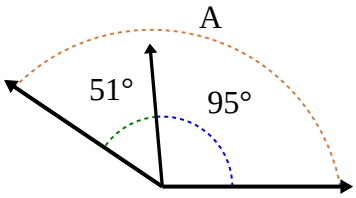

11)

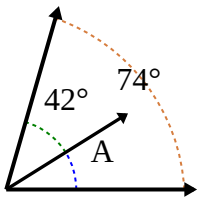

12)

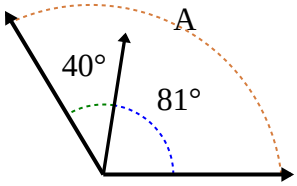

Antworten

1. **33**
2. **65**
3. **86**
4. **135**
5. **53**
6. **38**
7. **44**
8. **34**
9. **69**
10. **146**
11. **32**
12. **121**

1-10	92	83	75	67	58	50	42	33	25	17
11-12	8	0								