Finden der fehlenden Seitenlänge des rechten Dreiecks (Fläche) Name:

Finden Sie den Wert von X.

1) Umfang = 12 u

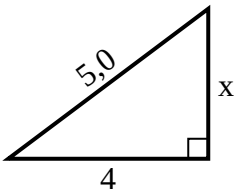

2) Umfang = 10,5 u

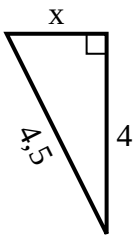

3) Umfang = 24 u

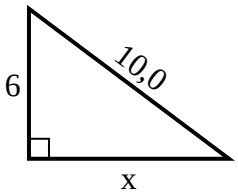

4) Umfang = 13,7 u

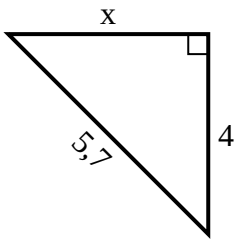

5) Umfang = 17,2 u

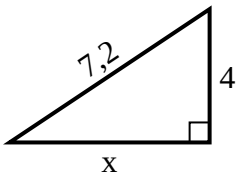

6) Umfang = 14,3 u

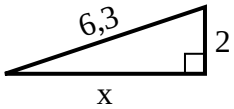

7) Umfang = 17,2 u

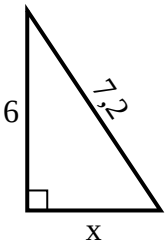

8) Umfang = 21,5 u

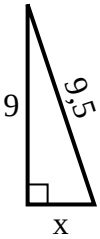

9) Umfang = 20,9 u

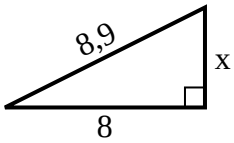

10) Umfang = 17,6 u

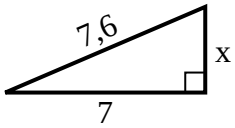

11) Umfang = 22,4 u

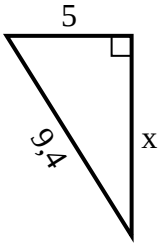

12) Umfang = 22,2 u

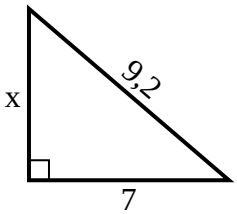

Antworten

1. _____
2. _____
3. _____
4. _____
5. _____
6. _____
7. _____
8. _____
9. _____
10. _____
11. _____
12. _____

1-10	92	83	75	67	58	50	42	33	25	17
11-12	8	0								

Finden der fehlenden Seitenlänge des rechten Dreiecks (Fläche) Name: **Lösungsschlüssel**

Finden Sie den Wert von X.

1) Umfang = 12 u

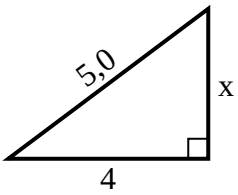

2) Umfang = 10,5 u

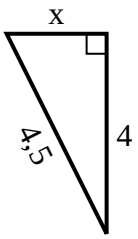

3) Umfang = 24 u

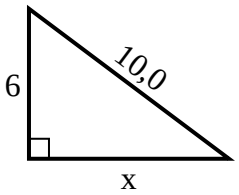

4) Umfang = 13,7 u

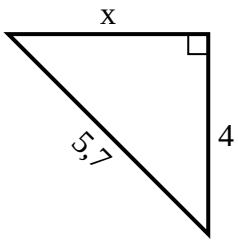

5) Umfang = 17,2 u

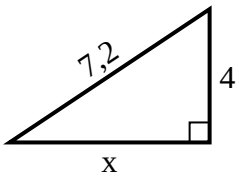

6) Umfang = 14,3 u

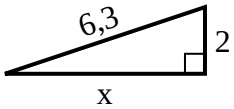

7) Umfang = 17,2 u

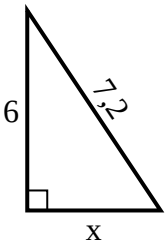

8) Umfang = 21,5 u

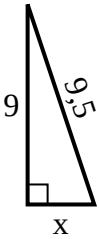

9) Umfang = 20,9 u

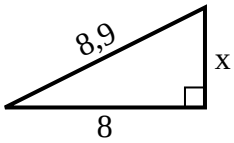

10) Umfang = 17,6 u

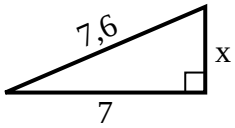

11) Umfang = 22,4 u

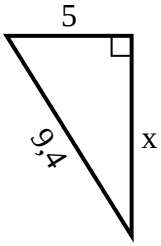

12) Umfang = 22,2 u

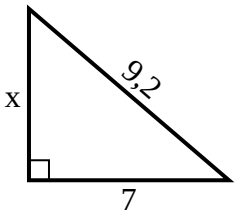

Antworten

1. 3
2. 2
3. 8
4. 4
5. 6
6. 6
7. 4
8. 3
9. 4
10. 3
11. 8
12. 6

1-10	92	83	75	67	58	50	42	33	25	17
11-12	8	0								