Finden der fehlenden Seitenlänge des rechten Dreiecks (Fläche) Name:

Finden Sie den Wert von X.

1) area = 9 u^2

2) area = 31.5 u^2

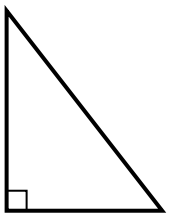

3) area = 15 u^2

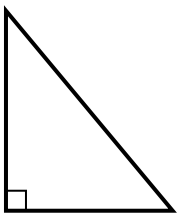

4) area = 17.5 u^2

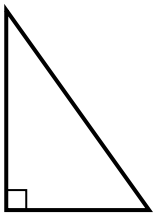

5) area = 2 u^2

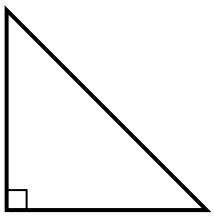

6) area = 10.5 u^2

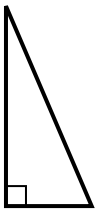

7) area = 17.5 u^2

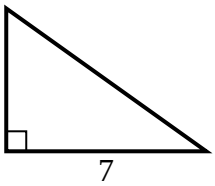

8) area = 22.5 u^2

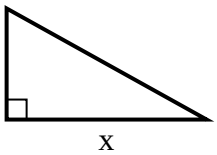

9) area = 10 u^2

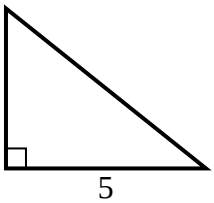

10) area = 12 u^2

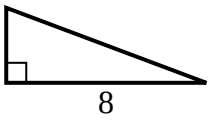

11) area = 7 u^2

12) area = 10.5 u^2

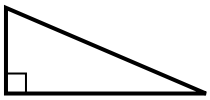

Antworten

1. _____
2. _____
3. _____
4. _____
5. _____
6. _____
7. _____
8. _____
9. _____
10. _____
11. _____
12. _____

1-10	92	83	75	67	58	50	42	33	25	17
11-12	8	0								

Finden der fehlenden Seitenlänge des rechten Dreiecks (Fläche) Name: **Lösungsschlüssel**

Finden Sie den Wert von X.

1) area = 9 u^2

2) area = 31.5 u^2

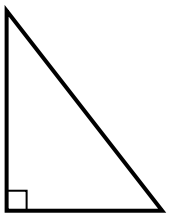

3) area = 15 u^2

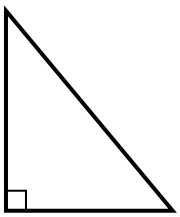

4) area = 17.5 u^2

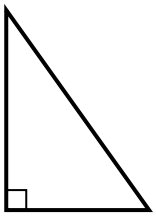

5) area = 2 u^2

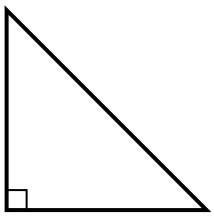

6) area = 10.5 u^2

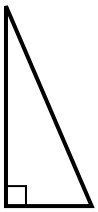

7) area = 17.5 u^2

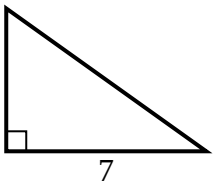

8) area = 22.5 u^2

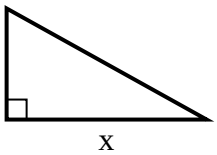

9) area = 10 u^2

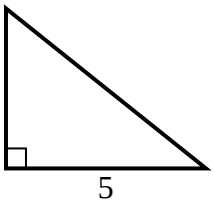

10) area = 12 u^2

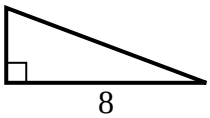

11) area = 7 u^2

12) area = 10.5 u^2

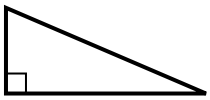

Antworten

1. 9
2. 7
3. 5
4. 7
5. 2
6. 7
7. 5
8. 9
9. 4
10. 3
11. 2
12. 7

1-10	92	83	75	67	58	50	42	33	25	17
11-12	8	0								