Gewicht schätzen (metrisch)

Name:

Bestimme, welcher Buchstabe am besten das Gewicht des Objekts darstellt.

Grama (g)
Un gramo es aproximadamente el peso de un clip.

Kilogramo (kilogramo)
Un kilogramo es aproximadamente el peso de un libro grueso.



Recuerda:
Kilo significa 1,000. Entonces, un kilogramo son 1,000 gramos. 1 kilogramo también pesa aproximadamente lo mismo que 2 libras.

1)

Kerze
A. 10 kg
B. 500 g
C. 4 g
D. 2 kg

2)

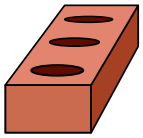

Ziegel
A. 2 kg
B. 500 kg
C. 3 g
D. 500 g

3)

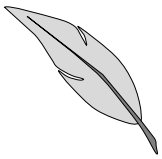

Feder
A. 200 g
B. 200 kg
C. 1 kg
D. 1 g

4)



Bügeleisen
A. 15 g
B. 100 g
C. 15 kg
D. 2 kg

5)

Schaufel
A. 30 kg
B. 5 kg
C. 10 g
D. 1 g

6)

Aktenschrank
A. 1 g
B. 1 kg
C. 55 kg
D. 300 g

7)

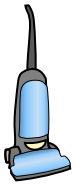

Vakuum
A. 20 kg
B. 500 kg
C. 90 g
D. 50 g

8)

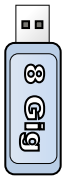

Flash Drive
A. 10 g
B. 90 kg
C. 10 kg
D. 1 kg

9)



Erwachsenes Pferd
A. 30 kg
B. 400 kg
C. 400 g
D. 30 g

Antworten

1. _____
2. _____
3. _____
4. _____
5. _____
6. _____
7. _____
8. _____
9. _____

1-9	89	78	67	56	44	33	22	11	0

Gewicht schätzen (metrisch) Name: **Lösungsschlüssel**

Bestimme, welcher Buchstabe am besten das Gewicht des Objekts darstellt.

Grama (g)
Un gramo es aproximadamente el peso de un clip.

Kilogramo (kilogramo)
Un kilogramo es aproximadamente el peso de un libro grueso.



Recuerda:
Kilo significa 1,000. Entonces, un kilogramo son 1,000 gramos. 1 kilogramo también pesa aproximadamente lo mismo que 2 libras.

1)

Kerze
A. 10 kg
B. 500 g
C. 4 g
D. 2 kg

2)

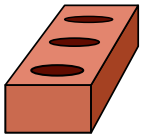

Ziegel
A. 2 kg
B. 500 kg
C. 3 g
D. 500 g

3)

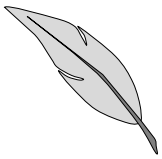

Feder
A. 200 g
B. 200 kg
C. 1 kg
D. 1 g

4)



Bügeleisen
A. 15 g
B. 100 g
C. 15 kg
D. 2 kg

5)

Schaufel
A. 30 kg
B. 5 kg
C. 10 g
D. 1 g

6)

Aktenschrank
A. 1 g
B. 1 kg
C. 55 kg
D. 300 g

7)

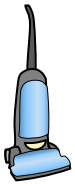

Vakuum
A. 20 kg
B. 500 kg
C. 90 g
D. 50 g

8)

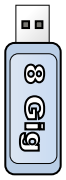

Flash Drive
A. 10 g
B. 90 kg
C. 10 kg
D. 1 kg

9)



Erwachsenes Pferd
A. 30 kg
B. 400 kg
C. 400 g
D. 30 g

Antworten

1. C
2. A
3. D
4. D
5. B
6. C
7. A
8. A
9. B

1-9	89	78	67	56	44	33	22	11	0