Dreiecke erstellen

Name:

**Verwenden Sie einen Winkelmesser, um aus der gezeigten Abbildung ein Dreieck zu erstellen. Antworten Sie mit den fehlenden Winkeln. Antworten variieren.**

**1)**

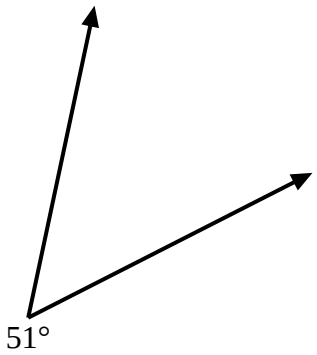


**2)**

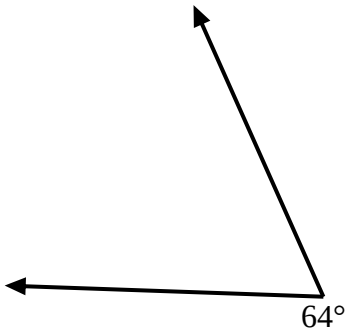


**3)**

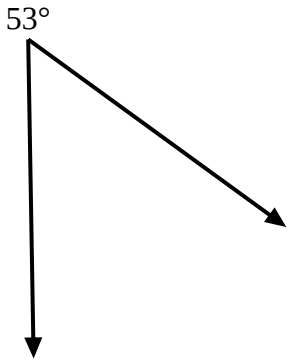


**4)**

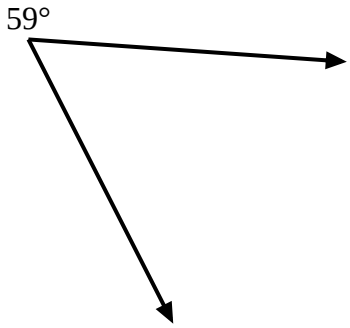


**5)**

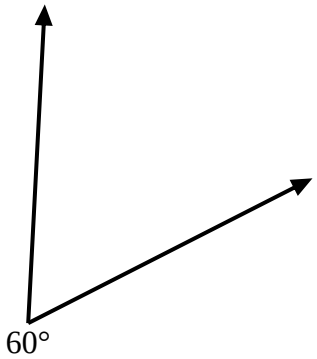


**6)**

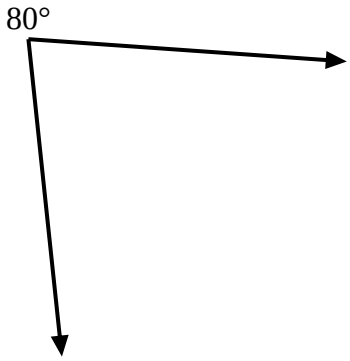


**7)**

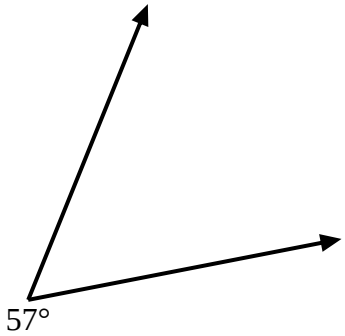


**8)**

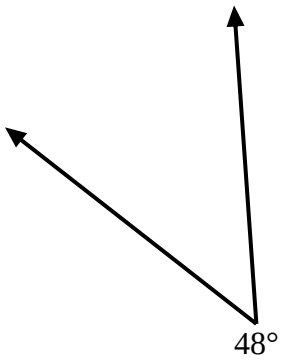


## Antworten

1. _____
2. _____
3. _____
4. _____
5. _____
6. _____
7. _____
8. _____



| | | | | | | | | |
|---|---|---|---|---|---|---|---|---|
| 1-8 | 88 | 75 | 63 | 50 | 38 | 25 | 13 | 0 |

Dreiecke erstellen

Name: **Lösungsschlüssel**

**Verwenden Sie einen Winkelmesser, um aus der gezeigten Abbildung ein Dreieck zu erstellen. Antworten Sie mit den fehlenden Winkeln. Antworten variieren.**

**1)**

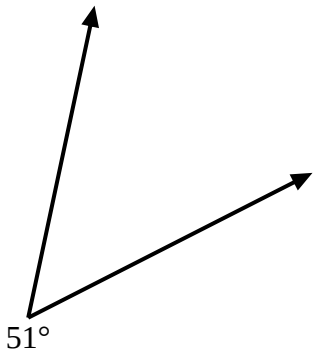


**2)**

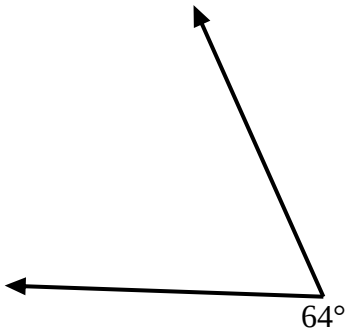


**3)**

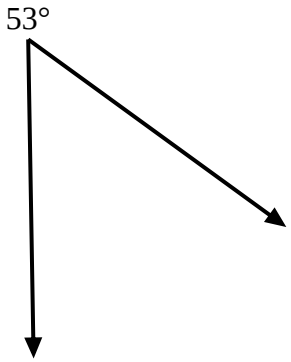


**4)**

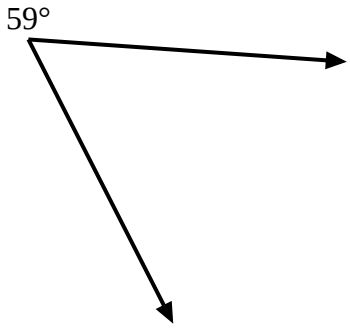


**5)**

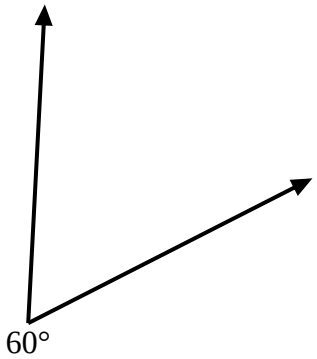


**6)**

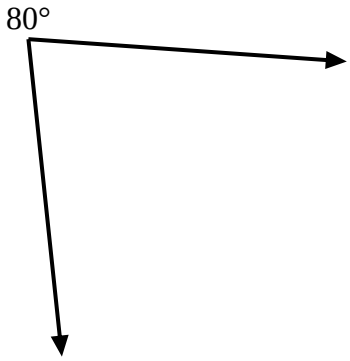


**7)**

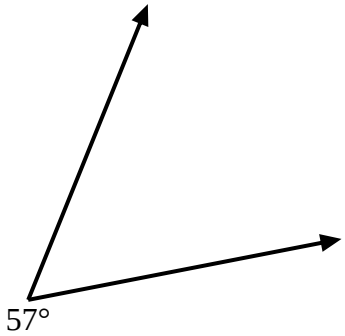


**8)**

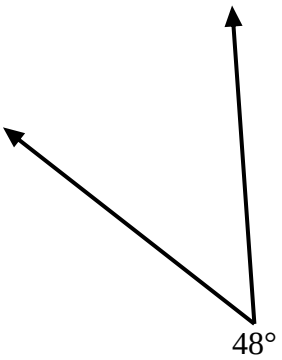


**Antworten**

1. =129
2. =116
3. =127
4. =121
5. =120
6. =100
7. =123
8. =132



| | | | | | | | | |
|---|---|---|---|---|---|---|---|---|
| 1-8 | 88 | 75 | 63 | 50 | 38 | 25 | 13 | 0 |