Lesen einer analogen Uhr

Name:

Bestimmen Sie die auf der Uhr angezeigte Zeit.

1) 

2) 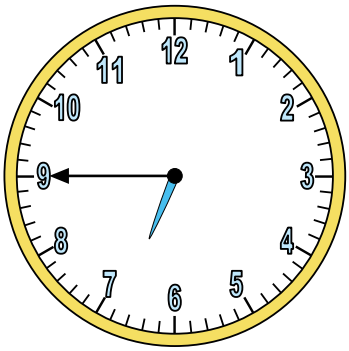

3) 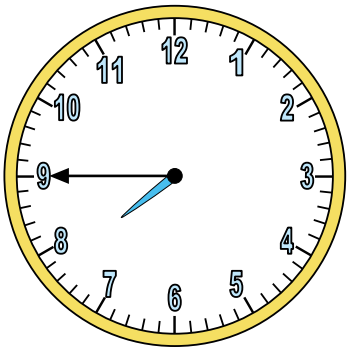

4) 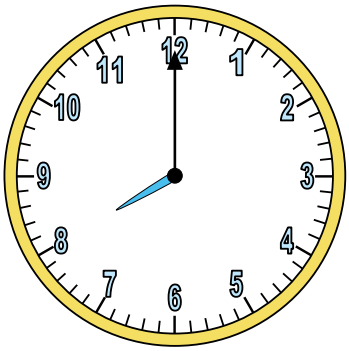

5) 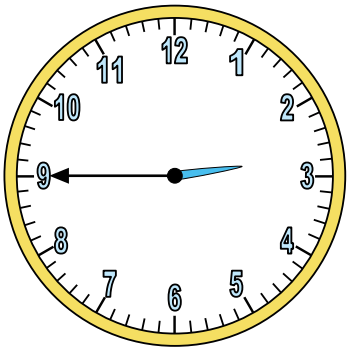

6) 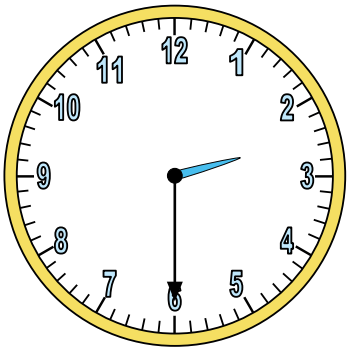

7) 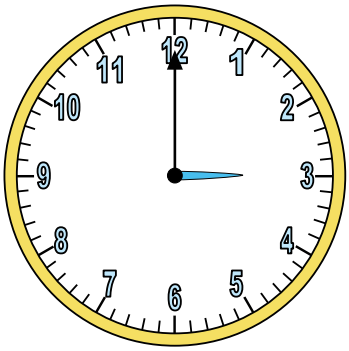

8) 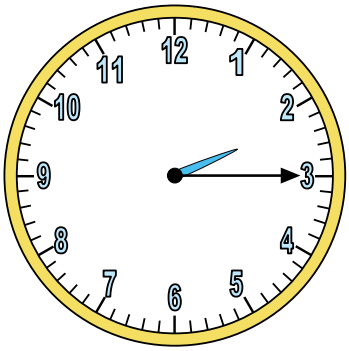

9) 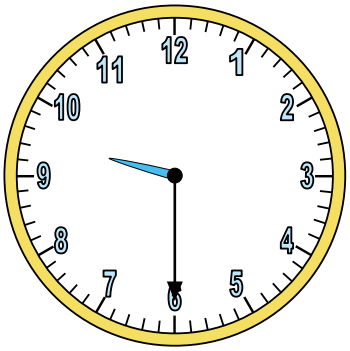

10) 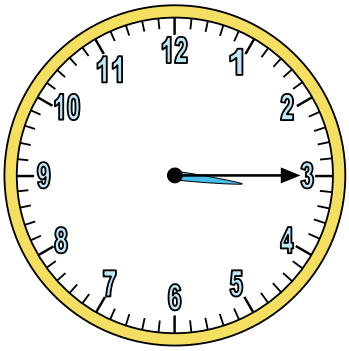

11) 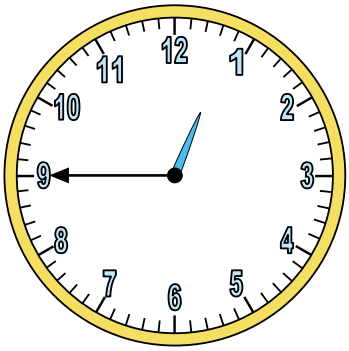

12) 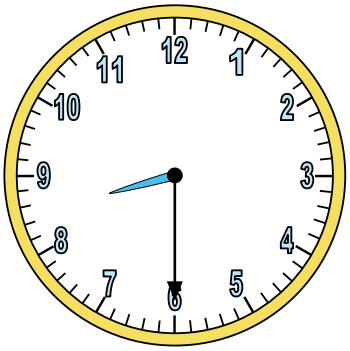

Antworten

1. _____
2. _____
3. _____
4. _____
5. _____
6. _____
7. _____
8. _____
9. _____
10. _____
11. _____
12. _____

1-10	92	83	75	67	58	50	42	33	25	17
11-12	8	0								

Lesen einer analogen Uhr

Name: **Lösungsschlüssel**

Bestimmen Sie die auf der Uhr angezeigte Zeit.

1) 

2) 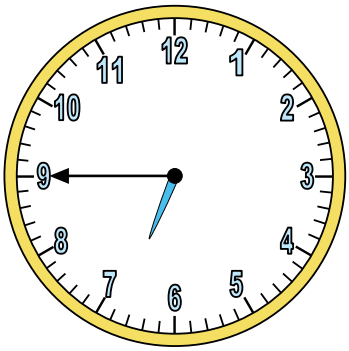

3) 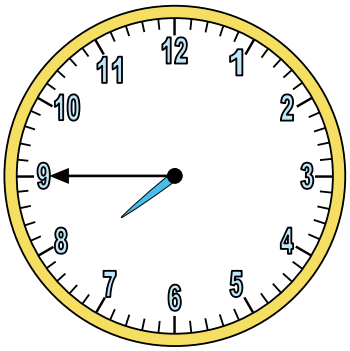

4) 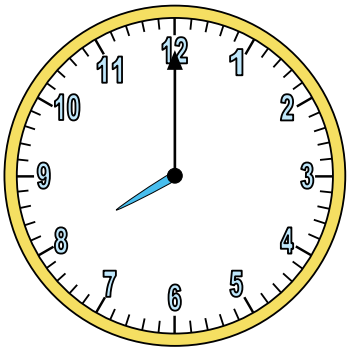

5) 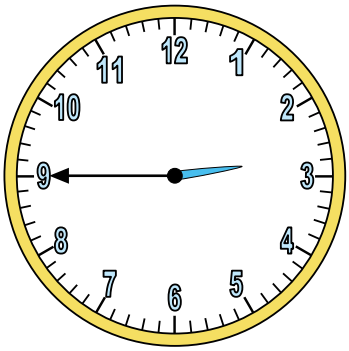

6) 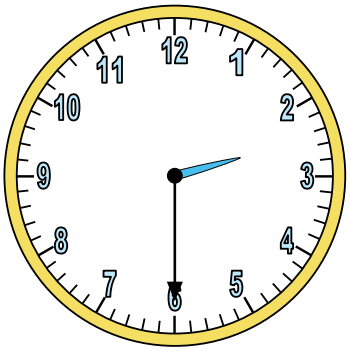

7) 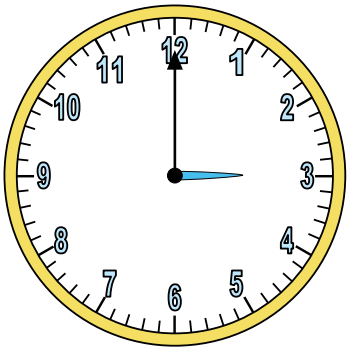

8) 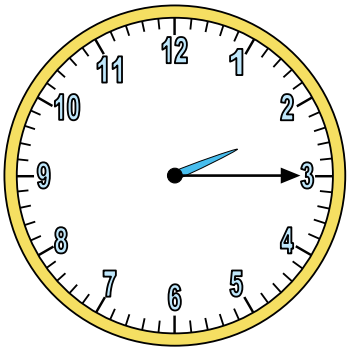

9) 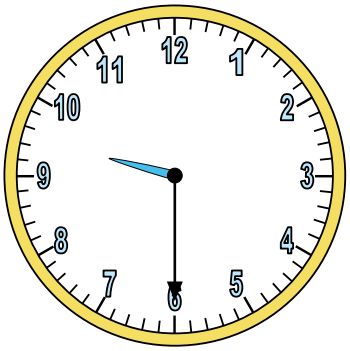

10) 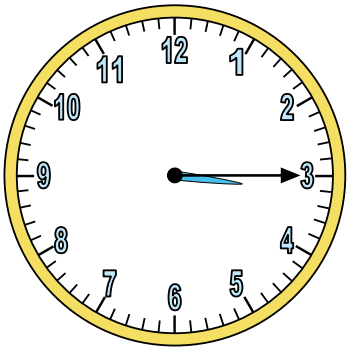

11) 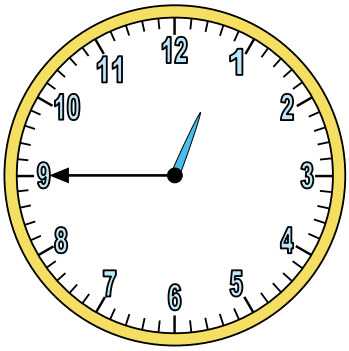

12) 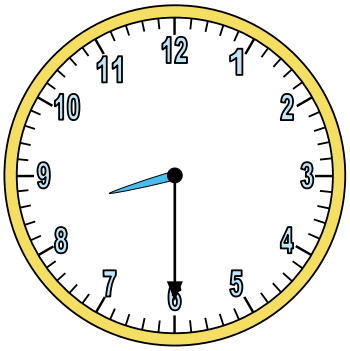

Antworten

1. 12:00
2. 6:45
3. 7:45
4. 8:00
5. 2:45
6. 2:30
7. 3:00
8. 2:15
9. 9:30
10. 3:15
11. 12:45
12. 8:30

1-10	92	83	75	67	58	50	42	33	25	17
11-12	8	0								