Symmetrie bestimmen

Name:

**Bestimme, ob die Linie durch jede Figur eine symmetrische Linie ist.**

**Bsp)**

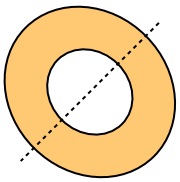

**1)**

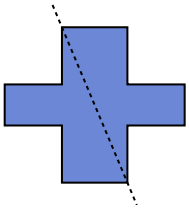

**2)**

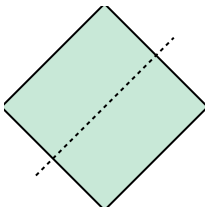

**3)**

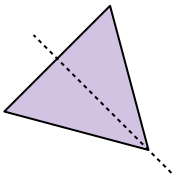

**4)**

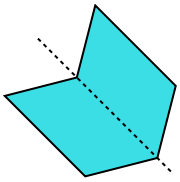

**5)**

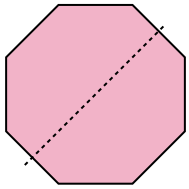

**6)**

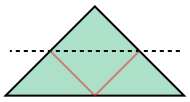

**7)**



**8)**

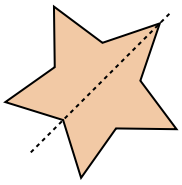

**9)**

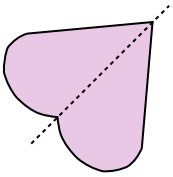

**10)**

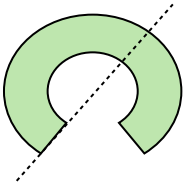

**11)**

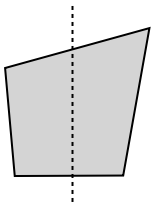

**Antworten**

Bsp. ja

1. _____
2. _____
3. _____
4. _____
5. _____
6. _____
7. _____
8. _____
9. _____
10. _____
11. _____



| | | | | | | | | | | |
|---|---|---|---|---|---|---|---|---|---|---|
| 1-10 | 91 | 82 | 73 | 64 | 55 | 45 | 36 | 27 | 18 | 9 |
| 11 | 0 | | | | | | | | | |

Symmetrie bestimmen

Name: **Lösungsschlüssel**

**Bestimme, ob die Linie durch jede Figur eine symmetrische Linie ist.**

**Bsp)**

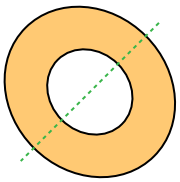

**1)**

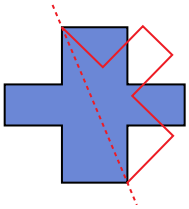

**2)**

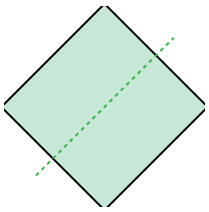

**3)**

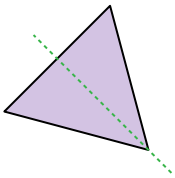

**4)**

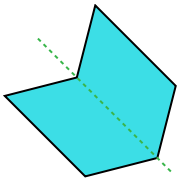

**5)**

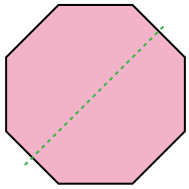

**6)**

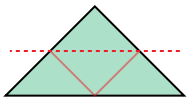

**7)**

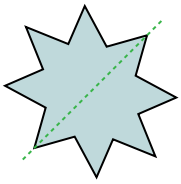

**8)**

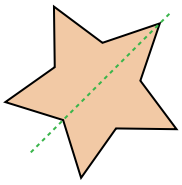

**9)**

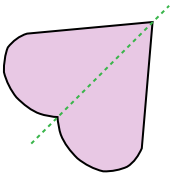

**10)**

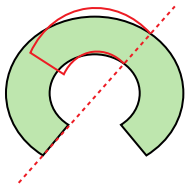

**11)**

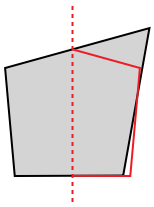

## Antworten

| | |
|---|---|
| Bsp. | ja |
| 1. | no |
| 2. | ja |
| 3. | ja |
| 4. | ja |
| 5. | ja |
| 6. | no |
| 7. | ja |
| 8. | ja |
| 9. | ja |
| 10. | no |
| 11. | no |



| | | | | | | | | | | |
|---|---|---|---|---|---|---|---|---|---|---|
| 1-10 | 91 | 82 | 73 | 64 | 55 | 45 | 36 | 27 | 18 | 9 |
| 11 | 0 | | | | | | | | | |