Stelle fest, welche Regel die Funktionsmaschine anwendet.

Bsp)

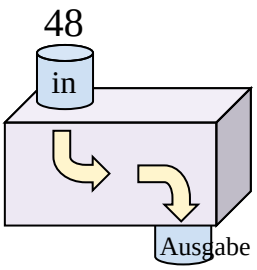

Subtrahieren von 33

1)

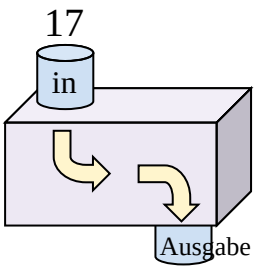

2)

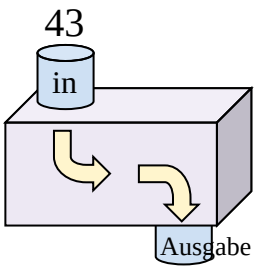

3)

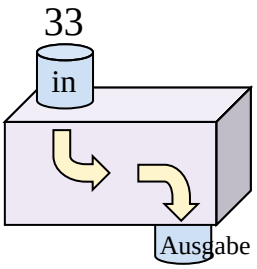

4)

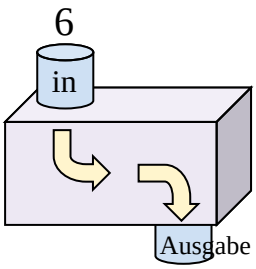

5)

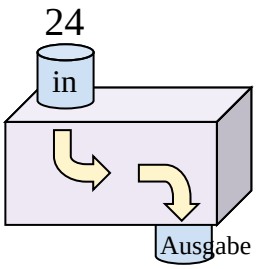

6)

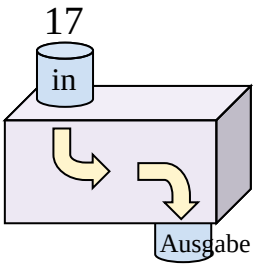

7)

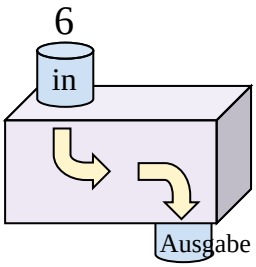

8)

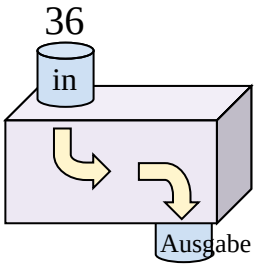

9)

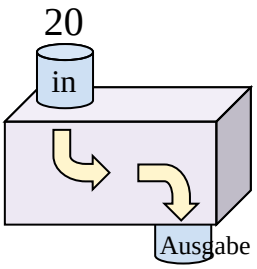

10)

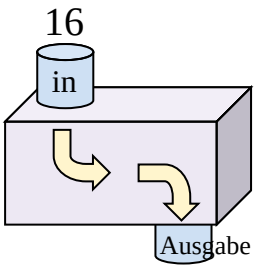

11)

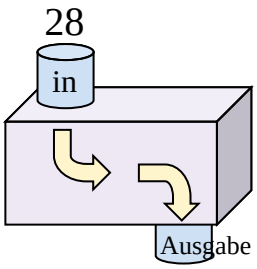

Antworten

Bsp. Subtrahieren von 33

1. _____
2. _____
3. _____
4. _____
5. _____
6. _____
7. _____
8. _____
9. _____
10. _____
11. _____

1-10	91	82	73	64	55	45	36	27	18	9
11	0									

Stelle fest, welche Regel die Funktionsmaschine anwendet.

Bsp)

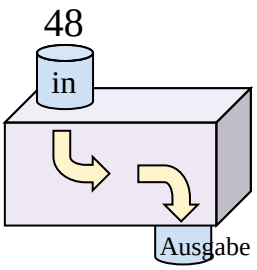

Subtrahieren von 33

1)

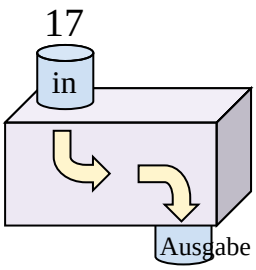

15 hinzufügen

2)

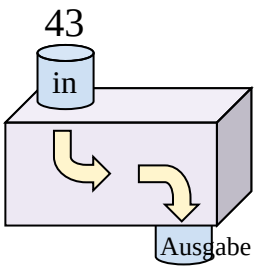

Subtrahieren von 23

3)

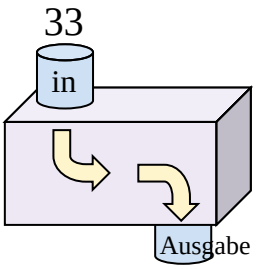

Subtrahieren von 15

4)

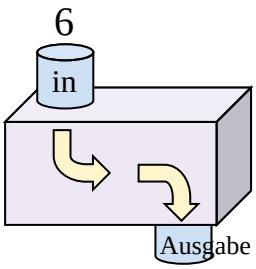

36 hinzufügen

5)

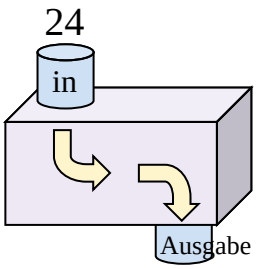

14 hinzufügen

6)

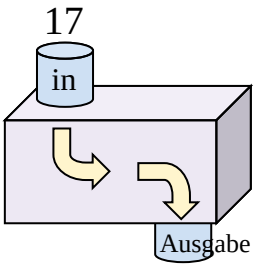

9 hinzufügen

7)

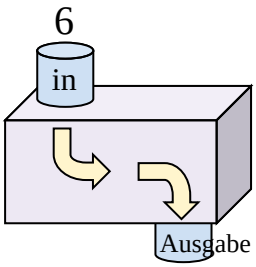

14 hinzufügen

8)

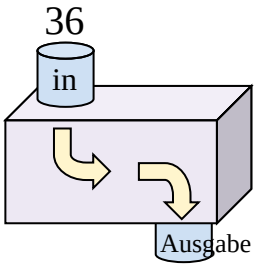

Subtrahieren von 16

9)

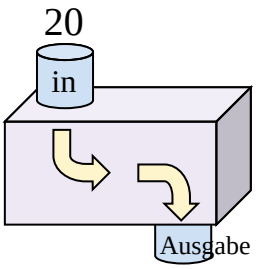

8 hinzufügen

10)

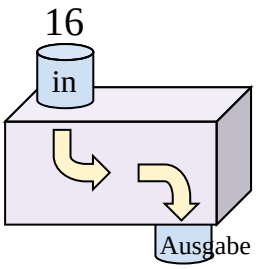

19 hinzufügen

11)

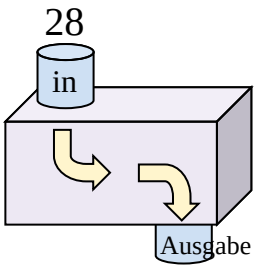

Subtrahieren von 9

Antworten

Bsp.	Subtrahieren von 33
1.	15 hinzufügen
2.	Subtrahieren von 23
3.	Subtrahieren von 15
4.	36 hinzufügen
5.	14 hinzufügen
6.	9 hinzufügen
7.	14 hinzufügen
8.	Subtrahieren von 16
9.	8 hinzufügen
10.	19 hinzufügen
11.	Subtrahieren von 9

1-10	91	82	73	64	55	45	36	27	18	9
11	0									