Umwandeln von Multiplikationsaufgaben

Name:

Schreibe jede Anordnung als eine Multiplikationsaufgabe um und löse sie.

Bsp)

1)



2)

3)

4)

5)



6)

7)

8)

9)



10)

11)



Antworten

Bsp. **6 • 3 = 18**

1. _____
2. _____
3. _____
4. _____
5. _____
6. _____
7. _____
8. _____
9. _____
10. _____
11. _____

1-10	91	82	73	64	55	45	36	27	18	9
11	0									

Umwandeln von Multiplikationsaufgaben Name: **Lösungsschlüssel**

Schreibe jede Anordnung als eine Multiplikationsaufgabe um und löse sie.

Bsp)

1) 

2)

3)

4)

5) 

6)

7)

8)

9) 

10)

11) 

Antworten

Bsp.	6 • 3 = 18
1.	10 • 9 = 90
2.	9 • 5 = 45
3.	5 • 2 = 10
4.	8 • 4 = 32
5.	9 • 10 = 90
6.	3 • 2 = 6
7.	4 • 9 = 36
8.	10 • 3 = 30
9.	10 • 7 = 70
10.	2 • 8 = 16
11.	3 • 4 = 12

1-10	91	82	73	64	55	45	36	27	18	9
11	0									