Multiplizieren mit Anordnungen

Name:

Benutze die vorgegebenen Anordnungen um jede Aufgabe zu lösen.

1) 11•10 =



2) 17•10 =



3) 10•13 =



4) 10•17 =



5) 10•19 =



6) 10•15 =



Antworten

1. _____
2. _____
3. _____
4. _____
5. _____
6. _____

1-6	83	67	50	33	17	0

Multiplizieren mit Anordnungen

Name: **Lösungsschlüssel**

Benutze die vorgegebenen Anordnungen um jede Aufgabe zu lösen.

1) 11•10 =

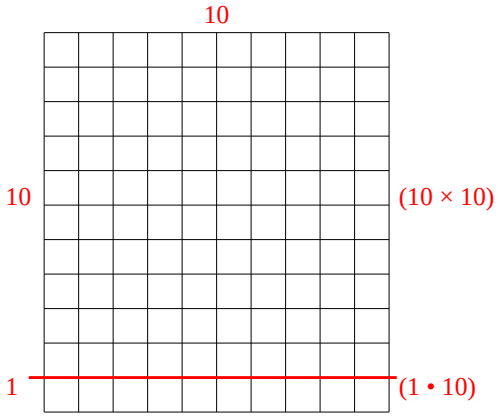

2) 17•10 =

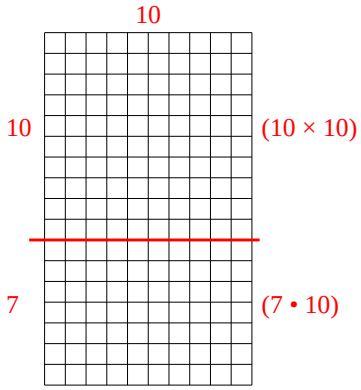

3) 10•13 =

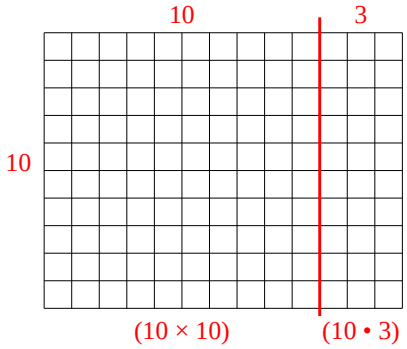

4) 10•17 =

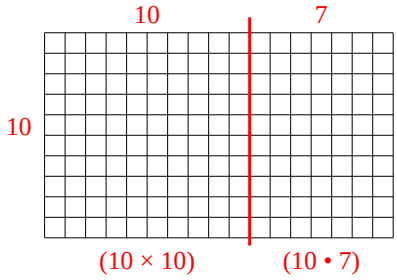

5) 10•19 =

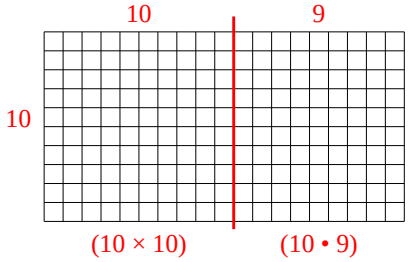

6) 10•15 =

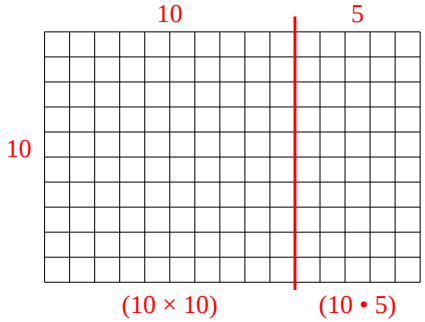

Antworten

1. **110**
2. **170**
3. **130**
4. **170**
5. **190**
6. **150**

1-6	83	67	50	33	17	0