Teilen mit dem Zahlenstrahl

Name:

Benutze den Zahlenstrahl um jede Aufgabe zu lösen. Die erste Aufgabe ist bereíts als Beispiel gelöst.

1) $\frac{2}{4}:3$

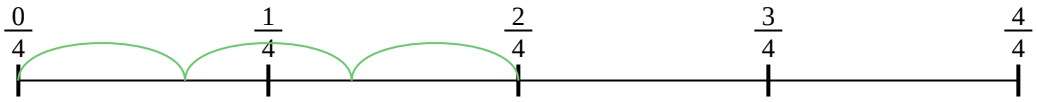

2) $\frac{4}{5}:3$



3) $\frac{5}{7}:4$



4) $\frac{3}{6}:6$

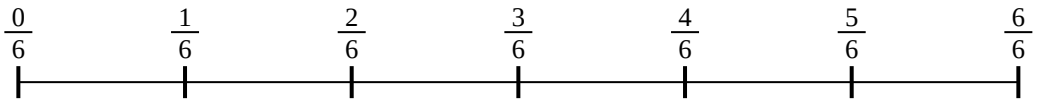

5) $\frac{4}{5}:5$

6) $\frac{3}{4}:5$

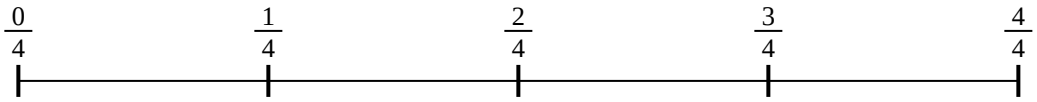

7) $\frac{3}{4}:2$

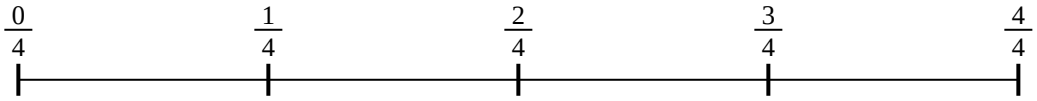

8) $\frac{4}{5}:4$



9) $\frac{3}{5}:4$



Antworten

1. _____
2. _____
3. _____
4. _____
5. _____
6. _____
7. _____
8. _____
9. _____

1-9	89	78	67	56	44	33	22	11	0

Teilen mit dem Zahlenstrahl Name: **Lösungsschlüssel**

Benutze den Zahlenstrahl um jede Aufgabe zu lösen. Die erste Aufgabe ist bereits als Beispiel gelöst.

1) $\frac{2}{4}:3$

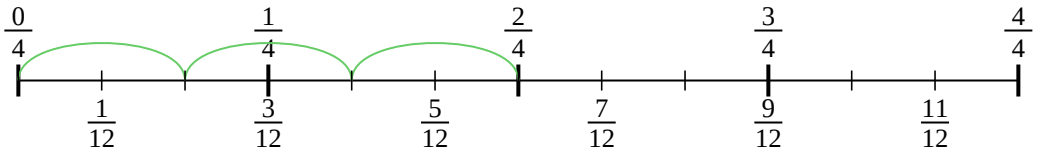

2) $\frac{4}{5}:3$

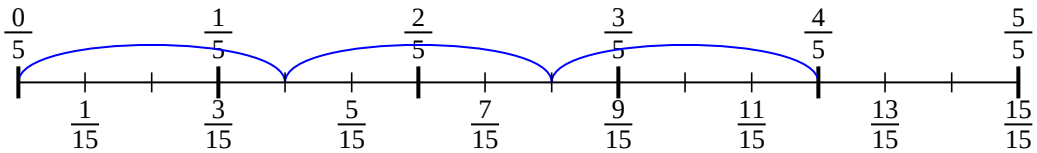

3) $\frac{5}{7}:4$

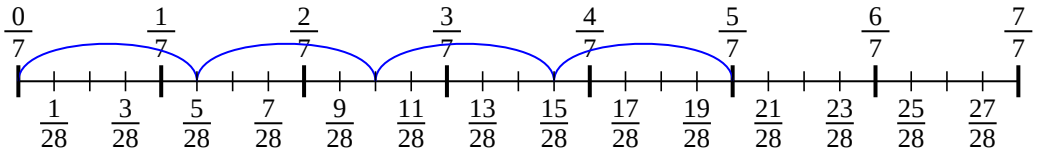

4) $\frac{3}{6}:6$

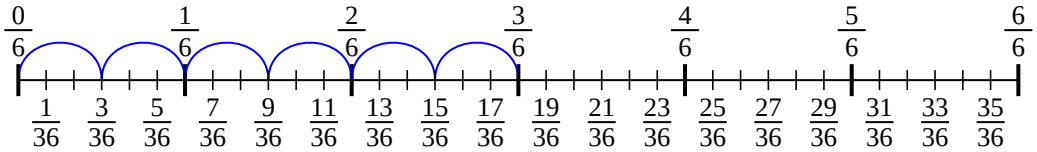

5) $\frac{4}{5}:5$

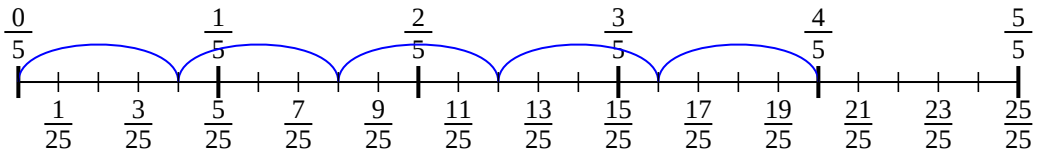

6) $\frac{3}{4}:5$

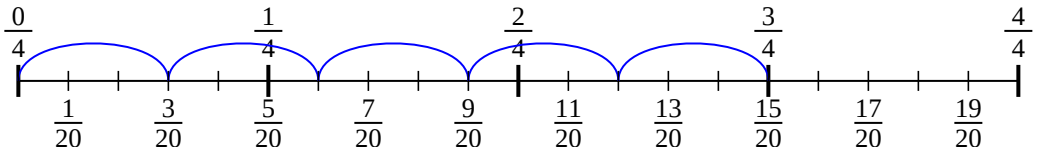

7) $\frac{3}{4}:2$

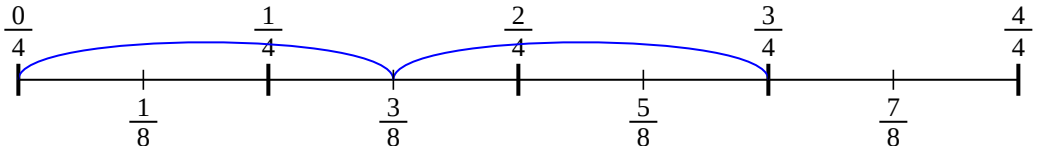

8) $\frac{4}{5}:4$

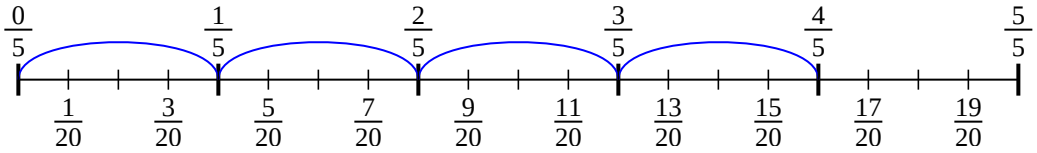

9) $\frac{3}{5}:4$

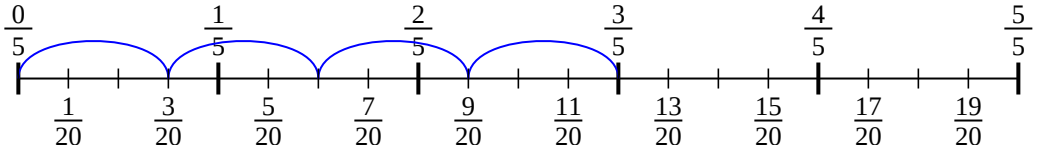

Antworten

1. $\frac{2}{12}$
2. $\frac{4}{15}$
3. $\frac{5}{28}$
4. $\frac{3}{36}$
5. $\frac{4}{25}$
6. $\frac{3}{20}$
7. $\frac{3}{8}$
8. $\frac{4}{20}$
9. $\frac{3}{20}$

1-9	89	78	67	56	44	33	22	11	0

Teilen mit dem Zahlenstrahl

Name:

Benutze den Zahlenstrahl um jede Aufgabe zu lösen. Die erste Aufgabe ist bereíts als Beispiel gelöst.

$^{3}/_{20}$	$^{3}/_{20}$	$^{3}/_{36}$	$^{4}/_{15}$
$^{4}/_{20}$	$^{3}/_{8}$	$^{2}/_{12}$	$^{4}/_{25}$
$^{5}/_{28}$			

1) $^{2}/_{4}$:3

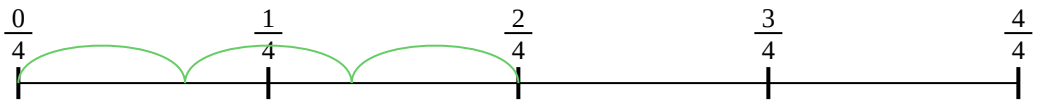

2) $^{4}/_{5}$:3



3) $^{5}/_{7}$:4



4) $^{3}/_{6}$:6

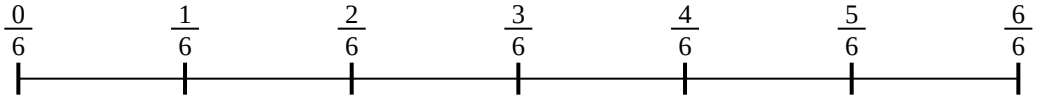

5) $^{4}/_{5}$:5



6) $^{3}/_{4}$:5

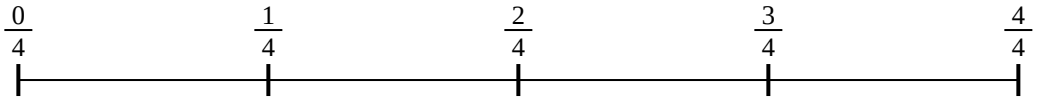

7) $^{3}/_{4}$:2

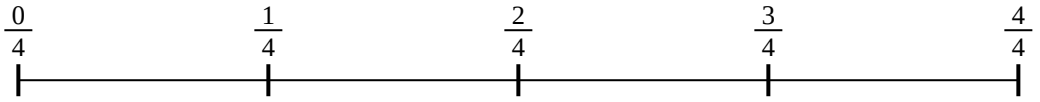

8) $^{4}/_{5}$:4



9) $^{3}/_{5}$:4



Antworten

1. _____
2. _____
3. _____
4. _____
5. _____
6. _____
7. _____
8. _____
9. _____

1-9	89	78	67	56	44	33	22	11	0