Division mit einem Zahlenstrahl

Name:

Benutze den Zahlenstrahl zur Lösung jeder Aufgabe.

1) 35:7=

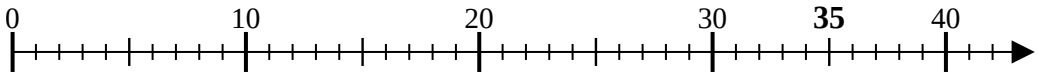

2) 21:7=

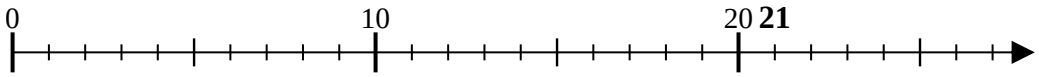

3) 12:6=

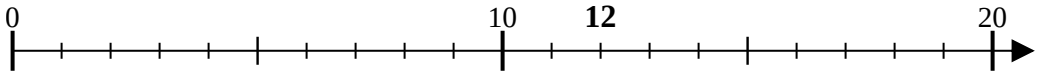

4) 6:2=

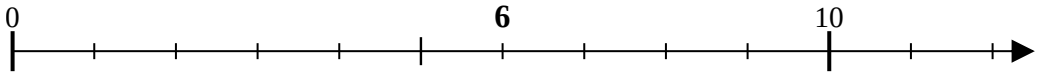

5) 28:7=

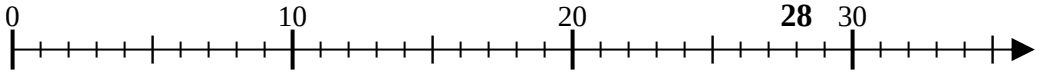

6) 10:2=

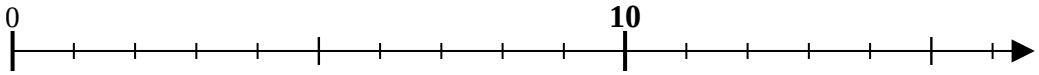

7) 9:3=

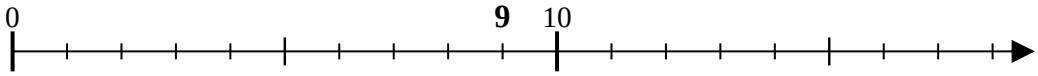

8) 18:6=

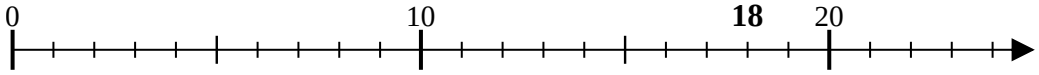

9) 10:5=

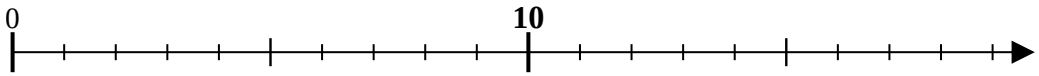

10) 18:9=

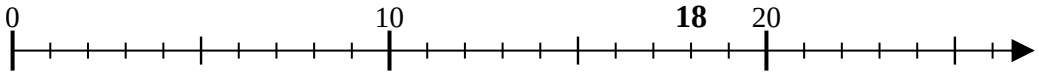

11) 24:6=

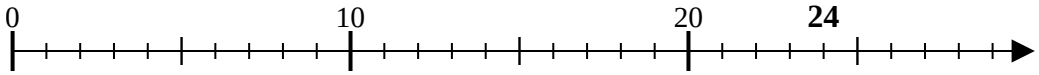

Antworten

1. _____
2. _____
3. _____
4. _____
5. _____
6. _____
7. _____
8. _____
9. _____
10. _____
11. _____

1-10	91	82	73	64	55	45	36	27	18	9
11	0									

Division mit einem Zahlenstrahl

Name: **Lösungsschlüssel**

Benutze den Zahlenstrahl zur Lösung jeder Aufgabe.

1) 35:7=

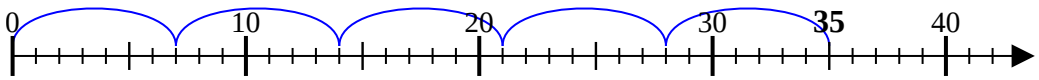

2) 21:7=

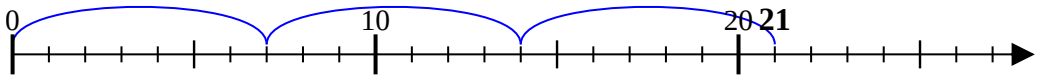

3) 12:6=

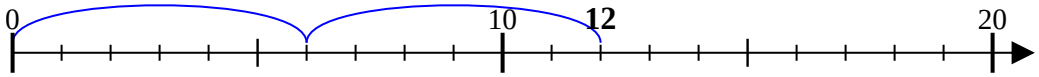

4) 6:2=

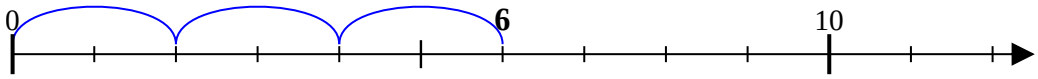

5) 28:7=

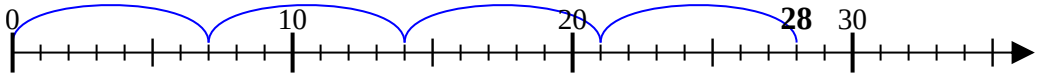

6) 10:2=

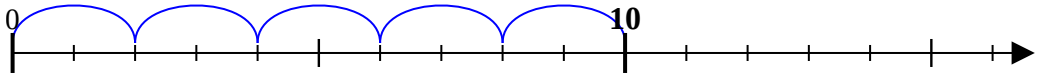

7) 9:3=

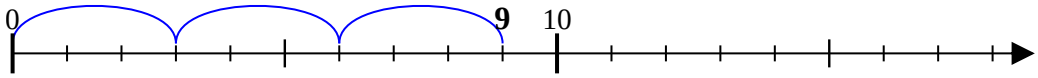

8) 18:6=

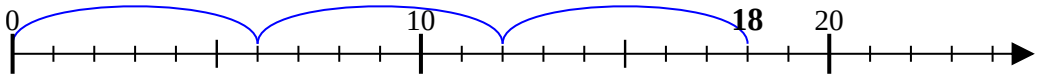

9) 10:5=

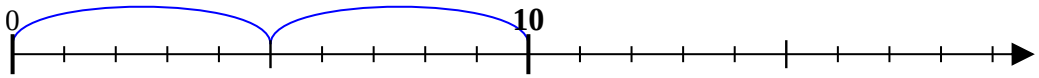

10) 18:9=

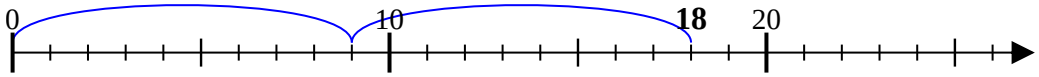

11) 24:6=

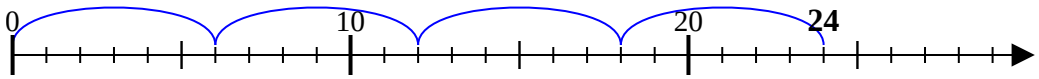

Antworten

1. 5
2. 3
3. 2
4. 3
5. 4
6. 5
7. 3
8. 3
9. 2
10. 2
11. 4

1-10	91	82	73	64	55	45	36	27	18	9
11	0									