# Finden von Winkeln in Formen

Name:

**Zähle die Anzahl von spitzwinkligen, stumpfwinkligen und rechten Winkeln in jeder Form.**

**Bsp)**

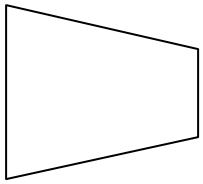

**1)**

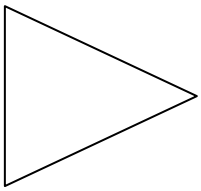

**2)**

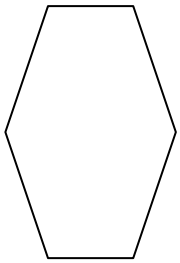

**3)**

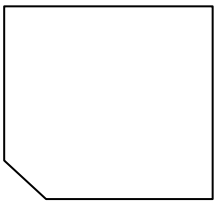

**4)**

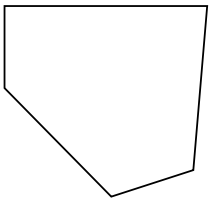

**5)**

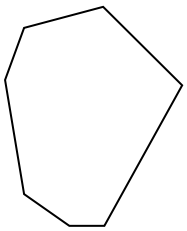

**6)**

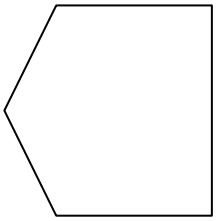

**7)**

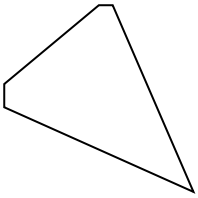

**8)**

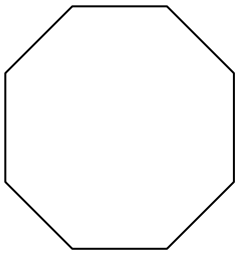

**9)**

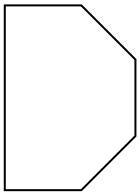

**10)**

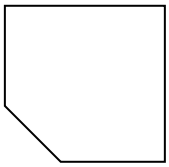

**11)**

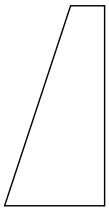

## Antworten

| | | | |
|---|---|---|---|
| Bsp. | 2 | 2 | 0 |
| 1. | | | |
| 2. | | | |
| 3. | | | |
| 4. | | | |
| 5. | | | |
| 6. | | | |
| 7. | | | |
| 8. | | | |
| 9. | | | |
| 10. | | | |
| 11. | | | |

Finden von Winkeln in Formen

Name: **Lösungsschlüssel**

**Zähle die Anzahl von spitzwinkligen, stumpfwinkligen und rechten Winkeln in jeder Form.**

**Bsp)**

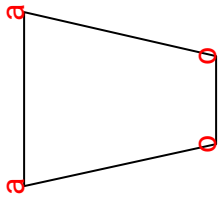

**1)**

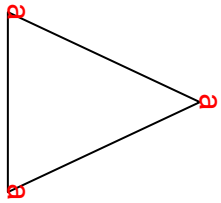

**2)**

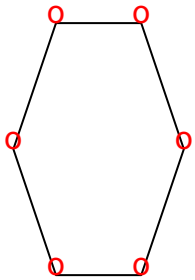

**3)**

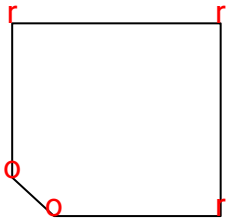

**4)**

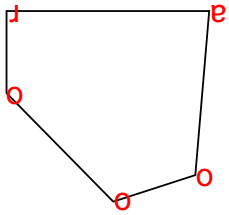

**5)**

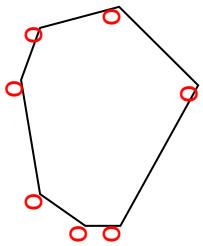

**6)**

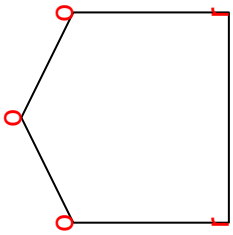

**7)**

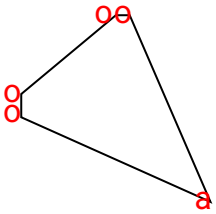

**8)**

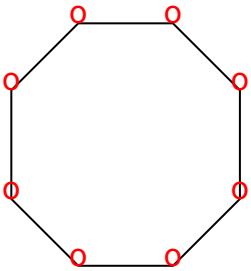

**9)**

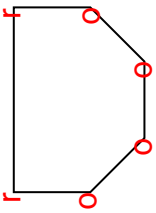

**10)**

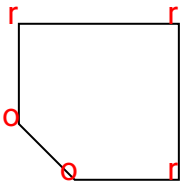

**11)**

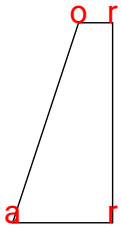

## Antworten

| | | | |
|---|---|---|---|
| Bsp. | 2 | 2 | 0 |
| 1. | 3 | 0 | 0 |
| 2. | 0 | 6 | 0 |
| 3. | 0 | 2 | 3 |
| 4. | 1 | 3 | 1 |
| 5. | 0 | 7 | 0 |
| 6. | 0 | 3 | 2 |
| 7. | 1 | 4 | 0 |
| 8. | 0 | 8 | 0 |
| 9. | 0 | 4 | 2 |
| 10. | 0 | 2 | 3 |
| 11. | 1 | 1 | 2 |